Completa la scala numerata Nome:

Riempi gli spazi nella scala numerata. Ogni linea incrementa di uno.

1)



2)

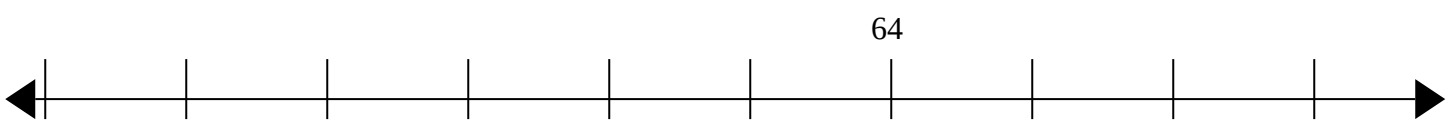

3)

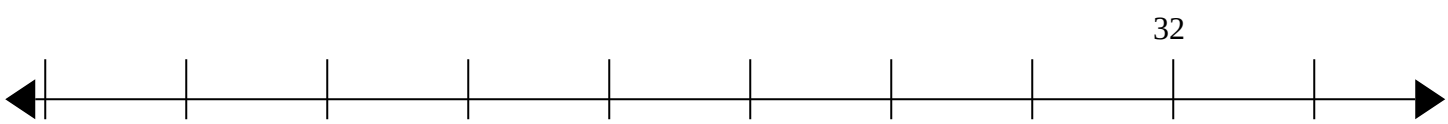

4)

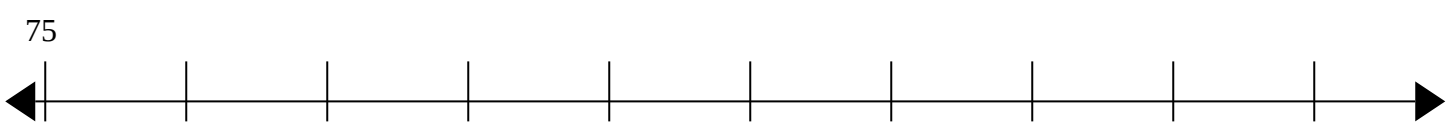

5)

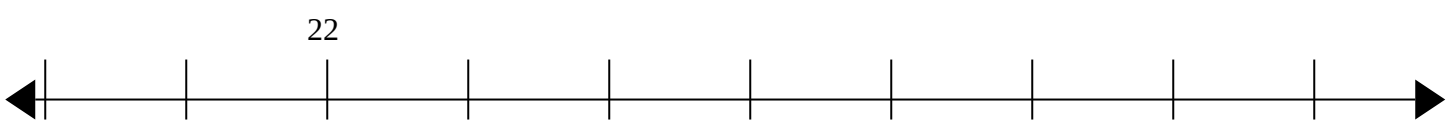

6)

7)

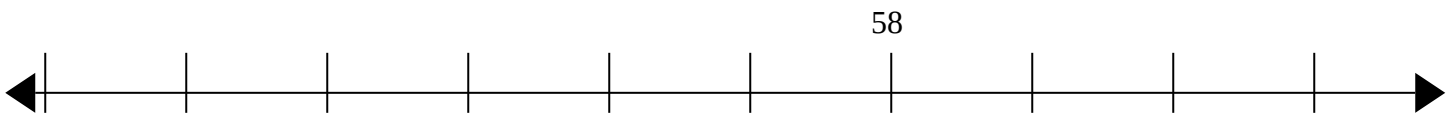

8)

9)

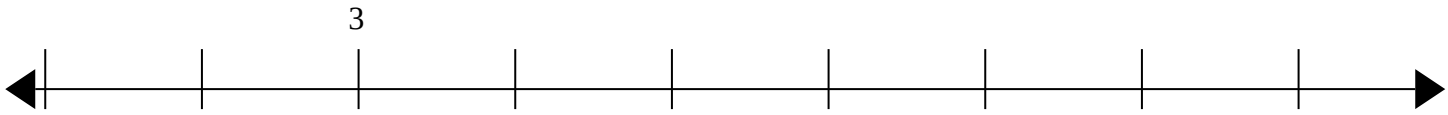

10)



1-10	90	80	70	60	50	40	30	20	10	0

Completa la scala numerata Nome: **Soluzioni**

Riempi gli spazi nella scala numerata. Ogni linea incrementa di uno.

1) 46 47 48 49 50 51 52

2) 58 59 60 61 62 63 64 65 66 67

3) 24 25 26 27 28 29 30 31 32 33

4) 75 76 77 78 79 80 81 82 83 84

5) 20 21 22 23 24 25 26 27 28 29

6) 16 17 18 19 20 21

7) 52 53 54 55 56 57 58 59 60 61

8) 26 27 28 29 30 31 32 33

9) 1 2 3 4 5 6 7 8 9

10) 42 43 44 45 46 47 48

1-10	90	80	70	60	50	40	30	20	10	0