Misurazione e visualizzazione dei dati Nome:

Misura ogni punta ARTICOLO per punta, quindi posiziona i risultati nel grafico a linee.

Es)

1) 

2) 

3) 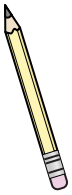

4) 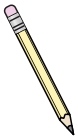

5)

6) 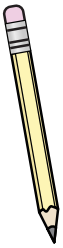

7) 

8) 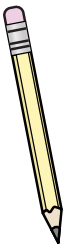

9)

10) 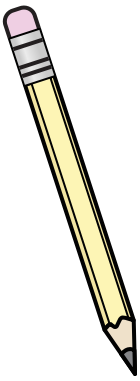

11)

Line Plot							
$\frac{1}{4}$	$\frac{1}{2}$	$\frac{3}{4}$	1	$1\frac{1}{4}$	$1\frac{1}{2}$	$1\frac{3}{4}$	2

Risposte

Es. $\frac{1}{4}$

1. _____
2. _____
3. _____
4. _____
5. _____
6. _____
7. _____
8. _____
9. _____
10. _____
11. _____

1-10	91	82	73	64	55	45	36	27	18	9
11	0									

Misurazione e visualizzazione dei dati Nome: **Soluzioni**

Misura ogni punta ARTICOLO per punta, quindi posiziona i risultati nel grafico a linee.

Es)

1) 

2) 

3) 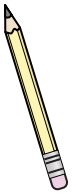

4) 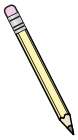

5)

6) 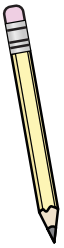

7) 

8) 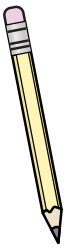

9)

10) 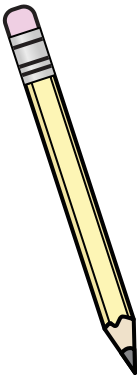

11)

Line Plot

	X	X		X			X
X	X	X	X	X	X	X	X
$\frac{1}{4}$	$\frac{1}{2}$	$\frac{3}{4}$	1	$1\frac{1}{4}$	$1\frac{1}{2}$	$1\frac{3}{4}$	2

Risposte

Es. $\frac{1}{4}$

1. $1\frac{1}{2}$
2. $1\frac{3}{4}$
3. 1
4. $\frac{3}{4}$
5. $\frac{1}{2}$
6. $1\frac{1}{4}$
7. 2
8. $1\frac{1}{4}$
9. $\frac{1}{2}$
10. 2
11. $\frac{3}{4}$

1-10	91	82	73	64	55	45	36	27	18	9
11	0									