Frazioni, decimali e percentuali (visivamente) Nome:

Determina il valore sotto forma di frazione, decimale e percentuale.

Es)

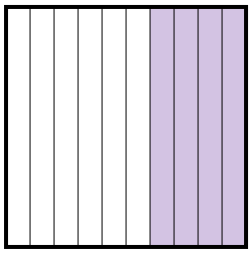

Frazione $^{4}/_{10}$
Decimale 0,4
Percentuale 40

1)

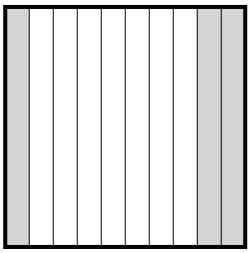

Frazione _____
Decimale _____
Percentuale _____

2)

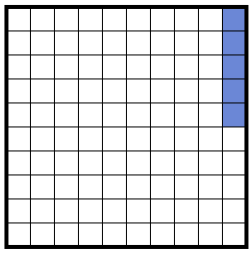

Frazione _____
Decimale _____
Percentuale _____

3)

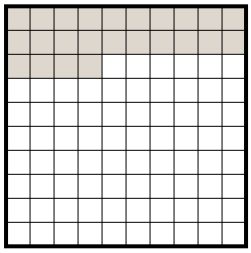

Frazione _____
Decimale _____
Percentuale _____

4)

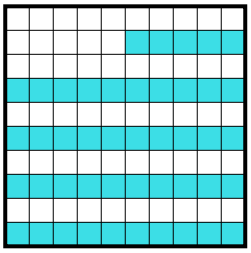

Frazione _____
Decimale _____
Percentuale _____

5)

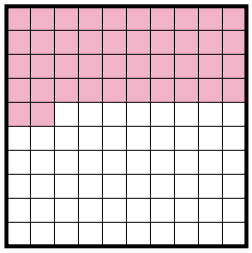

Frazione _____
Decimale _____
Percentuale _____

6)



Frazione _____
Decimale _____
Percentuale _____

7)



Frazione _____
Decimale _____
Percentuale _____

8)

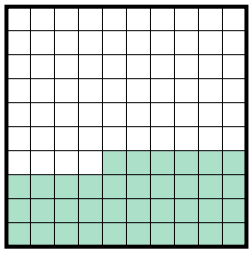

Frazione _____
Decimale _____
Percentuale _____

9)

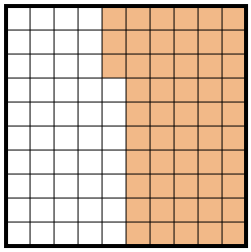

Frazione _____
Decimale _____
Percentuale _____

10)

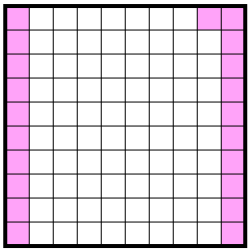

Frazione _____
Decimale _____
Percentuale _____

11)



Frazione _____
Decimale _____
Percentuale _____

Risposte

Es.	$^{4}/_{10}$	0,4	40%
1.			
2.			
3.			
4.			
5.			
6.			
7.			
8.			
9.			
10.			
11.			

1-10	91	82	73	64	55	45	36	27	18	9
11	0									

Frazioni, decimali e percentuali (visivamente) Nome: **Soluzioni**

Determina il valore sotto forma di frazione, decimale e percentuale.

Es)

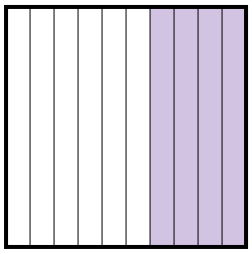

Frazione $4/10$
Decimale 0,4
Percentuale 40

1)

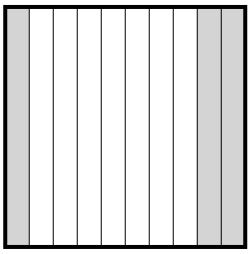

Frazione $3/10$
Decimale 0,3
Percentuale 30

2)

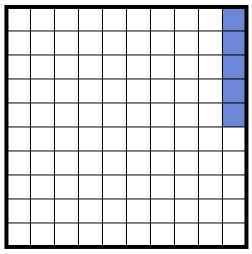

Frazione $5/100$
Decimale 0,05
Percentuale 5

3)

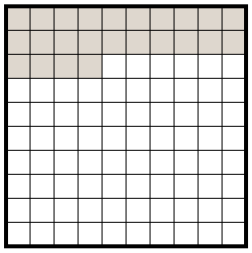

Frazione $24/100$
Decimale 0,24
Percentuale 24

4)

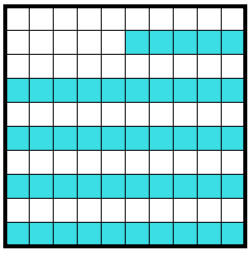

Frazione $45/100$
Decimale 0,45
Percentuale 45

5)

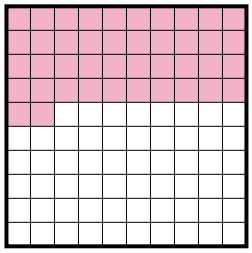

Frazione $42/100$
Decimale 0,42
Percentuale 42

6)



Frazione $2/10$
Decimale 0,2
Percentuale 20

7)



Frazione $1/10$
Decimale 0,1
Percentuale 10

8)

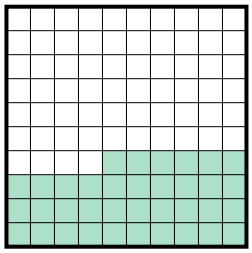

Frazione $36/100$
Decimale 0,36
Percentuale 36

9)

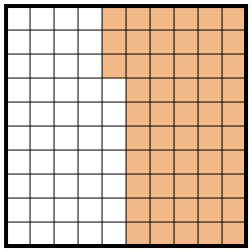

Frazione $53/100$
Decimale 0,53
Percentuale 53

10)

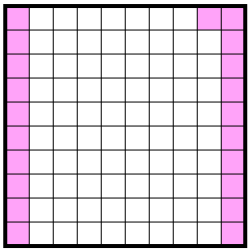

Frazione $21/100$
Decimale 0,21
Percentuale 21

11)



Frazione $8/10$
Decimale 0,8
Percentuale 80

Risposte

Es.	$4/10$	0,4	40%
1.	$3/10$	0,3	30%
2.	$5/100$	0,05	5%
3.	$24/100$	0,24	24%
4.	$45/100$	0,45	45%
5.	$42/100$	0,42	42%
6.	$2/10$	0,2	20%
7.	$1/10$	0,1	10%
8.	$36/100$	0,36	36%
9.	$53/100$	0,53	53%
10.	$21/100$	0,21	21%
11.	$8/10$	0,8	80%

1-10	91	82	73	64	55	45	36	27	18	9
11	0									