Moltiplicazioni con la linea numerata

Nome:

Usa la linea numerata per risolvere ogni operazione.

1) 5 × 10 =

10 × 5 =

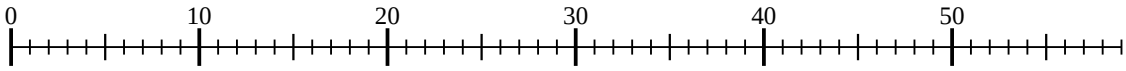

2) 5 × 5 =

5 × 5 =

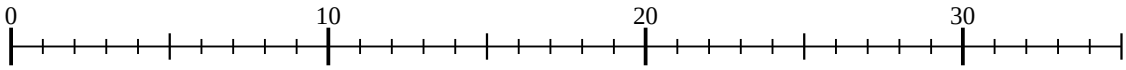

3) 4 × 3 =

3 × 4 =

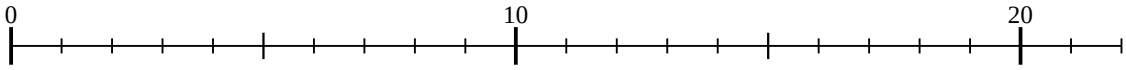

4) 2 × 3 =

3 × 2 =



5) 2 × 4 =

4 × 2 =



6) 2 × 10 =

10 × 2 =

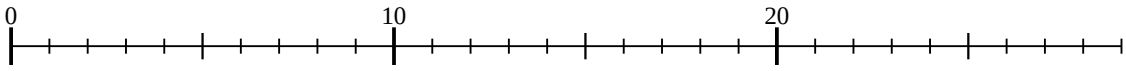

7) 3 × 9 =

9 × 3 =

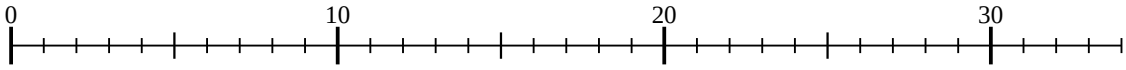

8) 4 × 2 =

2 × 4 =

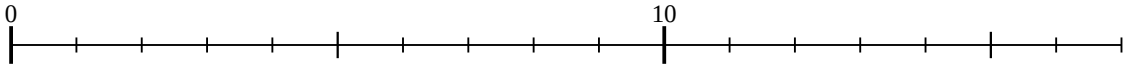

9) 4 × 9 =

9 × 4 =

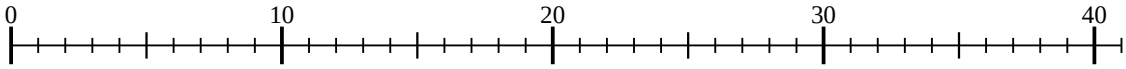

10) 4 × 4 =

4 × 4 =

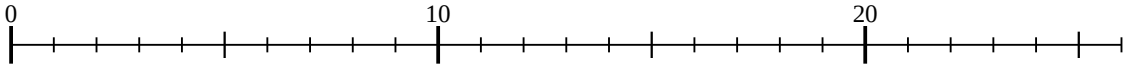

11) 3 × 7 =

7 × 3 =

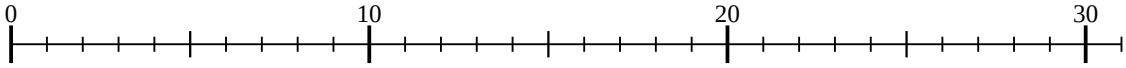

Risposte

1. _____
2. _____
3. _____
4. _____
5. _____
6. _____
7. _____
8. _____
9. _____
10. _____
11. _____

Moltiplicazioni con la linea numerata Nome: **Soluzioni**

Usa la linea numerata per risolvere ogni operazione.

1) 5 × 10 =
10 × 5 =

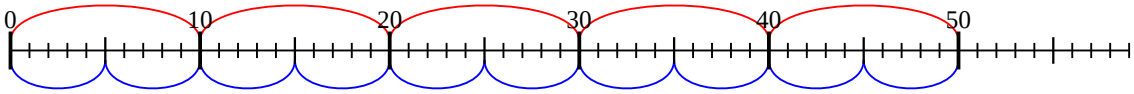

2) 5 × 5 =
5 × 5 =

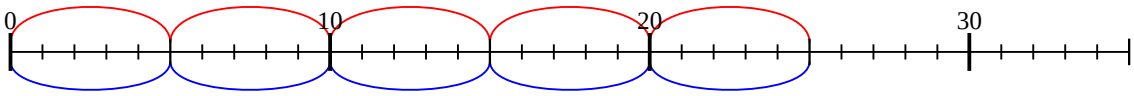

3) 4 × 3 =
3 × 4 =

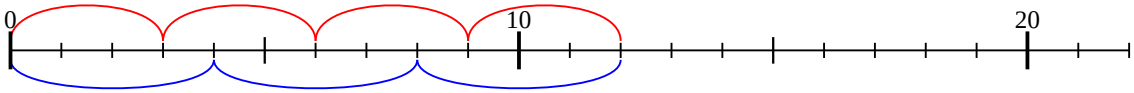

4) 2 × 3 =
3 × 2 =

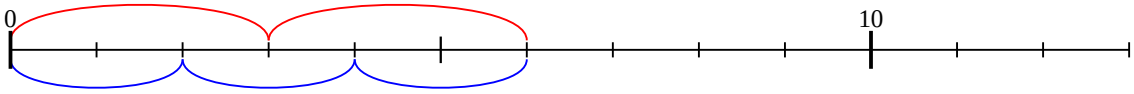

5) 2 × 4 =
4 × 2 =

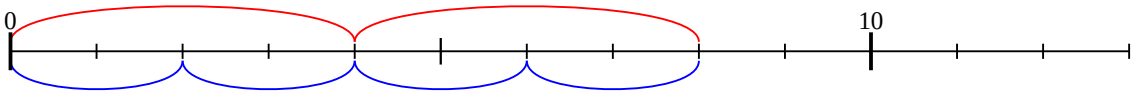

6) 2 × 10 =
10 × 2 =

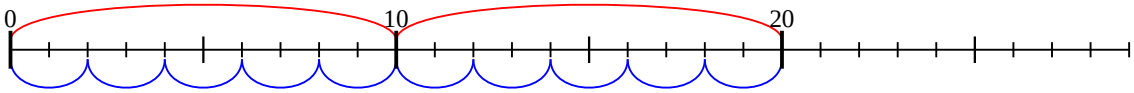

7) 3 × 9 =
9 × 3 =

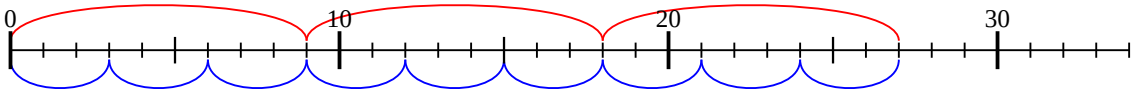

8) 4 × 2 =
2 × 4 =

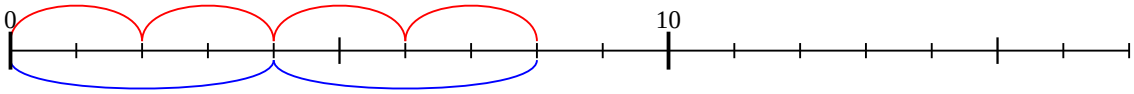

9) 4 × 9 =
9 × 4 =

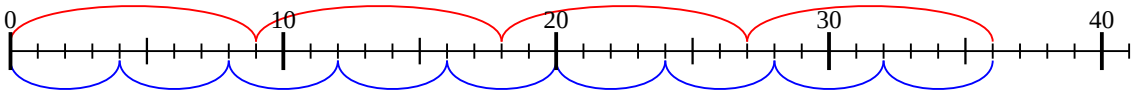

10) 4 × 4 =
4 × 4 =

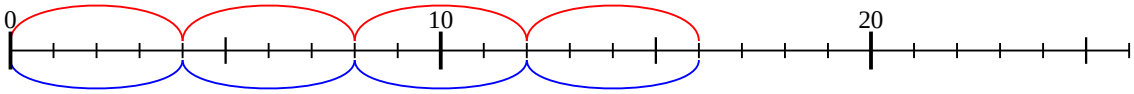

11) 3 × 7 =
7 × 3 =

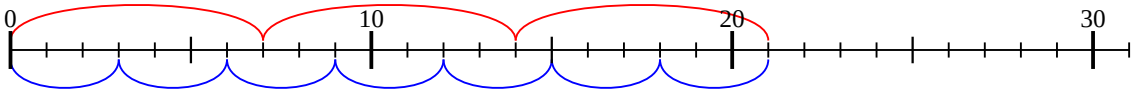

Risposte

1. **50**
2. **25**
3. **12**
4. **6**
5. **8**
6. **20**
7. **27**
8. **8**
9. **36**
10. **16**
11. **21**