Determina il Valore con i Blocchi

Nome:

Trova il valore rappresentato da ogni set di blocchi.

1)

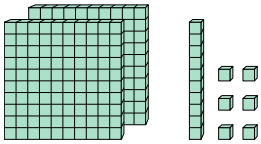

2)

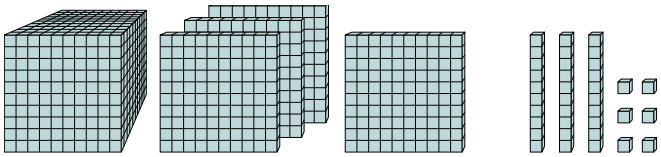

3)

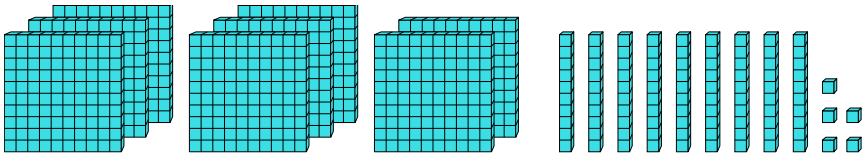

4)

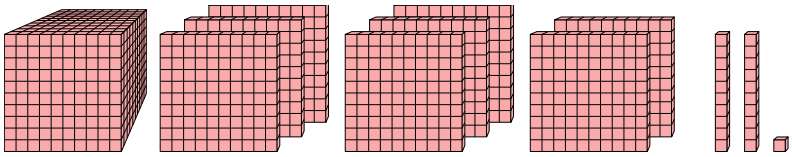

5)

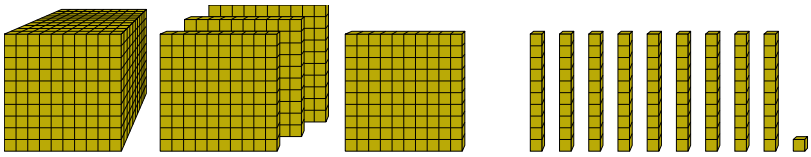

6)

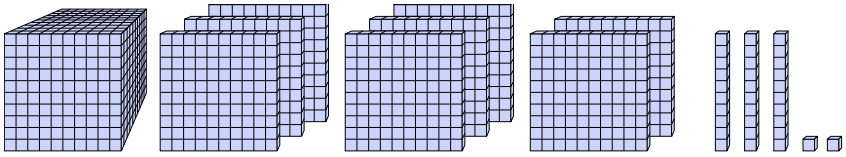

7)

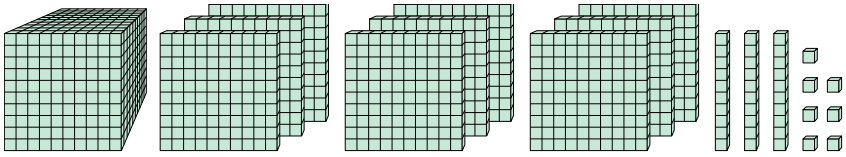

8)

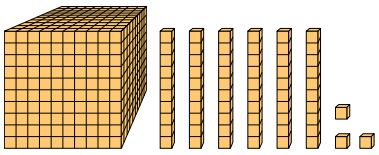

9)

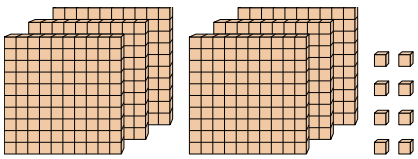

10)

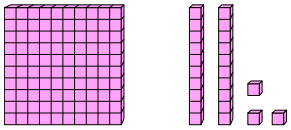

Risposte

1. _____
2. _____
3. _____
4. _____
5. _____
6. _____
7. _____
8. _____
9. _____
10. _____

1-10	90	80	70	60	50	40	30	20	10	0

Determina il Valore con i Blocchi

Nome: **Soluzioni**

Trova il valore rappresentato da ogni set di blocchi.

1) 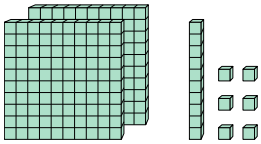

2) 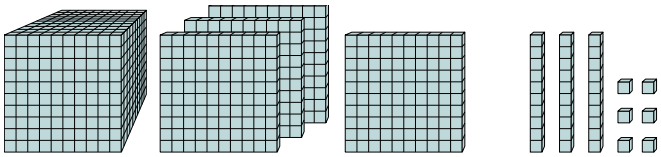

3) 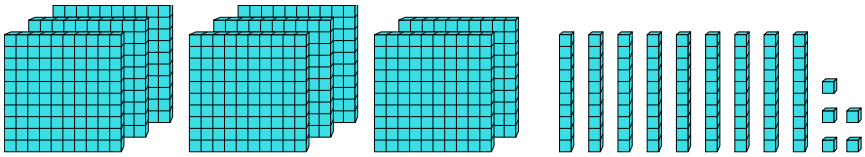

4) 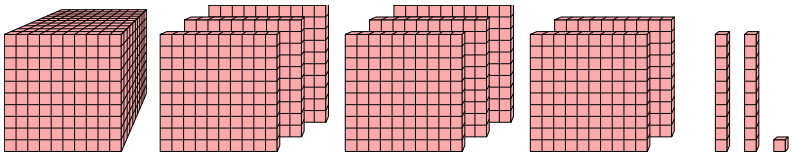

5) 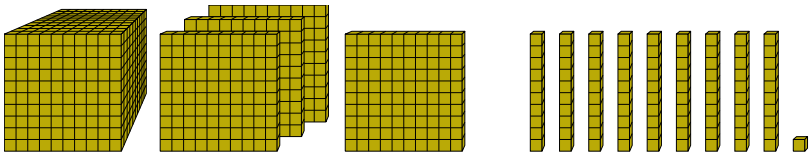

6) 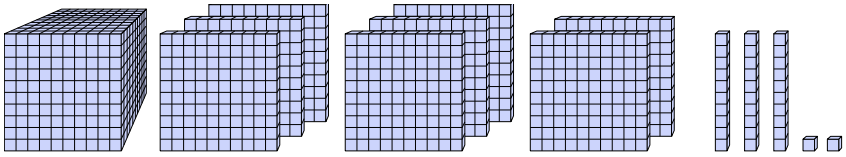

7) 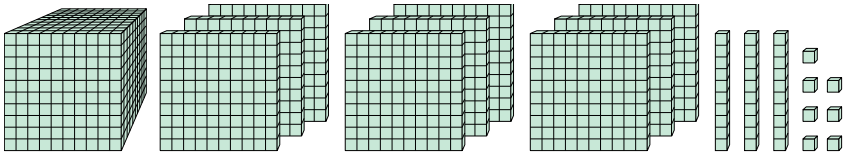

8) 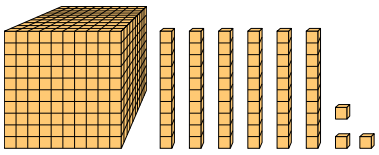

9) 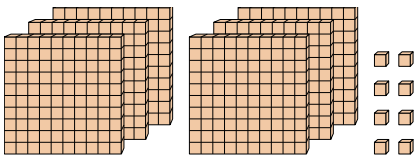

10) 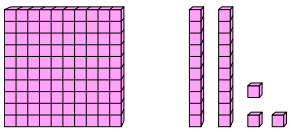

Risposte

1. **216**
2. **1.436**
3. **895**
4. **1.821**
5. **1.491**
6. **1.832**
7. **1.937**
8. **1.063**
9. **608**
10. **123**

1-10	90	80	70	60	50	40	30	20	10	0