Creazione di gruppi di 100 Nome:

Determina quanti gruppi di 100 possono essere creati dai blocchi mostrati.

Es) 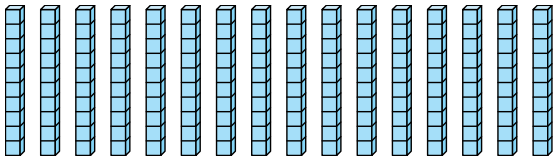

1) 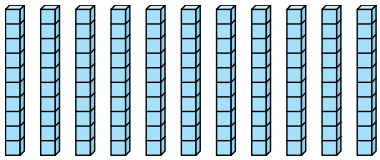

2) 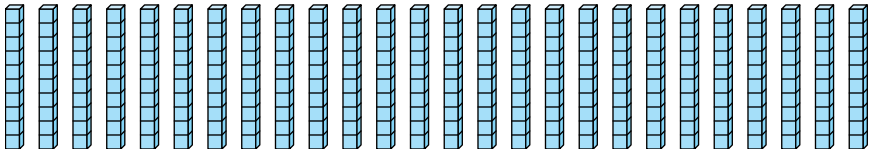

3) 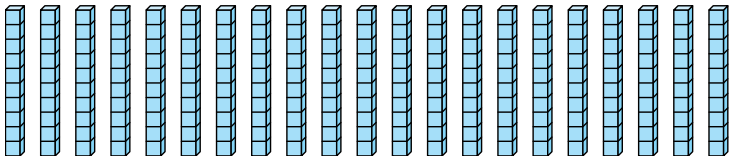

4) 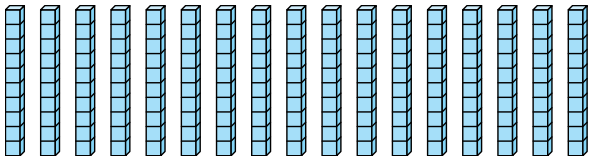

5) 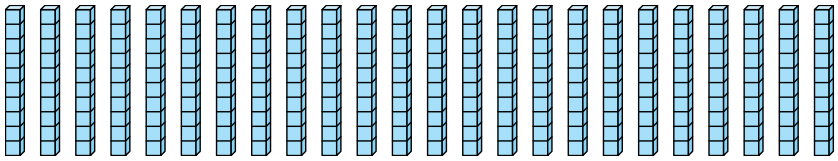

6) 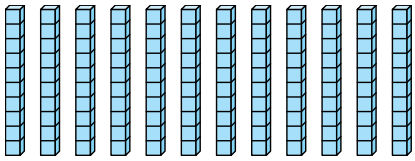

7) 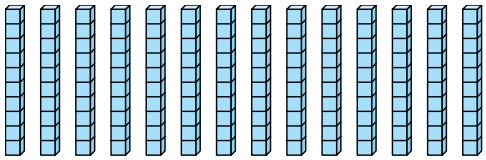

8) 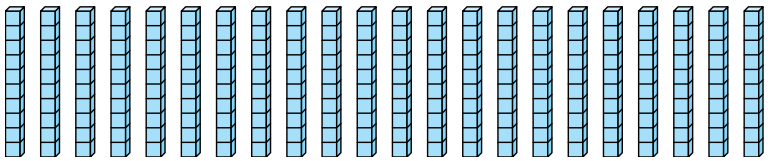

9) 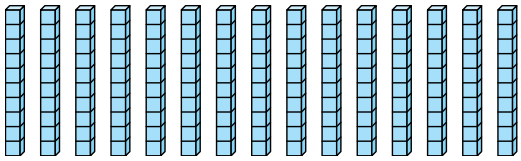

Risposte

Es. 1

1. _____

2. _____

3. _____

4. _____

5. _____

6. _____

7. _____

8. _____

9. _____

1-9	89	78	67	56	44	33	22	11	0

Creazione di gruppi di 100 Nome: **Soluzioni**

Determina quanti gruppi di 100 possono essere creati dai blocchi mostrati.

Es) 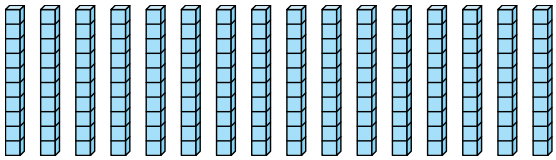

1) 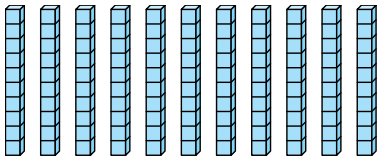

2) 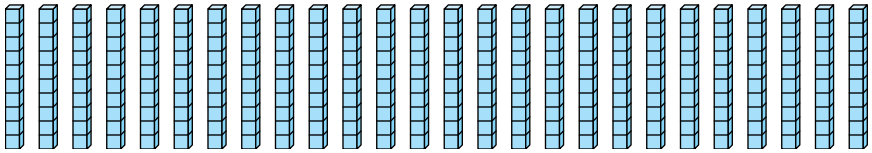

3) 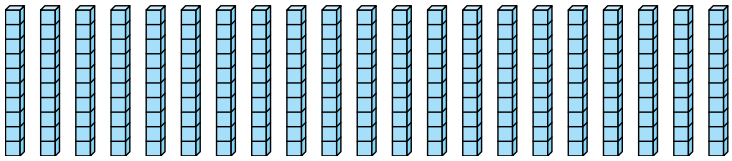

4) 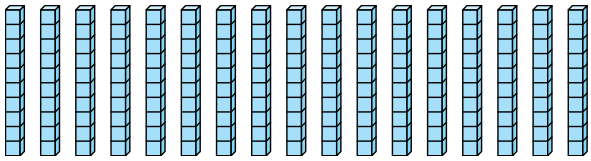

5) 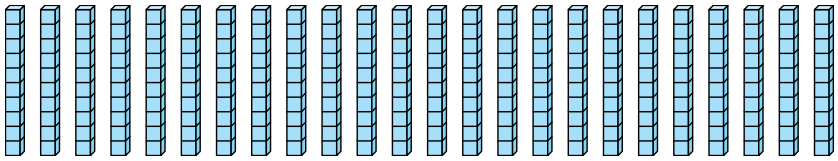

6) 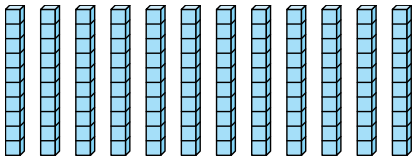

7) 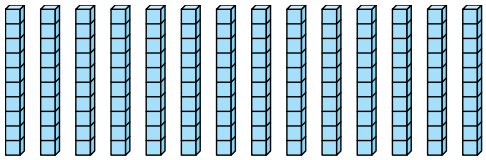

8) 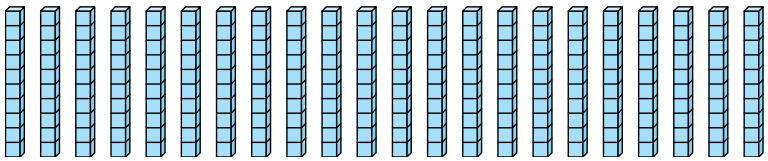

9) 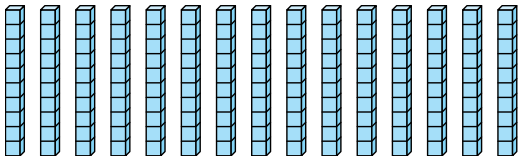

Risposte

Es.	1
1.	1
2.	2
3.	2
4.	1
5.	2
6.	1
7.	1
8.	2
9.	1

1-9	89	78	67	56	44	33	22	11	0