Orologi abbinati

Nome:

Abbina l'orologio analogico all'orologio digitale.

1) 
2) 
3) 
4) 

5) 
6) 
7) 
8) 

9) 
10) 
11) 
12) 

13) 
14) 
15) 
16) 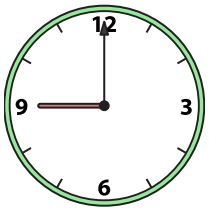

A. 3:30
B. 9:00
C. 12:00
D. 12:00
E. 10:30
F. 12:30
G. 8:00
H. 11:00
I. 5:00
J. 1:30
K. 12:30
L. 4:00
M. 3:00
N. 6:30
O. 8:30
P. 1:00

Risposte

1. _____
2. _____
3. _____
4. _____
5. _____
6. _____
7. _____
8. _____
9. _____
10. _____
11. _____
12. _____
13. _____
14. _____
15. _____
16. _____

1-10	94	88	81	75	69	63	56	50	44	38
11-16	31	25	19	13	6	0				

Orologi abbinati

Nome: **Soluzioni**

Abbina l'orologio analogico all'orologio digitale.

1) 
2) 
3) 
4) 

5) 
6) 
7) 
8) 

9) 
10) 
11) 
12) 

13) 
14) 
15) 
16) 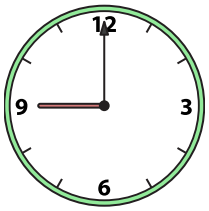

A. 3:30
B. 9:00
C. 12:00
D. 12:00
E. 10:30
F. 12:30
G. 8:00
H. 11:00
I. 5:00
J. 1:30
K. 12:30
L. 4:00
M. 3:00
N. 6:30
O. 8:30
P. 1:00

Risposte

1. H
2. F
3. A
4. C
5. D
6. P
7. J
8. O
9. K
10. I
11. M
12. L
13. N
14. E
15. G
16. B

1-10	94	88	81	75	69	63	56	50	44	38
11-16	31	25	19	13	6	0				