Identifica le forme regolari ed irregolari

Nome:

Determina se le forme rappresentate sono regolari o irregolari.

1)

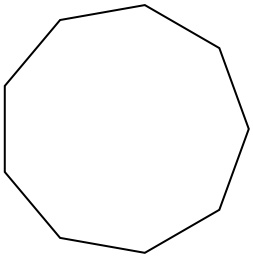

2)

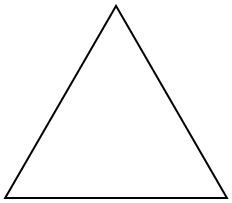

3)



4)

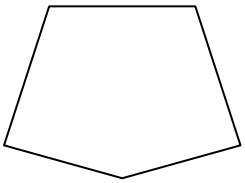

5)



6)

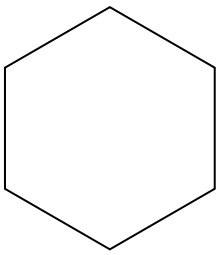

7)

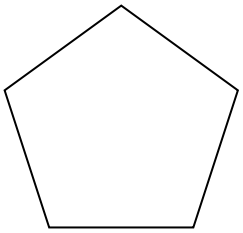

8)



9)

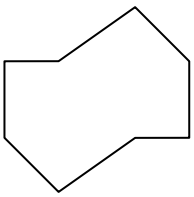

10)

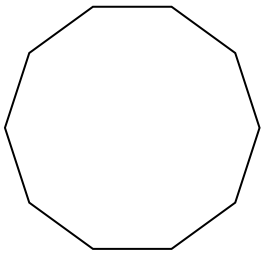

11)



12)



13)

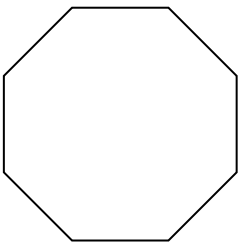

14)



15)

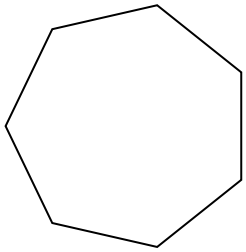

Risposte

1. _____
2. _____
3. _____
4. _____
5. _____
6. _____
7. _____
8. _____
9. _____
10. _____
11. _____
12. _____
13. _____
14. _____
15. _____

1-10	93	87	80	73	67	60	53	47	40	33
11-15	27	20	13	7	0					

Identifica le forme regolari ed irregolari Nome: **Soluzioni**

Determina se le forme rappresentate sono regolari o irregolari.

1)

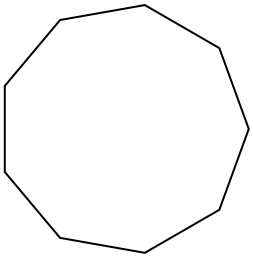

2)

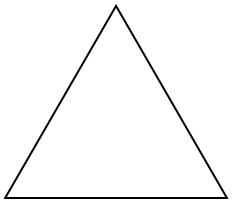

3)



4)

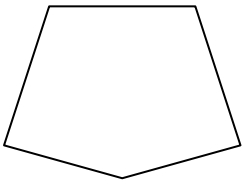

5)



6)

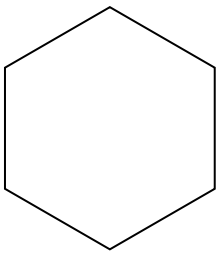

7)

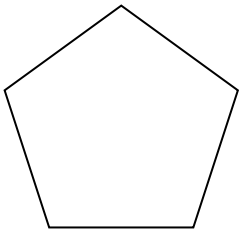

8)



9)

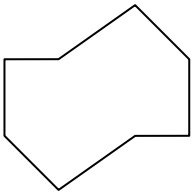

10)

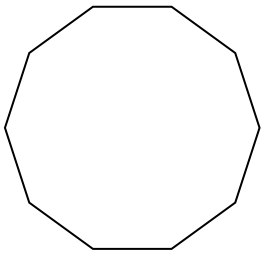

11)



12)



13)

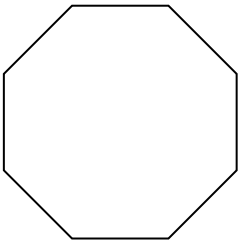

14)



15)

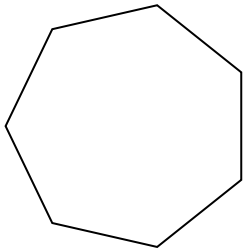

Risposte

1. Regolare
2. Regolare
3. Regolare
4. Irregolare
5. Irregolare
6. Regolare
7. Regolare
8. Irregolare
9. Irregolare
10. Regolare
11. Irregolare
12. Irregolare
13. Regolare
14. Irregolare
15. Regolare

1-10	93	87	80	73	67	60	53	47	40	33
11-15	27	20	13	7	0					