Collega le disuguaglianze con le linee numerate Nome:

Risolvi ogni problema.

1) Quale opzione rappresenta correttamente X < 17

A.

B. 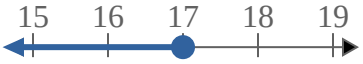

C.

D.

2) Quale opzione rappresenta correttamente X ≤ 16

A. 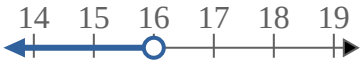

B.

C.

D.

3) Quale opzione rappresenta correttamente X ≤ 4

A.

B.

C.

D. 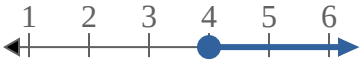

4) Quale opzione rappresenta correttamente X ≥ -11

A. 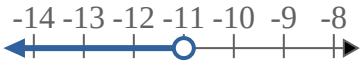

B.

C. 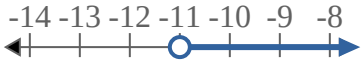

D. 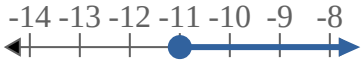

5) Quale opzione rappresenta correttamente X ≥ -8

A. 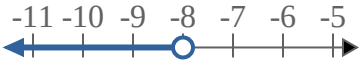

B. 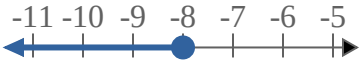

C. 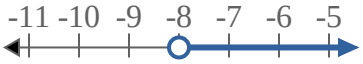

D. 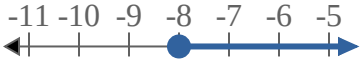

6) Quale opzione rappresenta correttamente X > -16

A.

B.

C. 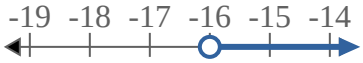

D.

7) Quale opzione rappresenta correttamente X ≥ -11

A.

B.

C. 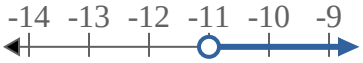

D. 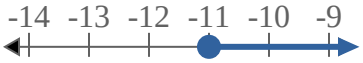

8) Quale opzione rappresenta correttamente X ≤ 6

A.

B.

C. 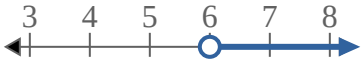

D.

Risposte

1. _____
2. _____
3. _____
4. _____
5. _____
6. _____
7. _____
8. _____

Collega le disuguaglianze con le linee numerate Nome: **Soluzioni**

Risolvi ogni problema.

1) Quale opzione rappresenta correttamente X < 17

A.

B. 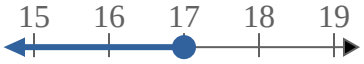

C.

D.

2) Quale opzione rappresenta correttamente X ≤ 16

A. 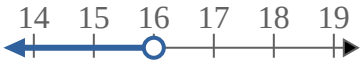

B.

C.

D.

3) Quale opzione rappresenta correttamente X ≤ 4

A.

B.

C.

D. 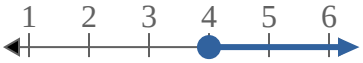

4) Quale opzione rappresenta correttamente X ≥ -11

A. 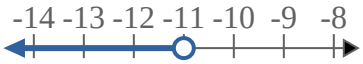

B.

C. 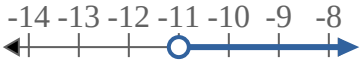

D. 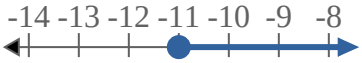

5) Quale opzione rappresenta correttamente X ≥ -8

A.

B.

C. 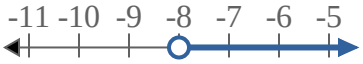

D. 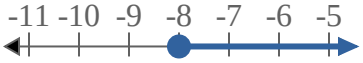

6) Quale opzione rappresenta correttamente X > -16

A.

B.

C. 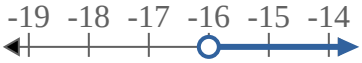

D. 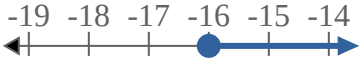

7) Quale opzione rappresenta correttamente X ≥ -11

A.

B.

C. 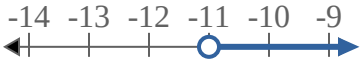

D. 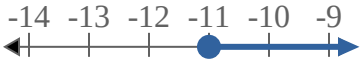

8) Quale opzione rappresenta correttamente X ≤ 6

A.

B.

C. 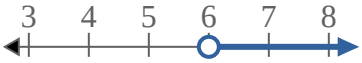

D.

Risposte

1. **A**
2. **B**
3. **B**
4. **D**
5. **D**
6. **C**
7. **D**
8. **B**

1-8	88	75	63	50	38	25	13	0