Funzioni (Addizioni e sottrazioni) Nome:

Determina quale regola viene usata nelle seguenti funzioni.

Es)

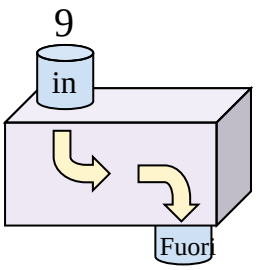

Aggiungi 17

1)

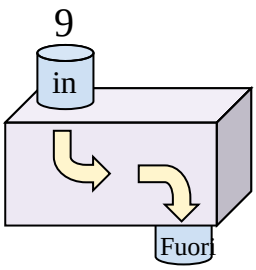

2)

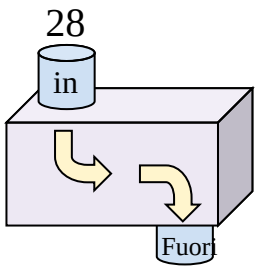

3)

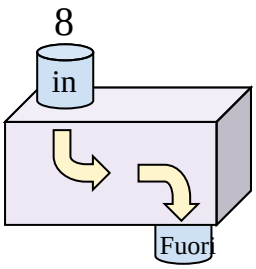

4)

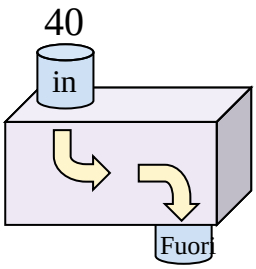

5)

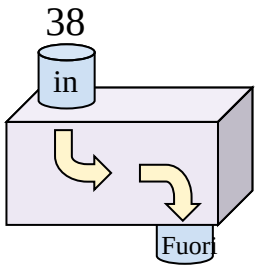

6)

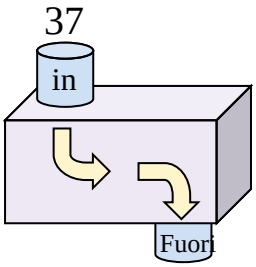

7)

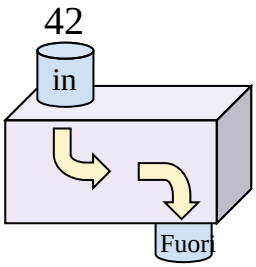

8)

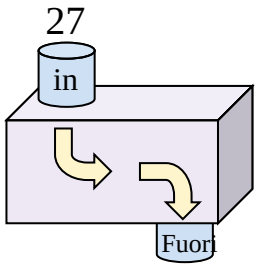

9)

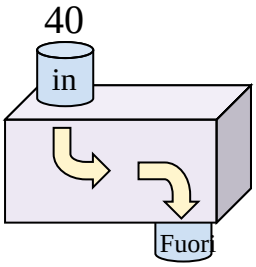

10)

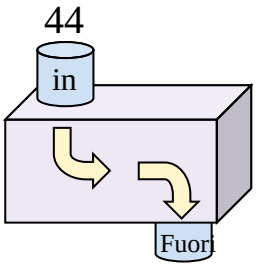

11)

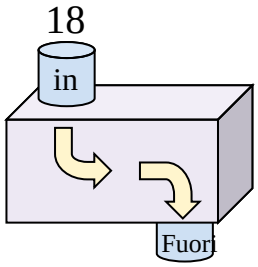

Risposte

Es. Aggiungi 17

1. _____
2. _____
3. _____
4. _____
5. _____
6. _____
7. _____
8. _____
9. _____
10. _____
11. _____

Funzioni (Addizioni e sottrazioni) Nome: **Soluzioni**

Determina quale regola viene usata nelle seguenti funzioni.

Es)

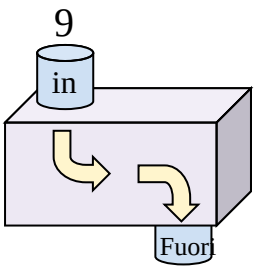

Aggiungi 17

1)

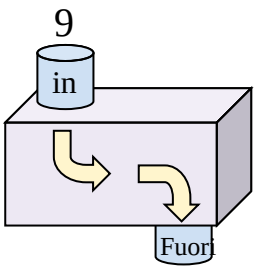

Aggiungi 27

2)

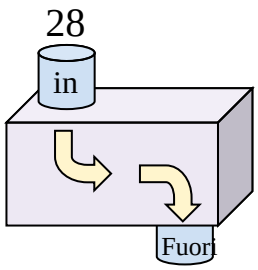

Aggiungi 15

3)

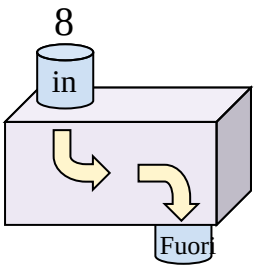

Aggiungi 37

4)

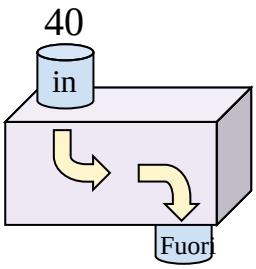

Sottrai 32

5)

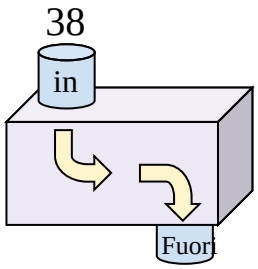

Sottrai 8

6)

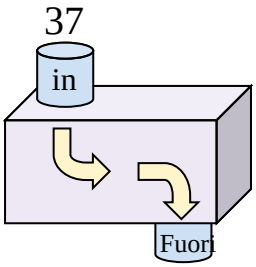

Sottrai 24

7)

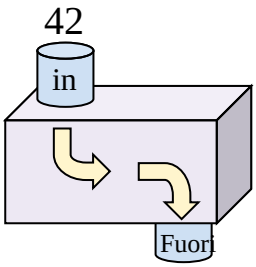

Sottrai 20

8)

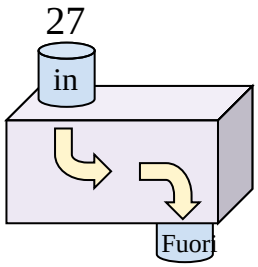

Aggiungi 18

9)

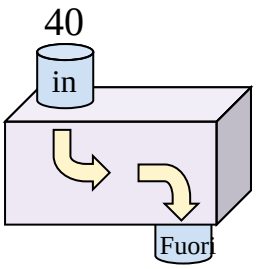

Sottrai 10

10)

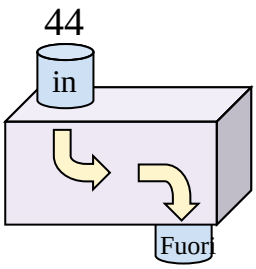

Sottrai 29

11)

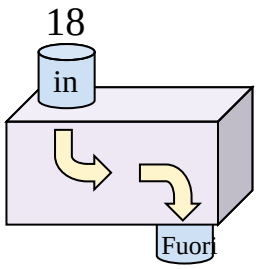

Aggiungi 29

Risposte

Es. **Aggiungi 17**

1. **Aggiungi 27**
2. **Aggiungi 15**
3. **Aggiungi 37**
4. **Sottrai 32**
5. **Sottrai 8**
6. **Sottrai 24**
7. **Sottrai 20**
8. **Aggiungi 18**
9. **Sottrai 10**
10. **Sottrai 29**
11. **Aggiungi 29**