Funzioni (Addizioni e sottrazioni) Nome:

**Determina quale regola viene usata nelle seguenti funzioni.**

**Es)**

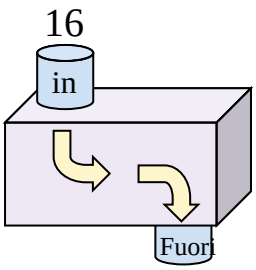


Aggiungi 12

**1)**

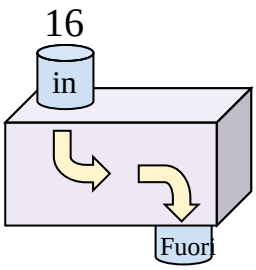


**2)**

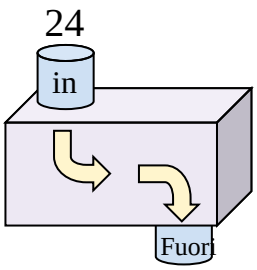


**3)**

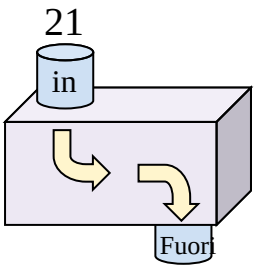


**4)**

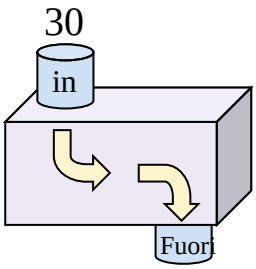


**5)**

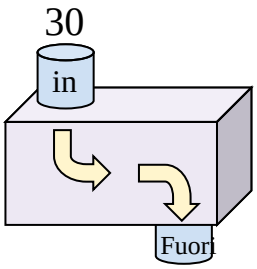


**6)**

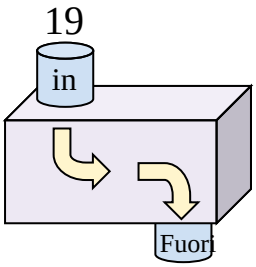


**7)**

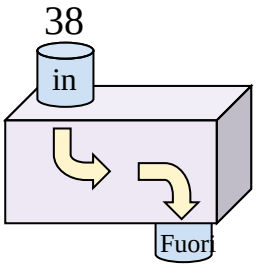


**8)**

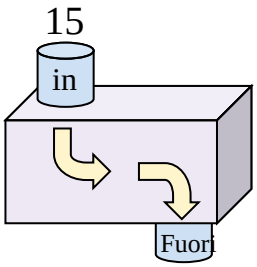


**9)**

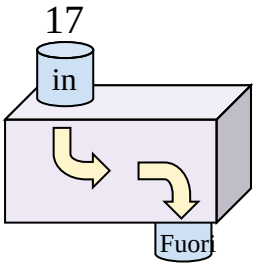


**10)**

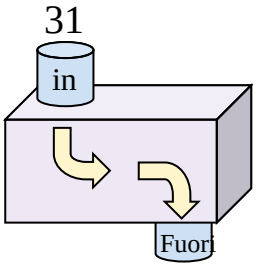


**11)**

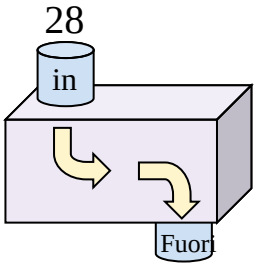


## Risposte

Es. Aggiungi 12

1. _____
2. _____
3. _____
4. _____
5. _____
6. _____
7. _____
8. _____
9. _____
10. _____
11. _____



| | | | | | | | | | | |
|---|---|---|---|---|---|---|---|---|---|---|
| 1-10 | 91 | 82 | 73 | 64 | 55 | 45 | 36 | 27 | 18 | 9 |
| 11 | 0 | | | | | | | | | |

Funzioni (Addizioni e sottrazioni) Nome: **Soluzioni**

**Determina quale regola viene usata nelle seguenti funzioni.**

**Es)**

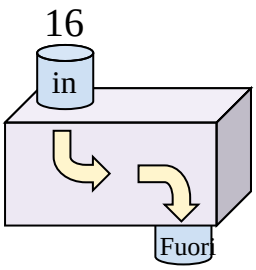


Aggiungi 12

**1)**

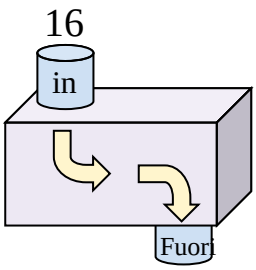


Aggiungi 6

**2)**

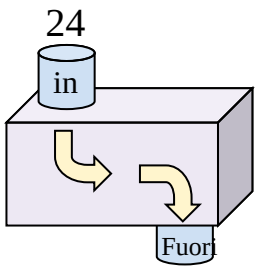


Sottrai 17

**3)**

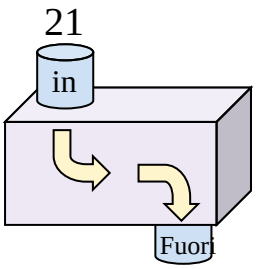


Aggiungi 14

**4)**

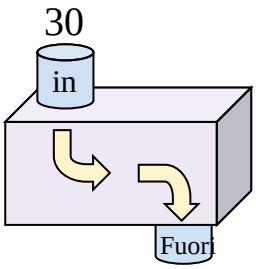


Sottrai 17

**5)**

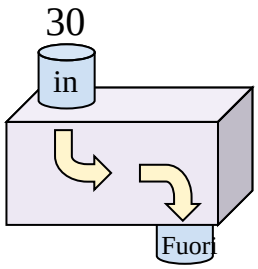


Sottrai 7

**6)**

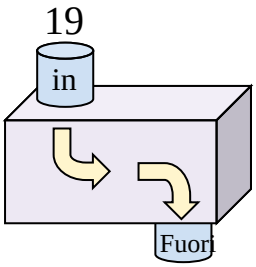


Aggiungi 13

**7)**

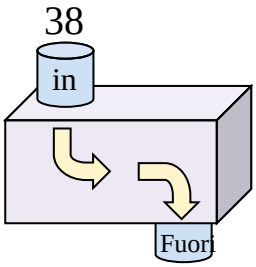


Sottrai 17

**8)**

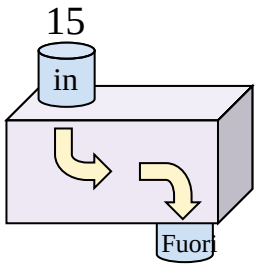


Aggiungi 8

**9)**

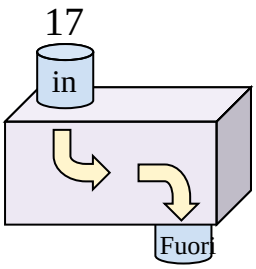


Aggiungi 15

**10)**

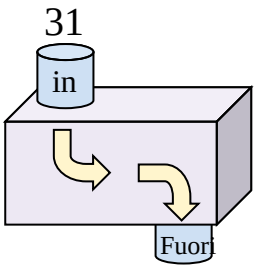


Sottrai 24

**11)**

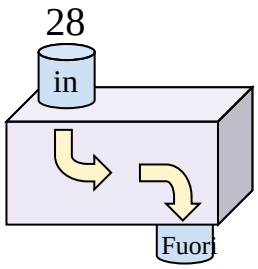


Sottrai 18

## Risposte

Es. **Aggiungi 12**

1. **Aggiungi 6**
2. **Sottrai 17**
3. **Aggiungi 14**
4. **Sottrai 17**
5. **Sottrai 7**
6. **Aggiungi 13**
7. **Sottrai 17**
8. **Aggiungi 8**
9. **Aggiungi 15**
10. **Sottrai 24**
11. **Sottrai 18**



| | | | | | | | | | | |
|---|---|---|---|---|---|---|---|---|---|---|
| 1-10 | 91 | 82 | 73 | 64 | 55 | 45 | 36 | 27 | 18 | 9 |
| 11 | 0 | | | | | | | | | |

Funzioni (Addizioni e sottrazioni) Nome:

**Determina quale regola viene usata nelle seguenti funzioni.**

**Es)**

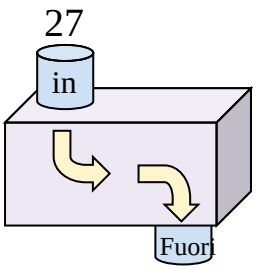


Sottrai 5

**1)**

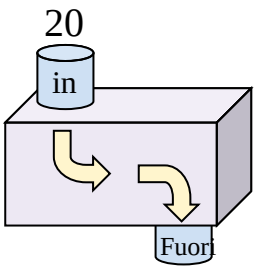


**2)**

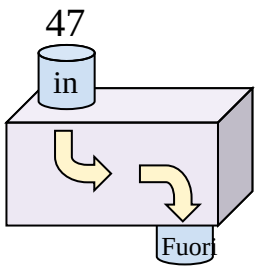


**3)**

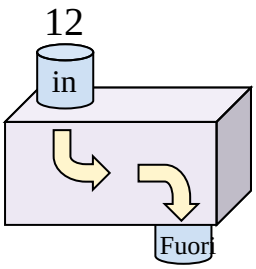


**4)**

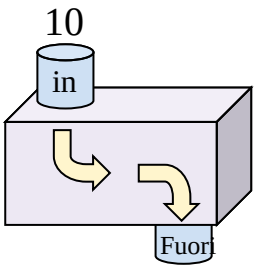


**5)**

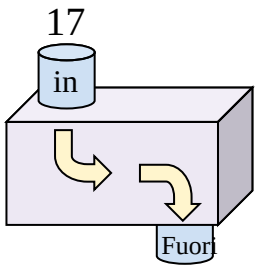


**6)**

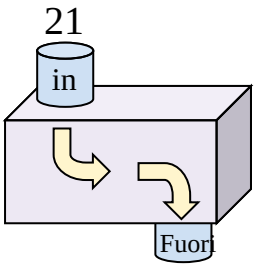


**7)**

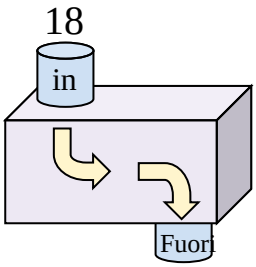


**8)**

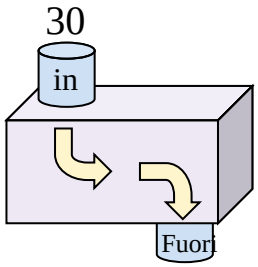


**9)**

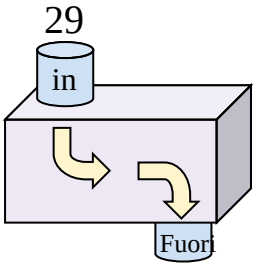


**10)**

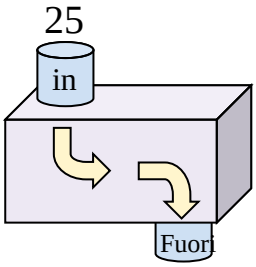


**11)**

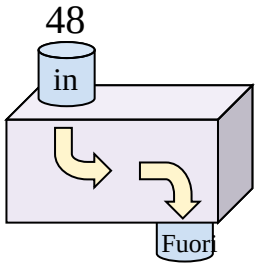


## Risposte

Es. Sottrai 5

1. _____
2. _____
3. _____
4. _____
5. _____
6. _____
7. _____
8. _____
9. _____
10. _____
11. _____



| | | | | | | | | | | |
|---|---|---|---|---|---|---|---|---|---|---|
| 1-10 | 91 | 82 | 73 | 64 | 55 | 45 | 36 | 27 | 18 | 9 |
| 11 | 0 | | | | | | | | | |

**Determina quale regola viene usata nelle seguenti funzioni.**

**Es)**

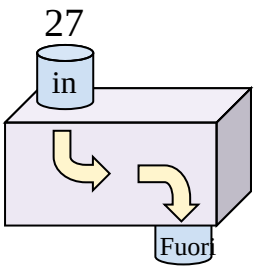


Sottrai 5

**1)**

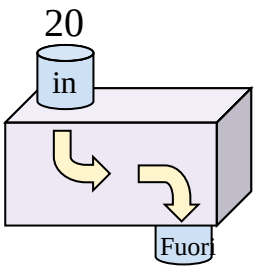


Aggiungi 14

**2)**

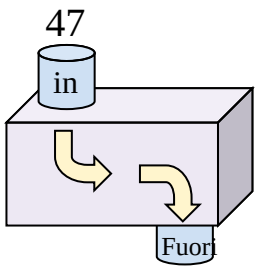


Sottrai 33

**3)**

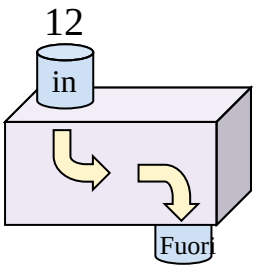


Aggiungi 27

**4)**

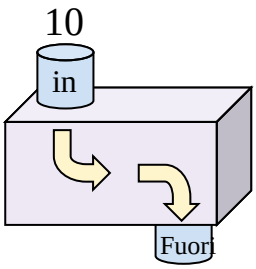


Aggiungi 30

**5)**

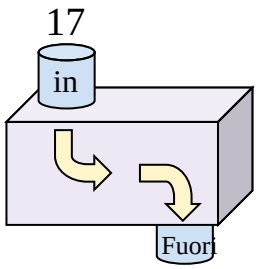


Aggiungi 25

**6)**

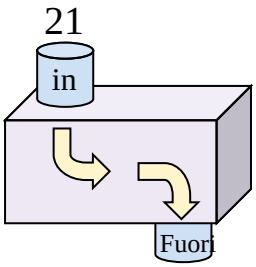


Aggiungi 24

**7)**

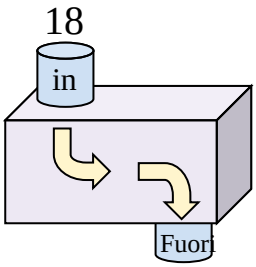


Sottrai 12

**8)**

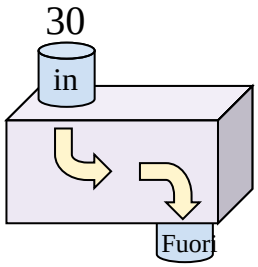


Sottrai 6

**9)**

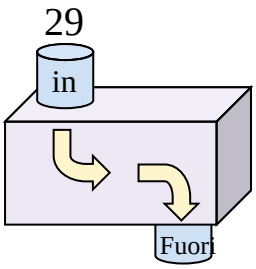


Aggiungi 18

**10)**

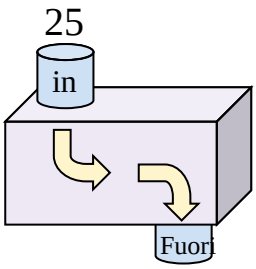


Aggiungi 5

**11)**

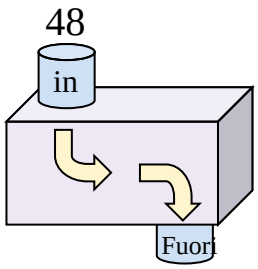


Sottrai 31

## Risposte

Es. **Sottrai 5**

1. **Aggiungi 14**
2. **Sottrai 33**
3. **Aggiungi 27**
4. **Aggiungi 30**
5. **Aggiungi 25**
6. **Aggiungi 24**
7. **Sottrai 12**
8. **Sottrai 6**
9. **Aggiungi 18**
10. **Aggiungi 5**
11. **Sottrai 31**



| | | | | | | | | | | |
|---|---|---|---|---|---|---|---|---|---|---|
| 1-10 | 91 | 82 | 73 | 64 | 55 | 45 | 36 | 27 | 18 | 9 |
| 11 | 0 | | | | | | | | | |

Funzioni (Addizioni e sottrazioni) Nome:

**Determina quale regola viene usata nelle seguenti funzioni.**

**Es)**

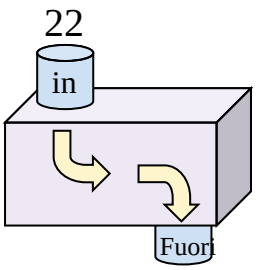


Aggiungi 20

**1)**

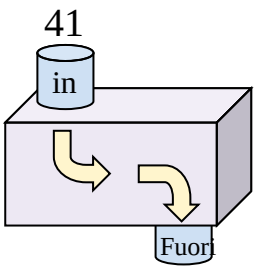


**2)**

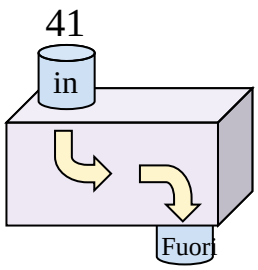


**3)**

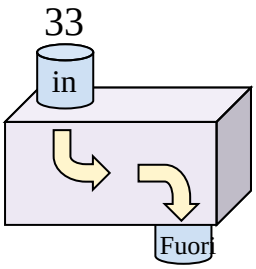


**4)**

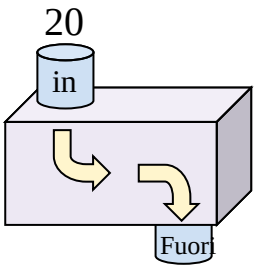


**5)**

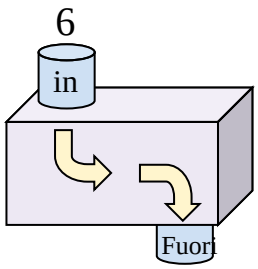


**6)**

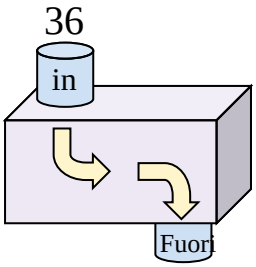


**7)**

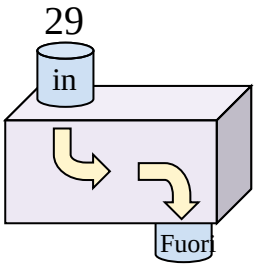


**8)**

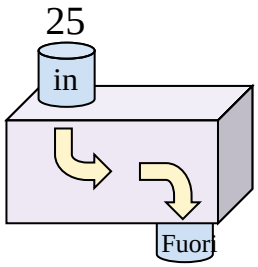


**9)**

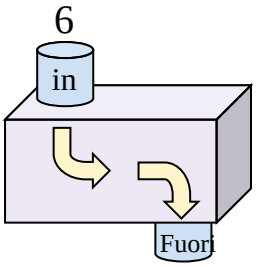


**10)**

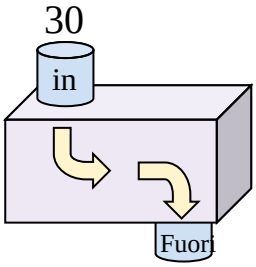


**11)**

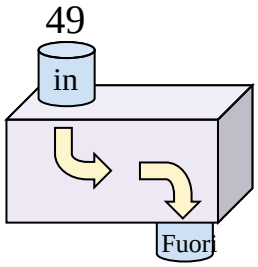


## Risposte

Es. Aggiungi 20

1. _____
2. _____
3. _____
4. _____
5. _____
6. _____
7. _____
8. _____
9. _____
10. _____
11. _____



| | | | | | | | | | | |
|---|---|---|---|---|---|---|---|---|---|---|
| 1-10 | 91 | 82 | 73 | 64 | 55 | 45 | 36 | 27 | 18 | 9 |
| 11 | 0 | | | | | | | | | |

**Determina quale regola viene usata nelle seguenti funzioni.**

**Es)**

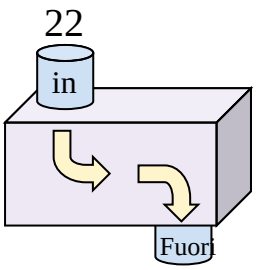


Aggiungi 20

**1)**

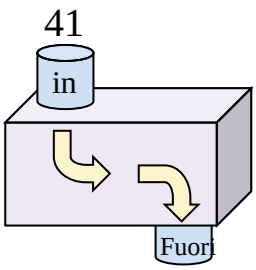


Sottrai 18

**2)**

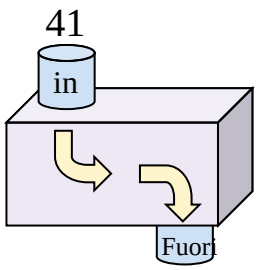


Sottrai 33

**3)**

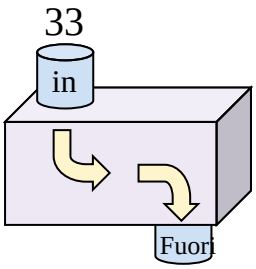


Sottrai 16

**4)**

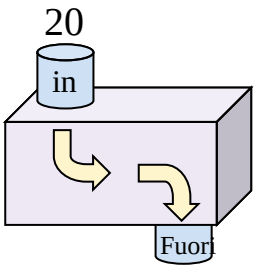


Sottrai 8

**5)**

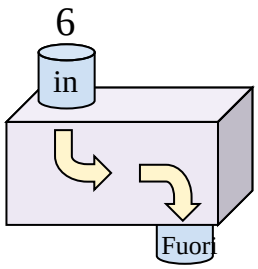


Aggiungi 37

**6)**

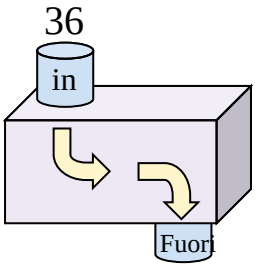


Sottrai 11

**7)**

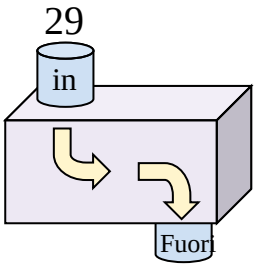


Aggiungi 15

**8)**

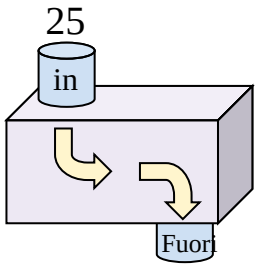


Aggiungi 25

**9)**

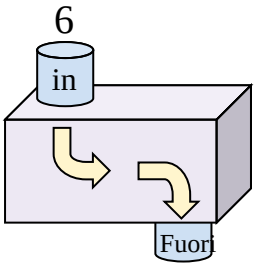


Aggiungi 10

**10)**

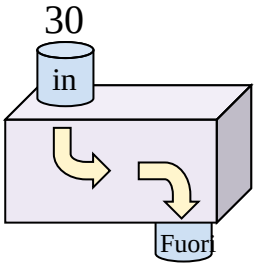


Sottrai 16

**11)**

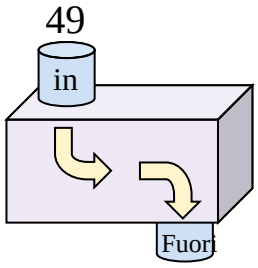


Sottrai 29

## Risposte

Es. **Aggiungi 20**

1. **Sottrai 18**
2. **Sottrai 33**
3. **Sottrai 16**
4. **Sottrai 8**
5. **Aggiungi 37**
6. **Sottrai 11**
7. **Aggiungi 15**
8. **Aggiungi 25**
9. **Aggiungi 10**
10. **Sottrai 16**
11. **Sottrai 29**



| | | | | | | | | | | |
|---|---|---|---|---|---|---|---|---|---|---|
| 1-10 | 91 | 82 | 73 | 64 | 55 | 45 | 36 | 27 | 18 | 9 |
| 11 | 0 | | | | | | | | | |

**Determina quale regola viene usata nelle seguenti funzioni.**

**Es)**

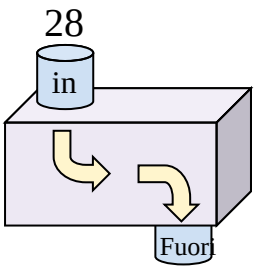


Aggiungi 8

**1)**

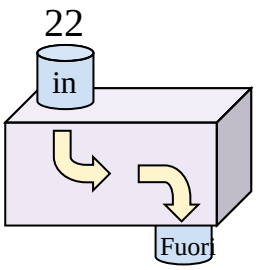


**2)**

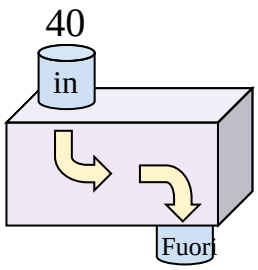


**3)**

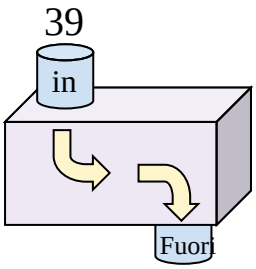


**4)**

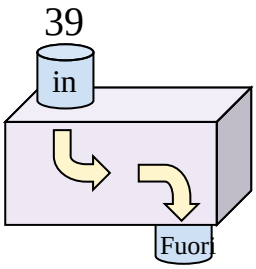


**5)**

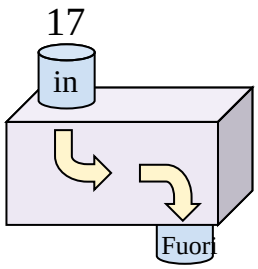


**6)**

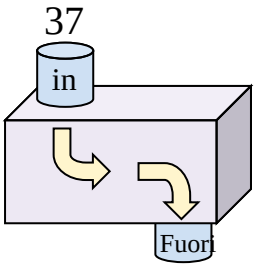


**7)**

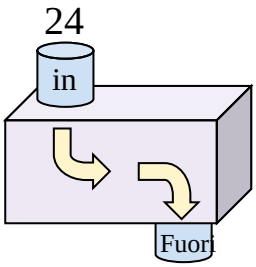


**8)**

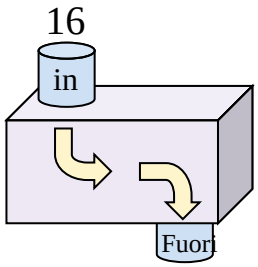


**9)**

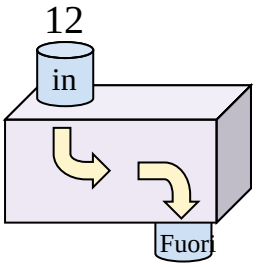


**10)**

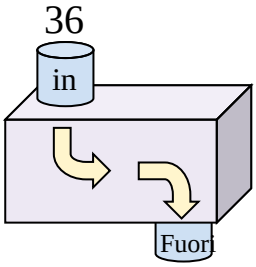


**11)**

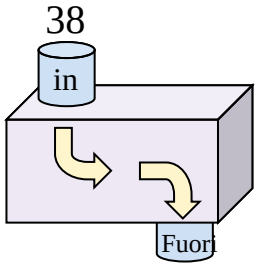


## Risposte

Es. Aggiungi 8

1. _____
2. _____
3. _____
4. _____
5. _____
6. _____
7. _____
8. _____
9. _____
10. _____
11. _____



| | | | | | | | | | | |
|---|---|---|---|---|---|---|---|---|---|---|
| 1-10 | 91 | 82 | 73 | 64 | 55 | 45 | 36 | 27 | 18 | 9 |
| 11 | 0 | | | | | | | | | |

**Determina quale regola viene usata nelle seguenti funzioni.**

**Es)**

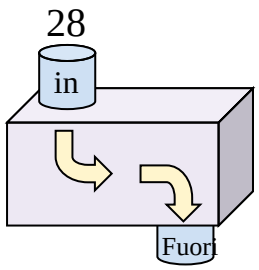


Aggiungi 8

**1)**

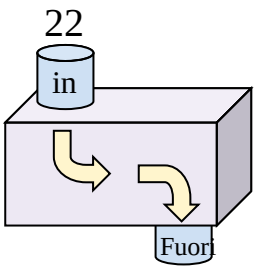


Aggiungi 6

**2)**

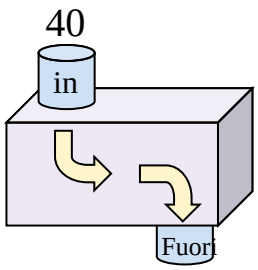


Sottrai 16

**3)**

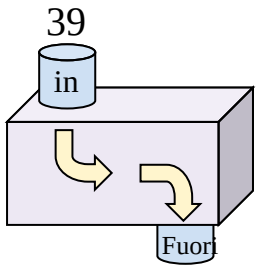


Sottrai 17

**4)**

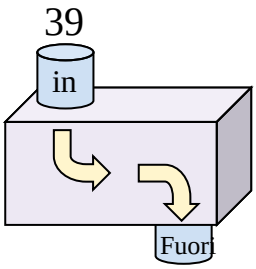


Sottrai 32

**5)**

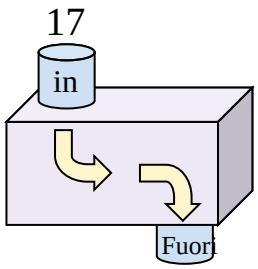


Sottrai 6

**6)**

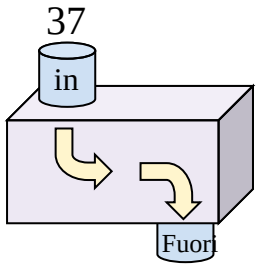


Sottrai 14

**7)**

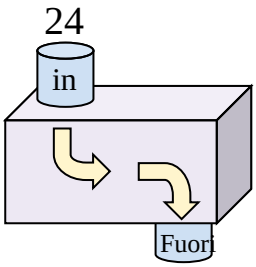


Aggiungi 18

**8)**

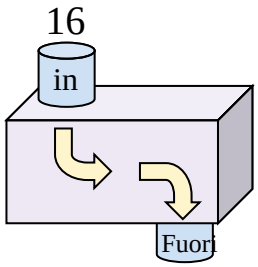


Aggiungi 33

**9)**

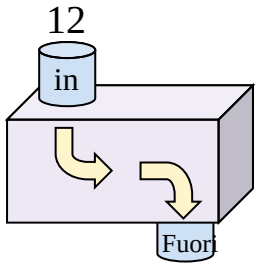


Aggiungi 34

**10)**

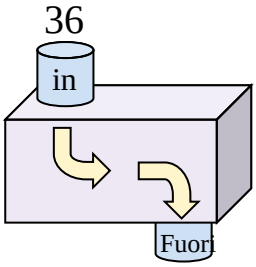


Sottrai 26

**11)**

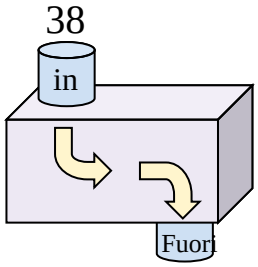


Sottrai 9

## Risposte

| | |
|---|---|
| Es. | Aggiungi 8 |
| 1. | Aggiungi 6 |
| 2. | Sottrai 16 |
| 3. | Sottrai 17 |
| 4. | Sottrai 32 |
| 5. | Sottrai 6 |
| 6. | Sottrai 14 |
| 7. | Aggiungi 18 |
| 8. | Aggiungi 33 |
| 9. | Aggiungi 34 |
| 10. | Sottrai 26 |
| 11. | Sottrai 9 |



| | | | | | | | | | | |
|---|---|---|---|---|---|---|---|---|---|---|
| 1-10 | 91 | 82 | 73 | 64 | 55 | 45 | 36 | 27 | 18 | 9 |
| 11 | 0 | | | | | | | | | |

**Determina quale regola viene usata nelle seguenti funzioni.**

**Es)**

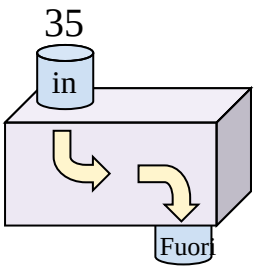


Sottrai 13

**1)**

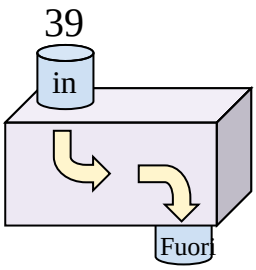


**2)**

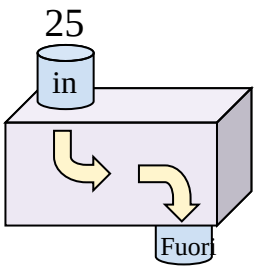


**3)**

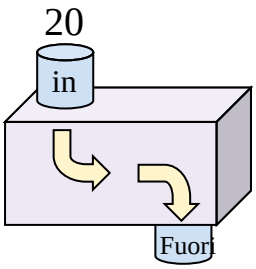


**4)**

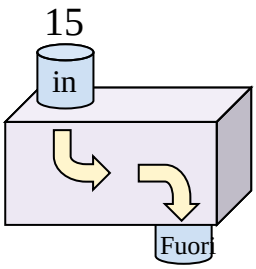


**5)**

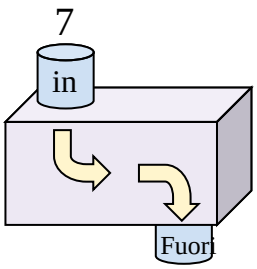


**6)**

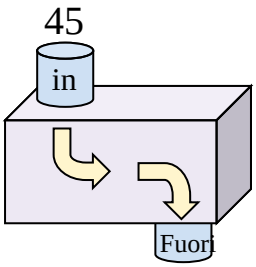


**7)**

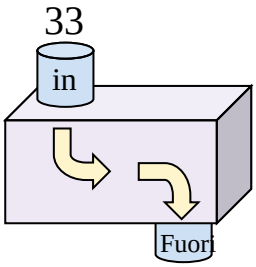


**8)**

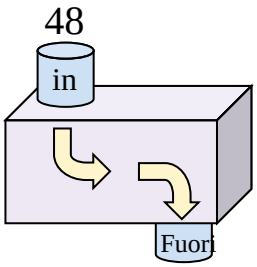


**9)**

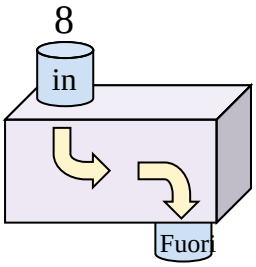


**10)**

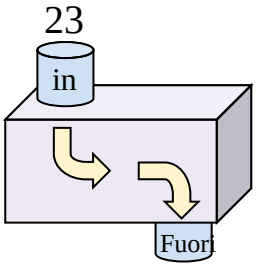


**11)**

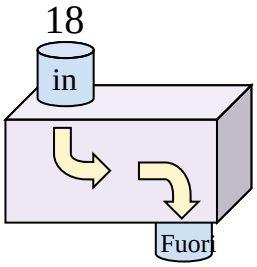


## Risposte

Es. Sottrai 13

1. _____
2. _____
3. _____
4. _____
5. _____
6. _____
7. _____
8. _____
9. _____
10. _____
11. _____



| | | | | | | | | | | |
|---|---|---|---|---|---|---|---|---|---|---|
| 1-10 | 91 | 82 | 73 | 64 | 55 | 45 | 36 | 27 | 18 | 9 |
| 11 | 0 | | | | | | | | | |

Funzioni (Addizioni e sottrazioni) Nome: **Soluzioni**

**Determina quale regola viene usata nelle seguenti funzioni.**

**Es)**

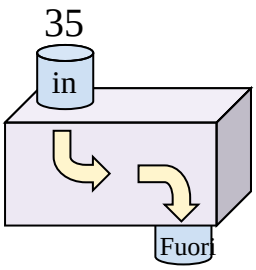


Sottrai 13

**1)**

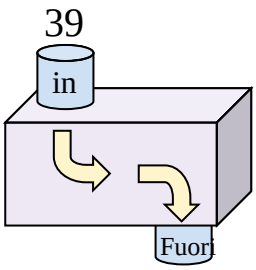


Sottrai 31

**2)**

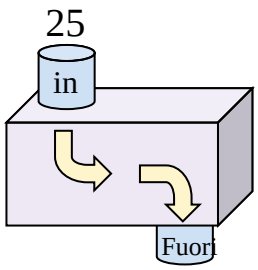


Aggiungi 10

**3)**

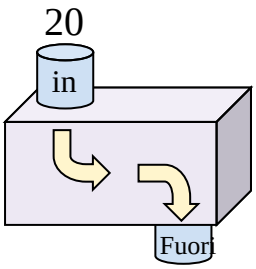


Aggiungi 8

**4)**

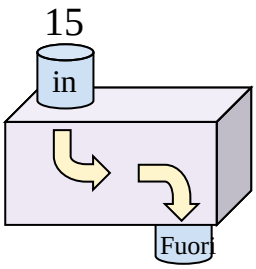


Aggiungi 34

**5)**

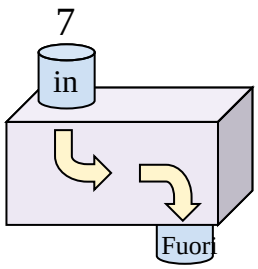


Aggiungi 21

**6)**

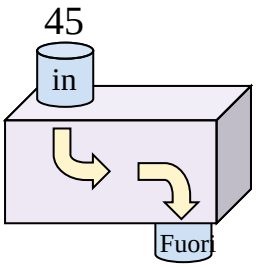


Sottrai 21

**7)**

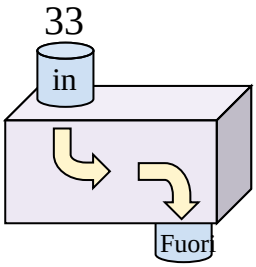


Sottrai 13

**8)**

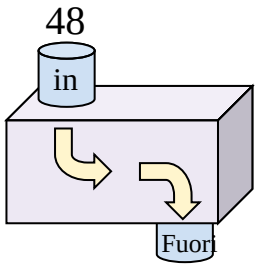


Sottrai 28

**9)**

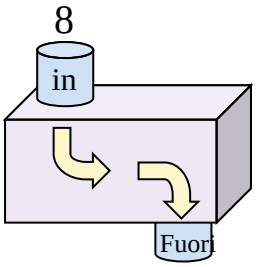


Aggiungi 38

**10)**

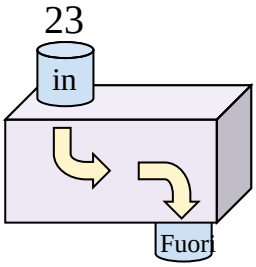


Aggiungi 12

**11)**

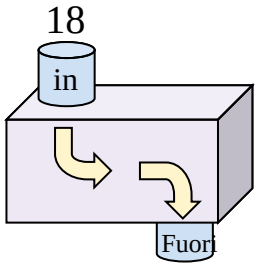


Aggiungi 6

## Risposte

Es. **Sottrai 13**

1. **Sottrai 31**
2. **Aggiungi 10**
3. **Aggiungi 8**
4. **Aggiungi 34**
5. **Aggiungi 21**
6. **Sottrai 21**
7. **Sottrai 13**
8. **Sottrai 28**
9. **Aggiungi 38**
10. **Aggiungi 12**
11. **Aggiungi 6**



| | | | | | | | | | | |
|---|---|---|---|---|---|---|---|---|---|---|
| 1-10 | 91 | 82 | 73 | 64 | 55 | 45 | 36 | 27 | 18 | 9 |
| 11 | 0 | | | | | | | | | |

Funzioni (Addizioni e sottrazioni) Nome:

**Determina quale regola viene usata nelle seguenti funzioni.**

**Es)**

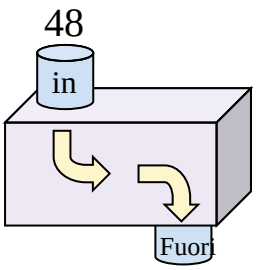


Sottrai 33

**1)**

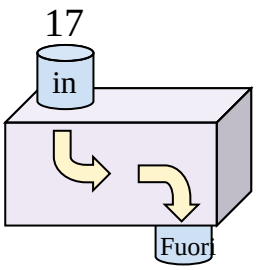


**2)**

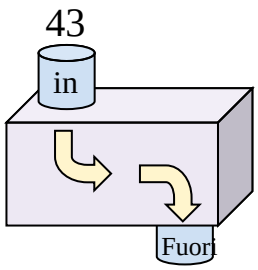


**3)**

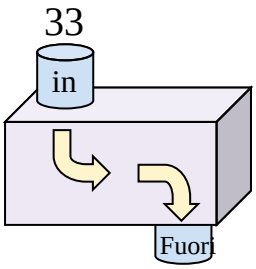


**4)**

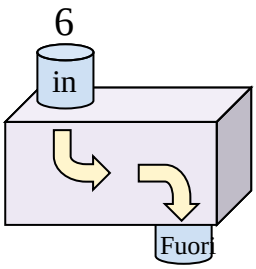


**5)**

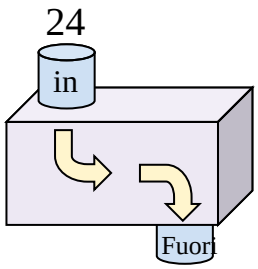


**6)**

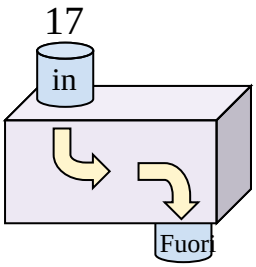


**7)**

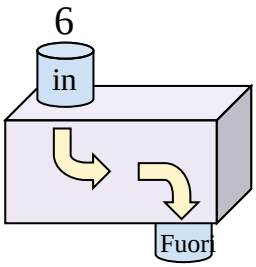


**8)**

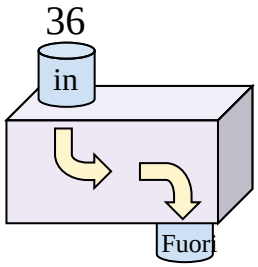


**9)**

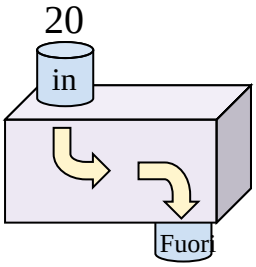


**10)**

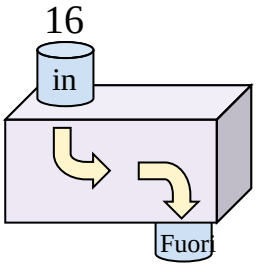


**11)**

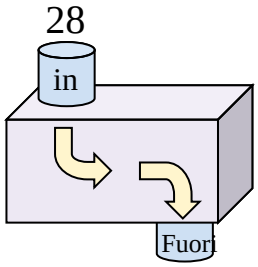


## Risposte

Es. Sottrai 33

1. _____
2. _____
3. _____
4. _____
5. _____
6. _____
7. _____
8. _____
9. _____
10. _____
11. _____



| | | | | | | | | | | |
|---|---|---|---|---|---|---|---|---|---|---|
| 1-10 | 91 | 82 | 73 | 64 | 55 | 45 | 36 | 27 | 18 | 9 |
| 11 | 0 | | | | | | | | | |

**Determina quale regola viene usata nelle seguenti funzioni.**

**Es)**

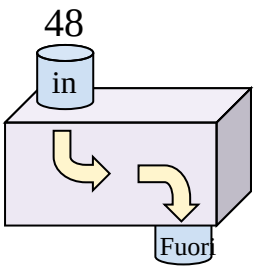


Sottrai 33

**1)**

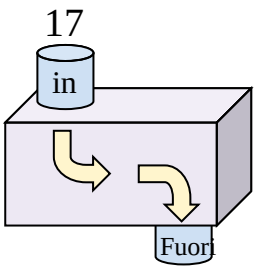


Aggiungi 15

**2)**

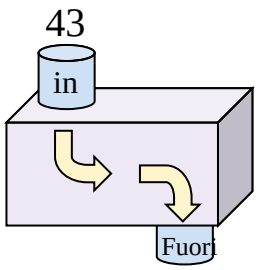


Sottrai 23

**3)**

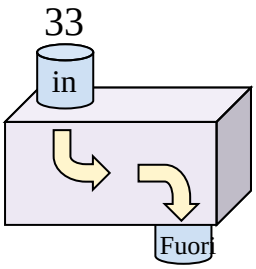


Sottrai 15

**4)**

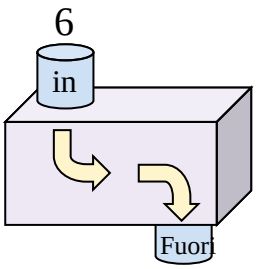


Aggiungi 36

**5)**

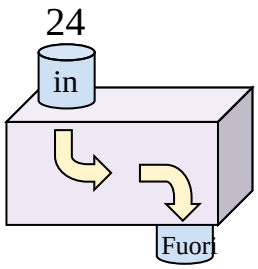


Aggiungi 14

**6)**

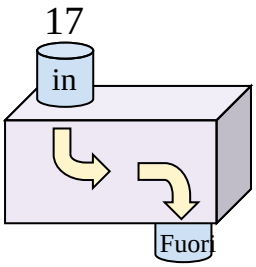


Aggiungi 9

**7)**

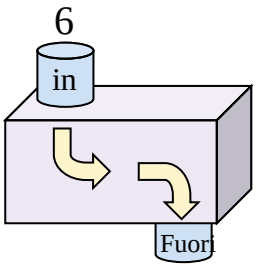


Aggiungi 14

**8)**

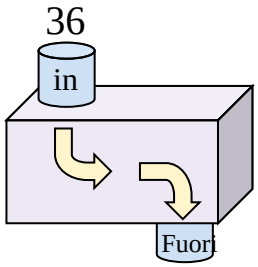


Sottrai 16

**9)**

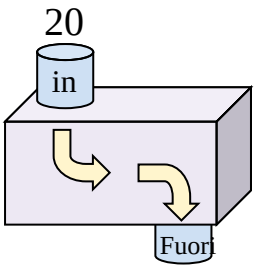


Aggiungi 8

**10)**

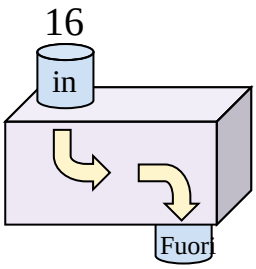


Aggiungi 19

**11)**

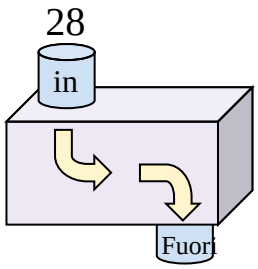


Sottrai 9

## Risposte

Es. **Sottrai 33**

1. **Aggiungi 15**
2. **Sottrai 23**
3. **Sottrai 15**
4. **Aggiungi 36**
5. **Aggiungi 14**
6. **Aggiungi 9**
7. **Aggiungi 14**
8. **Sottrai 16**
9. **Aggiungi 8**
10. **Aggiungi 19**
11. **Sottrai 9**



| | | | | | | | | | | |
|---|---|---|---|---|---|---|---|---|---|---|
| 1-10 | 91 | 82 | 73 | 64 | 55 | 45 | 36 | 27 | 18 | 9 |
| 11 | 0 | | | | | | | | | |

Funzioni (Addizioni e sottrazioni) Nome:

**Determina quale regola viene usata nelle seguenti funzioni.**

**Es)**

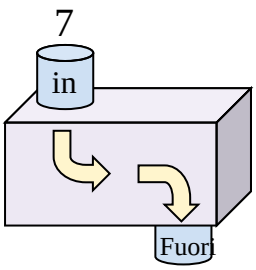


Aggiungi 13

**1)**

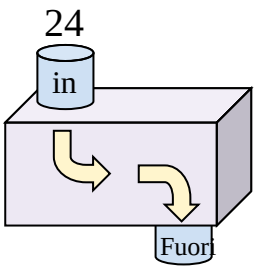


**2)**

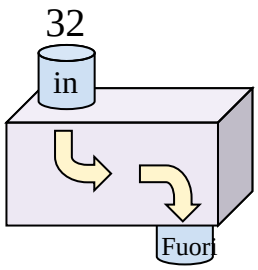


**3)**

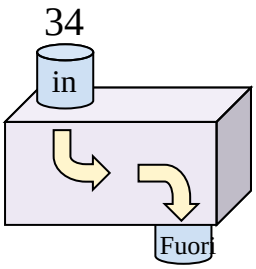


**4)**

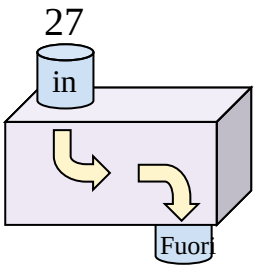


**5)**

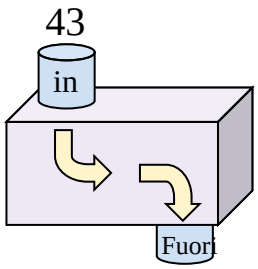


**6)**

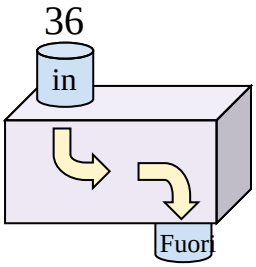


**7)**

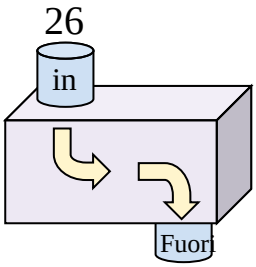


**8)**

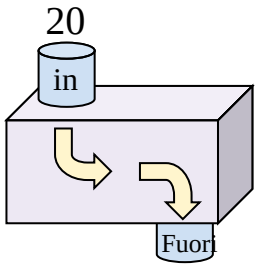


**9)**

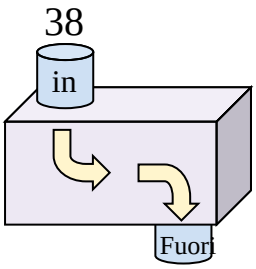


**10)**

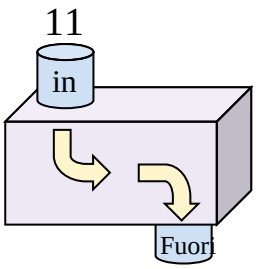


**11)**

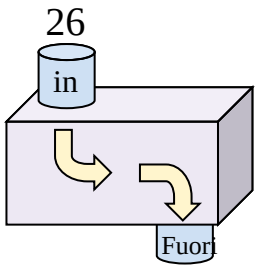


## Risposte

Es. Aggiungi 13

1. _____
2. _____
3. _____
4. _____
5. _____
6. _____
7. _____
8. _____
9. _____
10. _____
11. _____



| | | | | | | | | | | |
|---|---|---|---|---|---|---|---|---|---|---|
| 1-10 | 91 | 82 | 73 | 64 | 55 | 45 | 36 | 27 | 18 | 9 |
| 11 | 0 | | | | | | | | | |

Funzioni (Addizioni e sottrazioni) Nome: **Soluzioni**

**Determina quale regola viene usata nelle seguenti funzioni.**

**Es)**

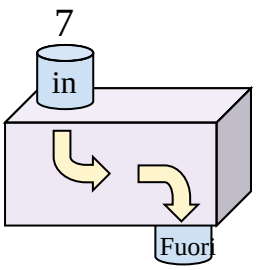


Aggiungi 13

**1)**

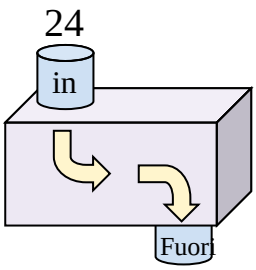


Aggiungi 9

**2)**

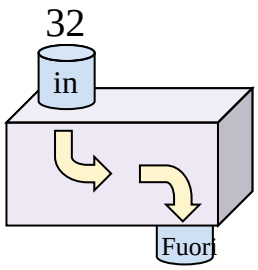


Sottrai 23

**3)**

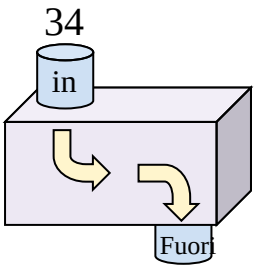


Sottrai 5

**4)**

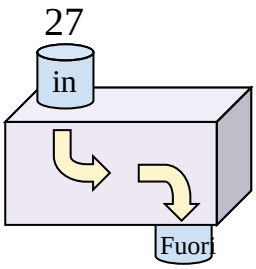


Aggiungi 10

**5)**

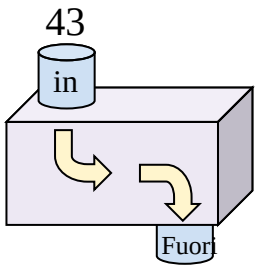


Sottrai 17

**6)**

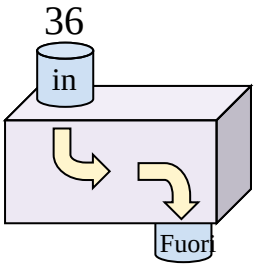


Sottrai 16

**7)**

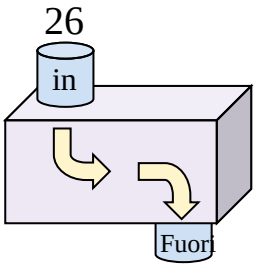


Aggiungi 5

**8)**

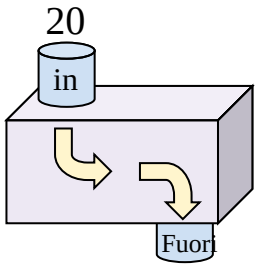


Aggiungi 13

**9)**

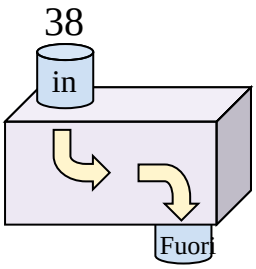


Sottrai 26

**10)**

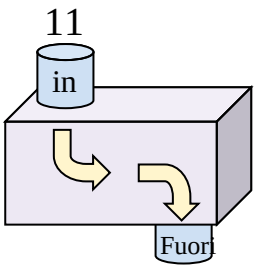


Aggiungi 8

**11)**

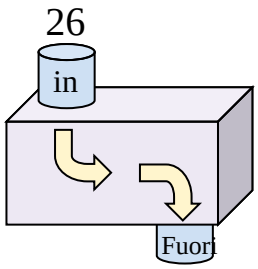


Sottrai 16

## Risposte

Es. Aggiungi 13

1. Aggiungi 9
2. Sottrai 23
3. Sottrai 5
4. Aggiungi 10
5. Sottrai 17
6. Sottrai 16
7. Aggiungi 5
8. Aggiungi 13
9. Sottrai 26
10. Aggiungi 8
11. Sottrai 16



| | | | | | | | | | | |
|---|---|---|---|---|---|---|---|---|---|---|
| 1-10 | 91 | 82 | 73 | 64 | 55 | 45 | 36 | 27 | 18 | 9 |
| 11 | 0 | | | | | | | | | |

**Determina quale regola viene usata nelle seguenti funzioni.**

**Es)**

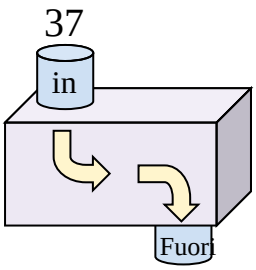


Sottrai 14

**1)**

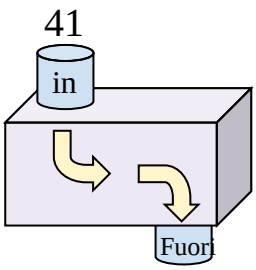


**2)**

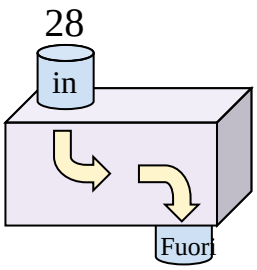


**3)**

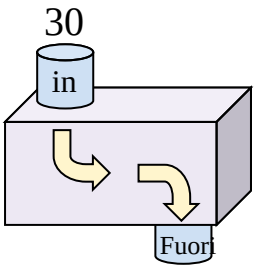


**4)**

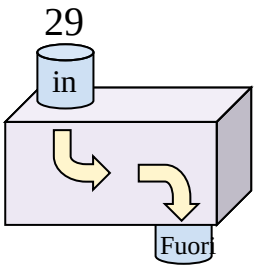


**5)**

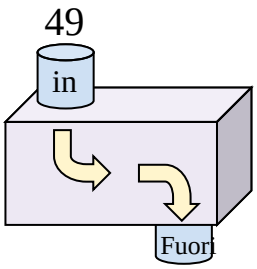


**6)**

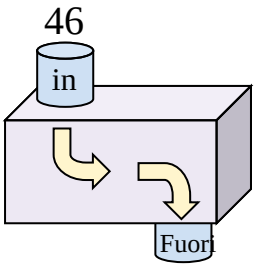


**7)**

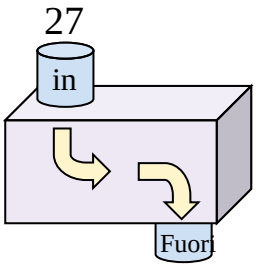


**8)**

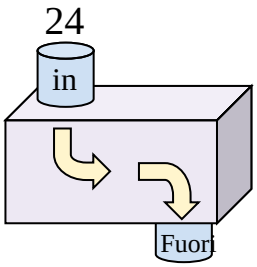


**9)**

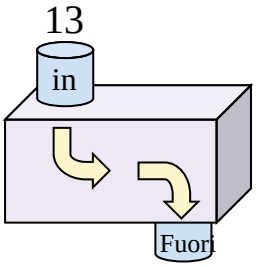


**10)**

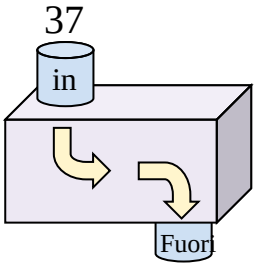


**11)**

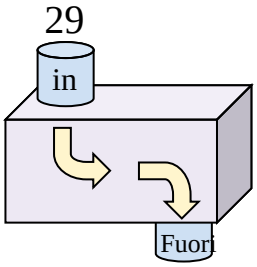


## Risposte

Es. Sottrai 14

1. _____
2. _____
3. _____
4. _____
5. _____
6. _____
7. _____
8. _____
9. _____
10. _____
11. _____



| | | | | | | | | | | |
|---|---|---|---|---|---|---|---|---|---|---|
| 1-10 | 91 | 82 | 73 | 64 | 55 | 45 | 36 | 27 | 18 | 9 |
| 11 | 0 | | | | | | | | | |

**Determina quale regola viene usata nelle seguenti funzioni.**

**Es)**

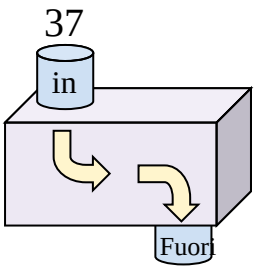


Sottrai 14

**1)**

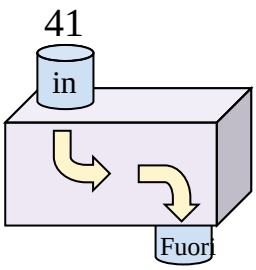


Sottrai 19

**2)**

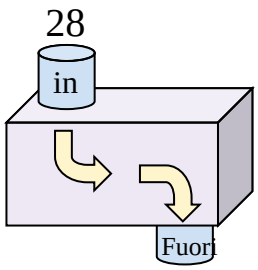


Aggiungi 16

**3)**

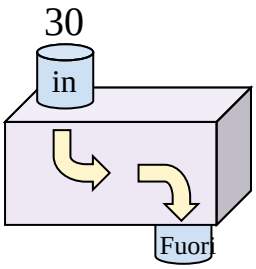


Aggiungi 14

**4)**

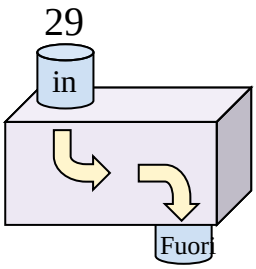


Aggiungi 21

**5)**

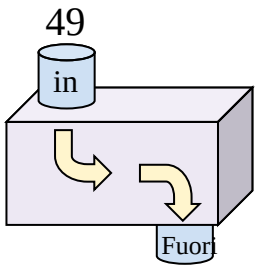


Sottrai 33

**6)**

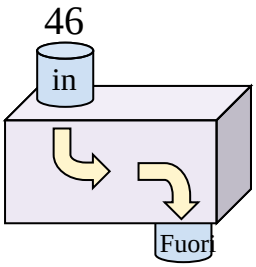


Sottrai 29

**7)**

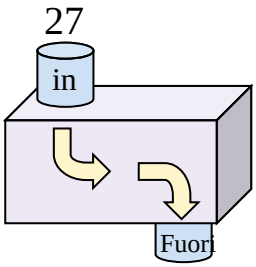


Aggiungi 9

**8)**

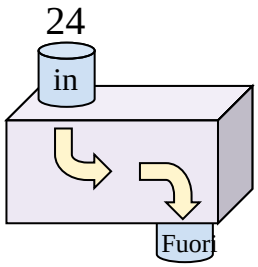


Aggiungi 6

**9)**

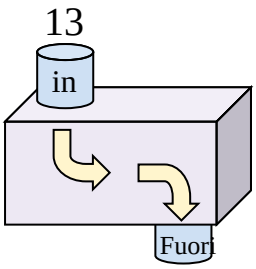


Aggiungi 12

**10)**

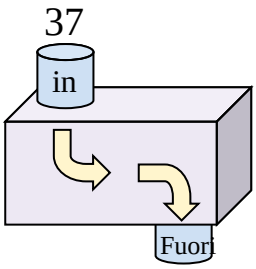


Sottrai 7

**11)**

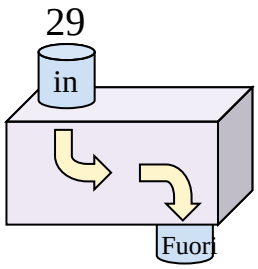


Aggiungi 16

## Risposte

Es. **Sottrai 14**

1. **Sottrai 19**
2. **Aggiungi 16**
3. **Aggiungi 14**
4. **Aggiungi 21**
5. **Sottrai 33**
6. **Sottrai 29**
7. **Aggiungi 9**
8. **Aggiungi 6**
9. **Aggiungi 12**
10. **Sottrai 7**
11. **Aggiungi 16**



| | | | | | | | | | | |
|---|---|---|---|---|---|---|---|---|---|---|
| 1-10 | 91 | 82 | 73 | 64 | 55 | 45 | 36 | 27 | 18 | 9 |
| 11 | 0 | | | | | | | | | |

Funzioni (Addizioni e sottrazioni) Nome:

**Determina quale regola viene usata nelle seguenti funzioni.**

**Es)**

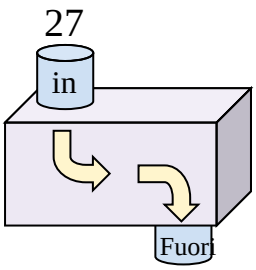


Aggiungi 12

**1)**

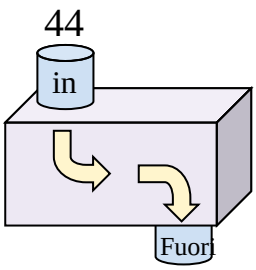


**2)**

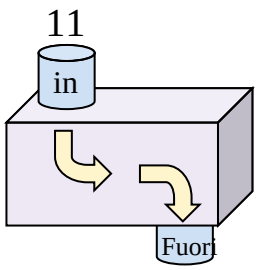


**3)**

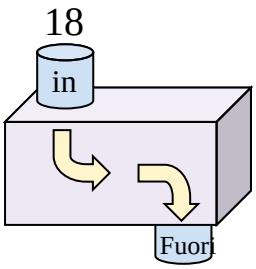


**4)**

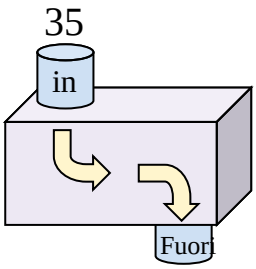


**5)**

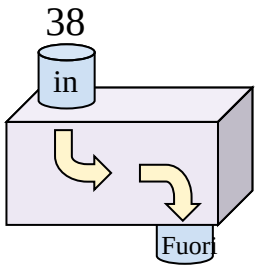


**6)**

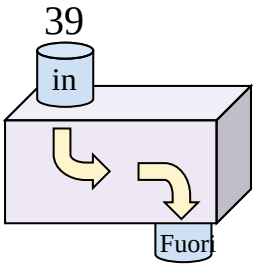


**7)**

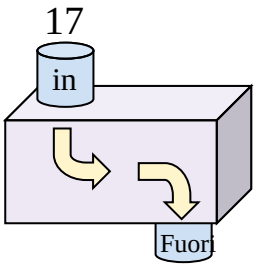


**8)**

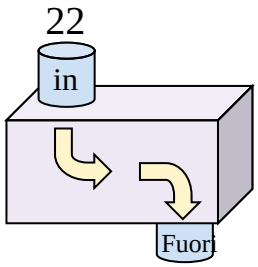


**9)**

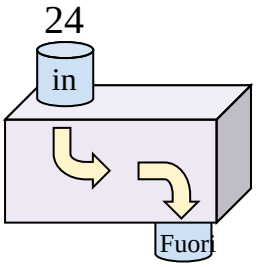


**10)**

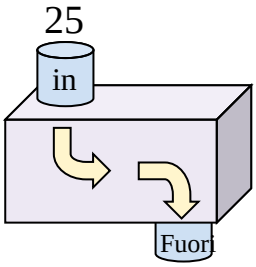


**11)**

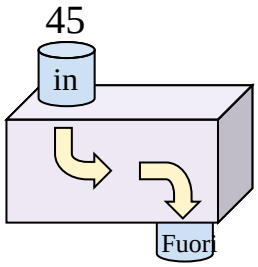


## Risposte

Es. Aggiungi 12

1. _____
2. _____
3. _____
4. _____
5. _____
6. _____
7. _____
8. _____
9. _____
10. _____
11. _____



| | | | | | | | | | | |
|---|---|---|---|---|---|---|---|---|---|---|
| 1-10 | 91 | 82 | 73 | 64 | 55 | 45 | 36 | 27 | 18 | 9 |
| 11 | 0 | | | | | | | | | |

Funzioni (Addizioni e sottrazioni) Nome: **Soluzioni**

**Determina quale regola viene usata nelle seguenti funzioni.**

**Es)**

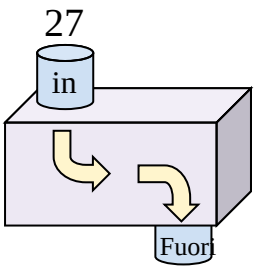


Aggiungi 12

**1)**

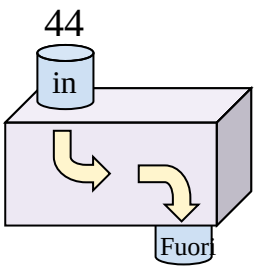


Sottrai 30

**2)**

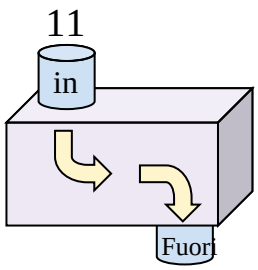


Aggiungi 8

**3)**

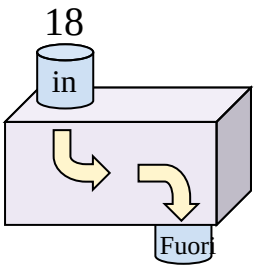


Aggiungi 30

**4)**

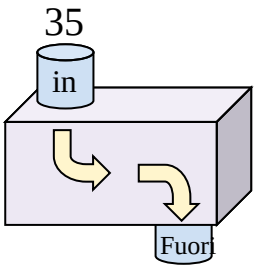


Sottrai 26

**5)**

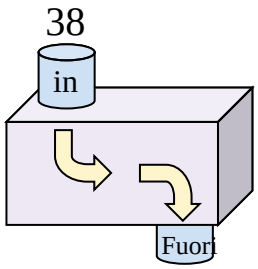


Sottrai 22

**6)**

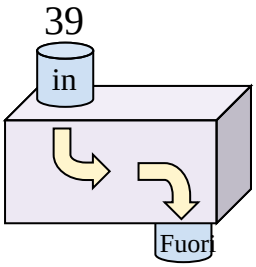


Sottrai 21

**7)**

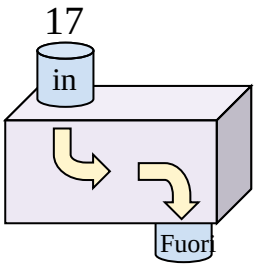


Aggiungi 18

**8)**

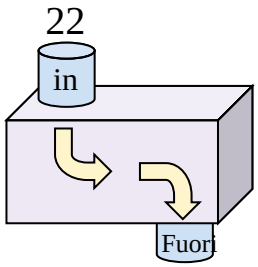


Sottrai 5

**9)**

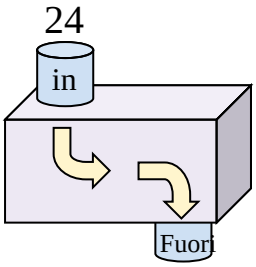


Aggiungi 12

**10)**

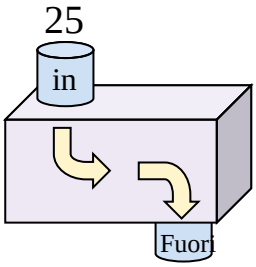


Aggiungi 18

**11)**

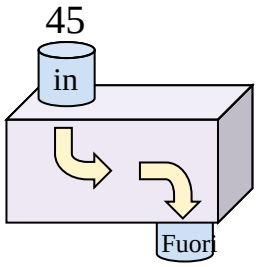


Sottrai 35

## Risposte

Es. **Aggiungi 12**

1. **Sottrai 30**
2. **Aggiungi 8**
3. **Aggiungi 30**
4. **Sottrai 26**
5. **Sottrai 22**
6. **Sottrai 21**
7. **Aggiungi 18**
8. **Sottrai 5**
9. **Aggiungi 12**
10. **Aggiungi 18**
11. **Sottrai 35**



| | | | | | | | | | | |
|---|---|---|---|---|---|---|---|---|---|---|
| 1-10 | 91 | 82 | 73 | 64 | 55 | 45 | 36 | 27 | 18 | 9 |
| 11 | 0 | | | | | | | | | |

Funzioni (Addizioni e sottrazioni) Nome:

**Determina quale regola viene usata nelle seguenti funzioni.**

**Es)**

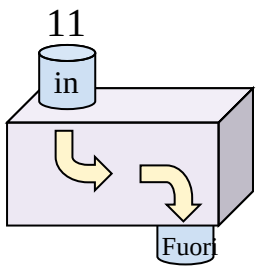


Aggiungi 20

**1)**

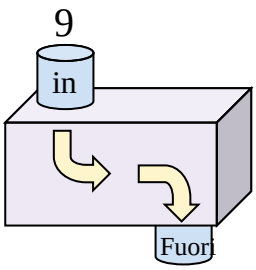


**2)**

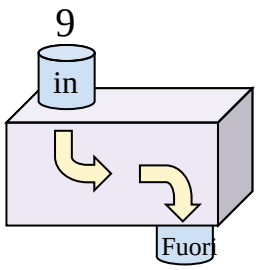


**3)**

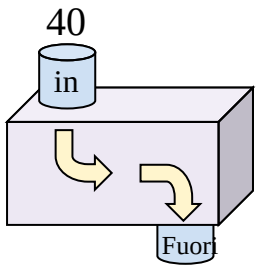


**4)**

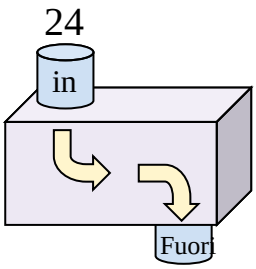


**5)**

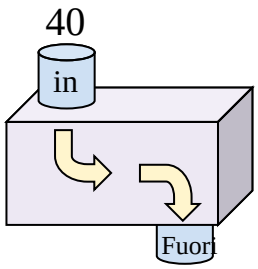


**6)**

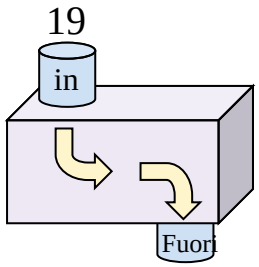


**7)**

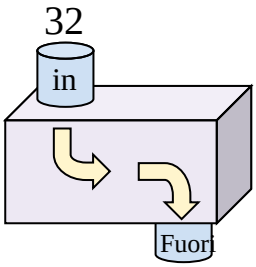


**8)**

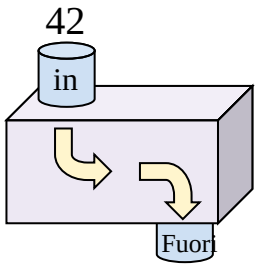


**9)**

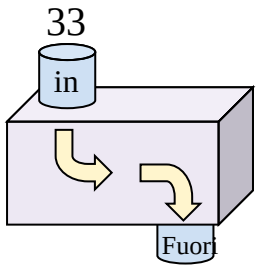


**10)**

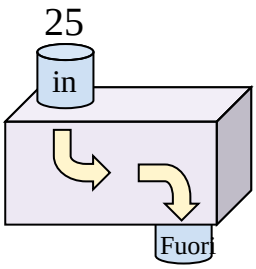


**11)**

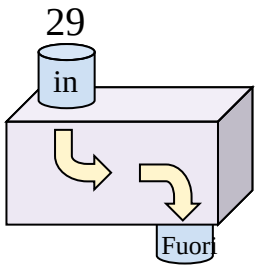


## Risposte

Es. Aggiungi 20

1. _____
2. _____
3. _____
4. _____
5. _____
6. _____
7. _____
8. _____
9. _____
10. _____
11. _____



| | | | | | | | | | | |
|---|---|---|---|---|---|---|---|---|---|---|
| 1-10 | 91 | 82 | 73 | 64 | 55 | 45 | 36 | 27 | 18 | 9 |
| 11 | 0 | | | | | | | | | |

Funzioni (Addizioni e sottrazioni) Nome: **Soluzioni**

**Determina quale regola viene usata nelle seguenti funzioni.**

**Es)**

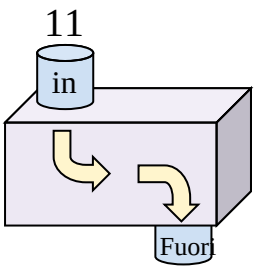


Aggiungi 20

**1)**

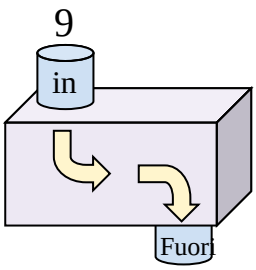


Aggiungi 27

**2)**

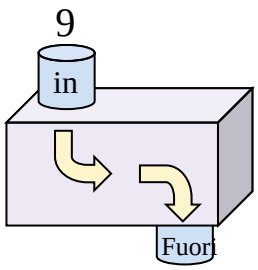


Aggiungi 25

**3)**

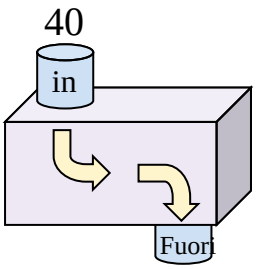


Sottrai 28

**4)**

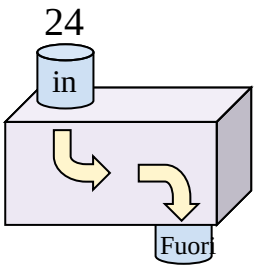


Sottrai 6

**5)**

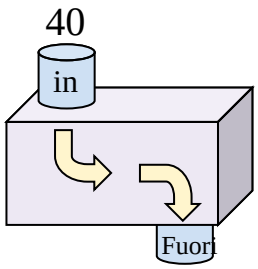


Sottrai 34

**6)**

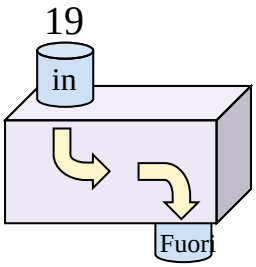


Aggiungi 14

**7)**

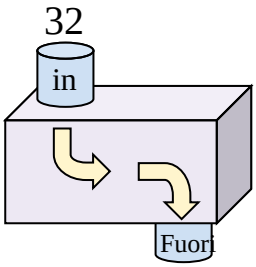


Sottrai 8

**8)**

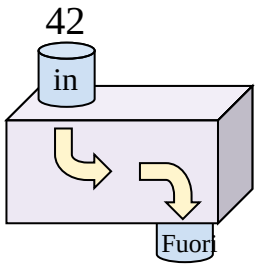


Sottrai 24

**9)**

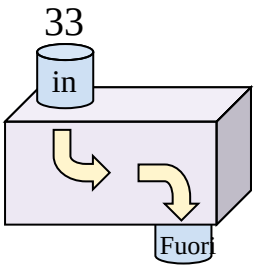


Sottrai 25

**10)**

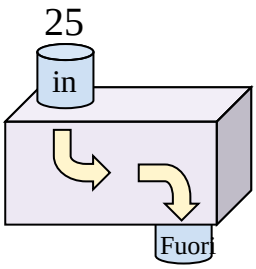


Aggiungi 14

**11)**

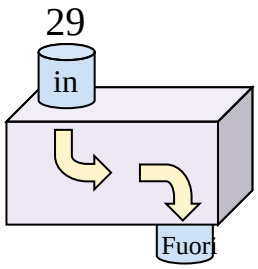


Aggiungi 9

## Risposte

Es. **Aggiungi 20**

1. **Aggiungi 27**
2. **Aggiungi 25**
3. **Sottrai 28**
4. **Sottrai 6**
5. **Sottrai 34**
6. **Aggiungi 14**
7. **Sottrai 8**
8. **Sottrai 24**
9. **Sottrai 25**
10. **Aggiungi 14**
11. **Aggiungi 9**



| | | | | | | | | | | |
|---|---|---|---|---|---|---|---|---|---|---|
| 1-10 | 91 | 82 | 73 | 64 | 55 | 45 | 36 | 27 | 18 | 9 |
| 11 | 0 | | | | | | | | | |