Determina quale regola viene usata nelle seguenti funzioni.

Es)

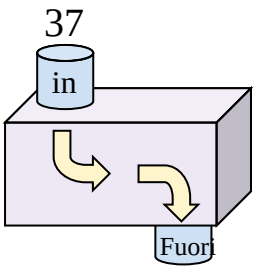

Sottrai 14

1)

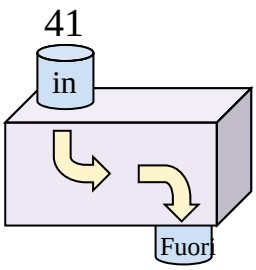

2)

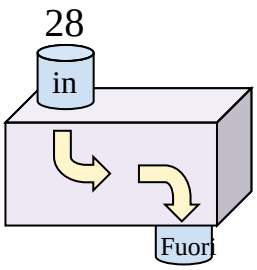

3)

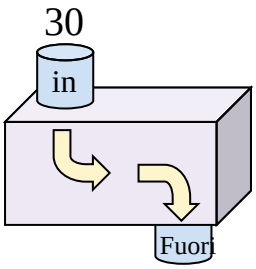

4)

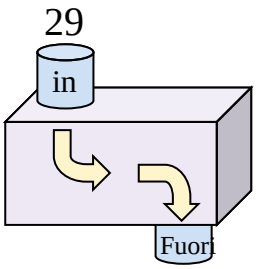

5)

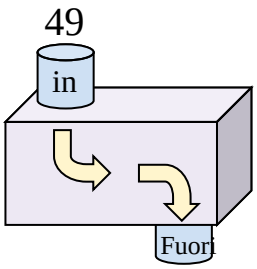

6)

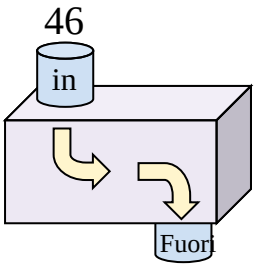

7)

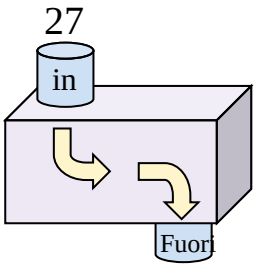

8)

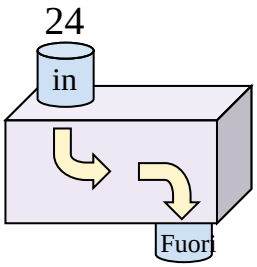

9)

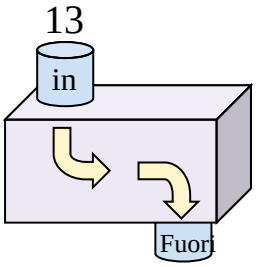

10)

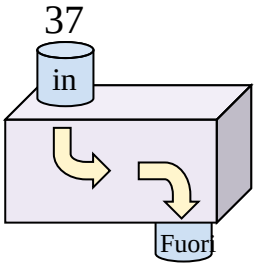

11)

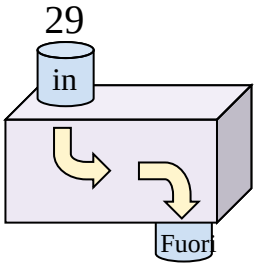

Risposte

Es. Sottrai 14

1. _____
2. _____
3. _____
4. _____
5. _____
6. _____
7. _____
8. _____
9. _____
10. _____
11. _____

1-10	91	82	73	64	55	45	36	27	18	9
11	0									

Determina quale regola viene usata nelle seguenti funzioni.

Es)

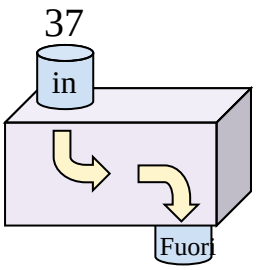

Sottrai 14

1)

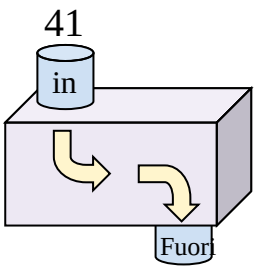

Sottrai 19

2)

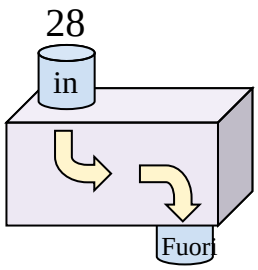

Aggiungi 16

3)

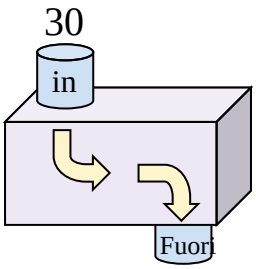

Aggiungi 14

4)

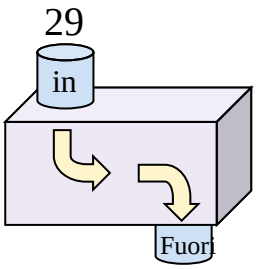

Aggiungi 21

5)

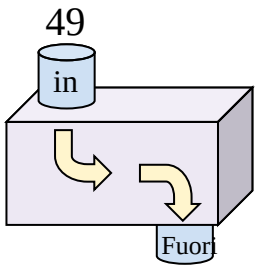

Sottrai 33

6)

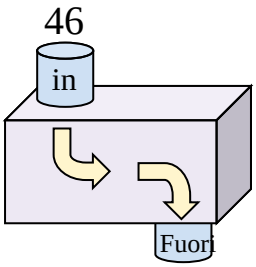

Sottrai 29

7)

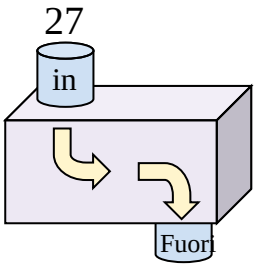

Aggiungi 9

8)

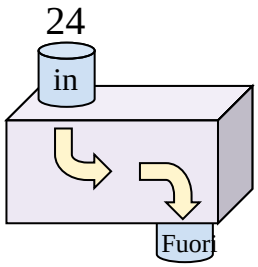

Aggiungi 6

9)

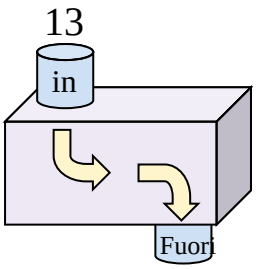

Aggiungi 12

10)

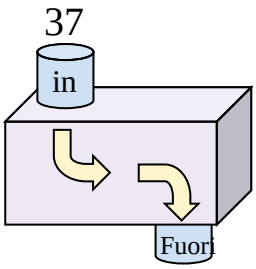

Sottrai 7

11)

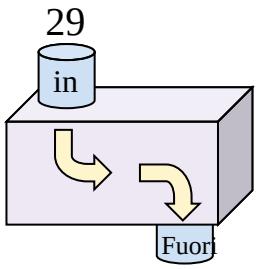

Aggiungi 16

Risposte

Es. **Sottrai 14**

1. **Sottrai 19**
2. **Aggiungi 16**
3. **Aggiungi 14**
4. **Aggiungi 21**
5. **Sottrai 33**
6. **Sottrai 29**
7. **Aggiungi 9**
8. **Aggiungi 6**
9. **Aggiungi 12**
10. **Sottrai 7**
11. **Aggiungi 16**

1-10	91	82	73	64	55	45	36	27	18	9
11	0									