Funzioni (Addizioni e sottrazioni) Nome:

Determina quale regola viene usata nelle seguenti funzioni.

Es)

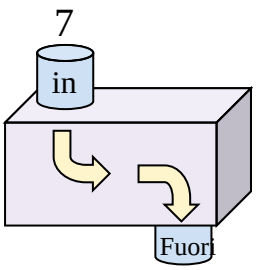

Aggiungi 13

1)

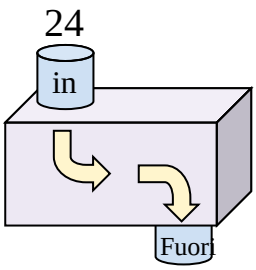

2)

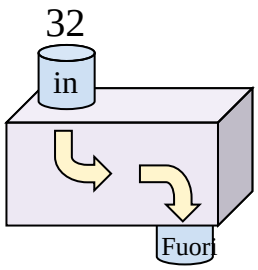

3)

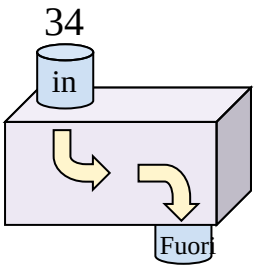

4)

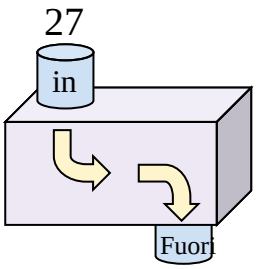

5)

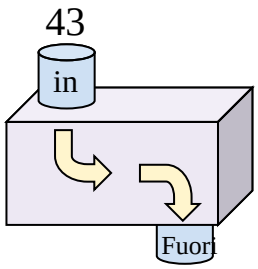

6)

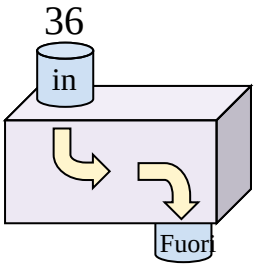

7)

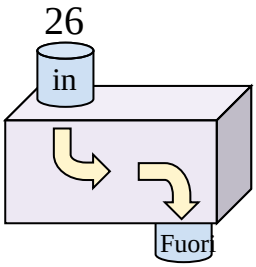

8)

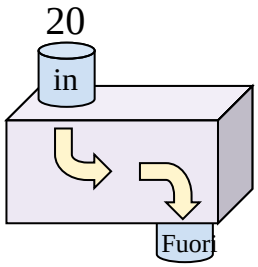

9)

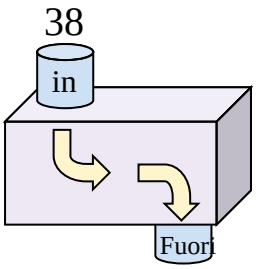

10)

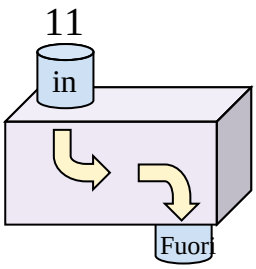

11)

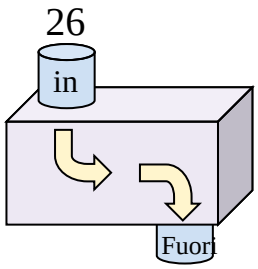

Risposte

Es. Aggiungi 13

1. _____
2. _____
3. _____
4. _____
5. _____
6. _____
7. _____
8. _____
9. _____
10. _____
11. _____

1-10	91	82	73	64	55	45	36	27	18	9
11	0									

Funzioni (Addizioni e sottrazioni) Nome: **Soluzioni**

Determina quale regola viene usata nelle seguenti funzioni.

Es)

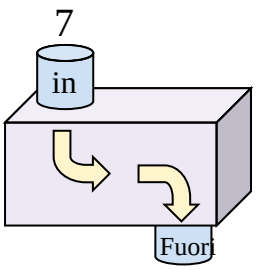

Aggiungi 13

1)

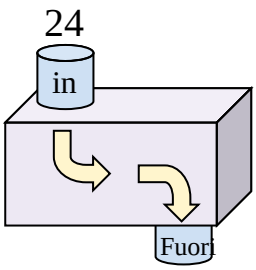

Aggiungi 9

2)

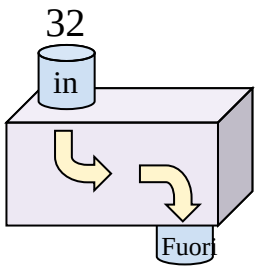

Sottrai 23

3)

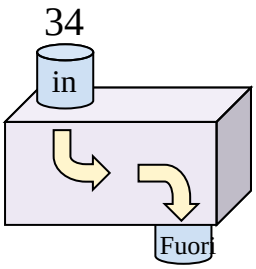

Sottrai 5

4)

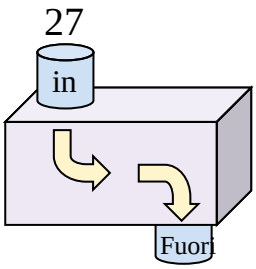

Aggiungi 10

5)

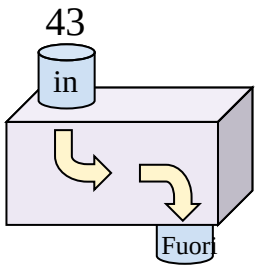

Sottrai 17

6)

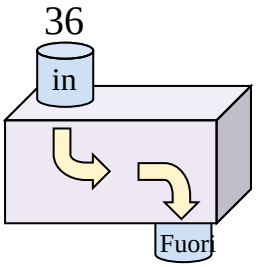

Sottrai 16

7)

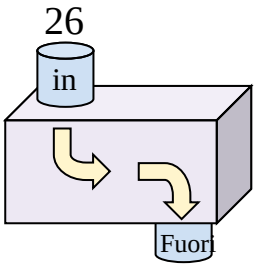

Aggiungi 5

8)

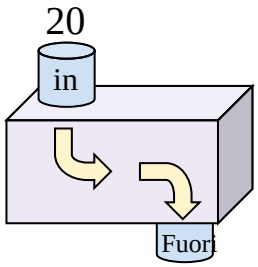

Aggiungi 13

9)

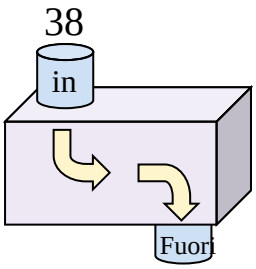

Sottrai 26

10)

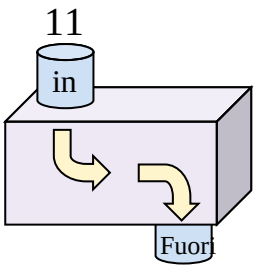

Aggiungi 8

11)

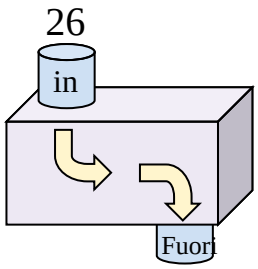

Sottrai 16

Risposte

Es. Aggiungi 13

1. Aggiungi 9
2. Sottrai 23
3. Sottrai 5
4. Aggiungi 10
5. Sottrai 17
6. Sottrai 16
7. Aggiungi 5
8. Aggiungi 13
9. Sottrai 26
10. Aggiungi 8
11. Sottrai 16

1-10	91	82	73	64	55	45	36	27	18	9
11	0									