Funzioni (Addizioni e sottrazioni) Nome:

Determina quale regola viene usata nelle seguenti funzioni.

Es)

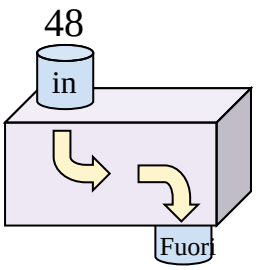

Sottrai 33

1)

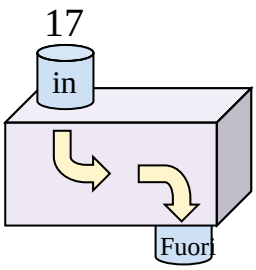

2)

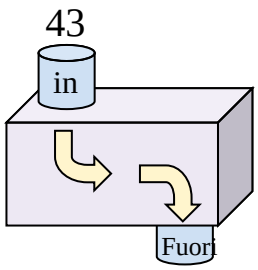

3)

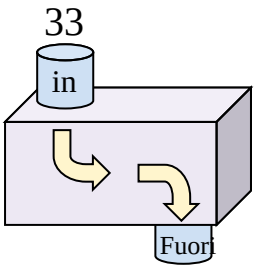

4)

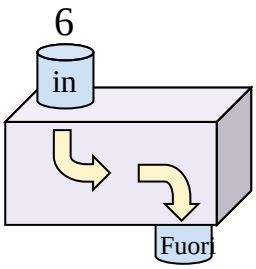

5)

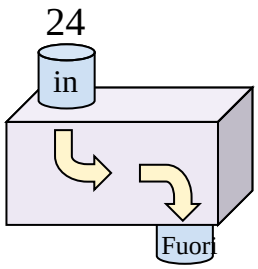

6)

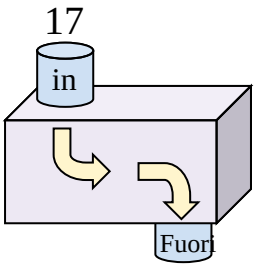

7)

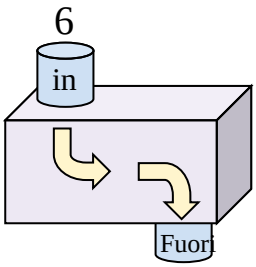

8)

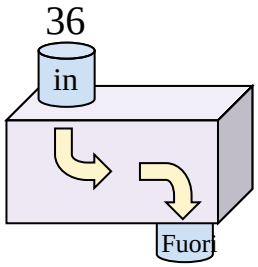

9)

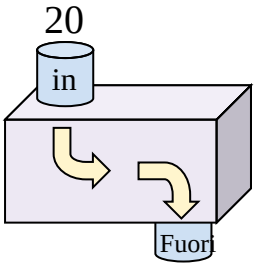

10)

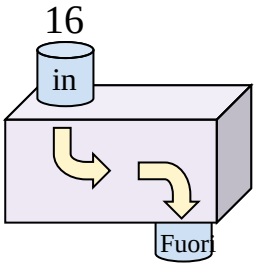

11)

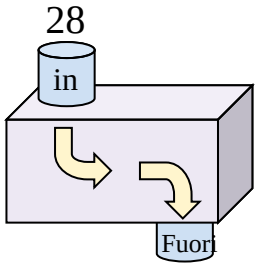

Risposte

Es. Sottrai 33

1. _____
2. _____
3. _____
4. _____
5. _____
6. _____
7. _____
8. _____
9. _____
10. _____
11. _____

1-10	91	82	73	64	55	45	36	27	18	9
11	0									

Determina quale regola viene usata nelle seguenti funzioni.

Es)

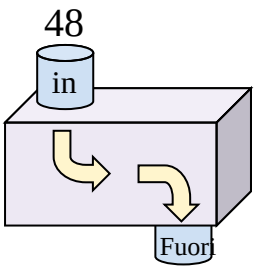

Sottrai 33

1)

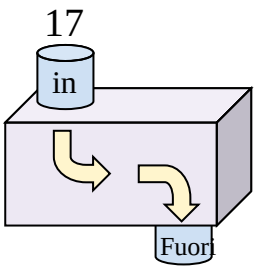

Aggiungi 15

2)

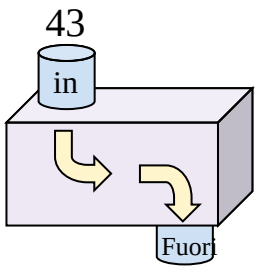

Sottrai 23

3)

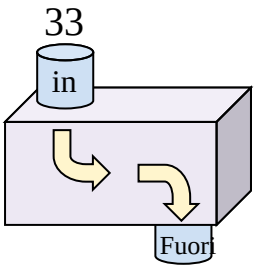

Sottrai 15

4)

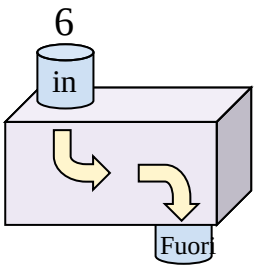

Aggiungi 36

5)

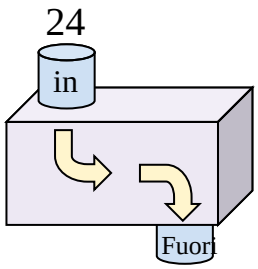

Aggiungi 14

6)

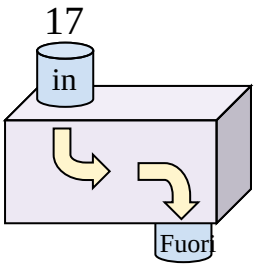

Aggiungi 9

7)

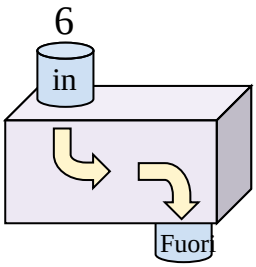

Aggiungi 14

8)

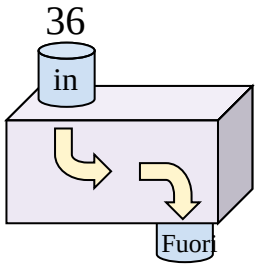

Sottrai 16

9)

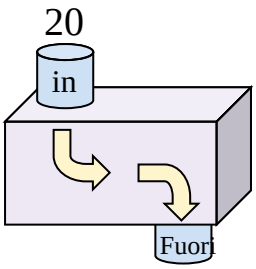

Aggiungi 8

10)

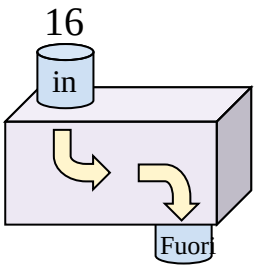

Aggiungi 19

11)

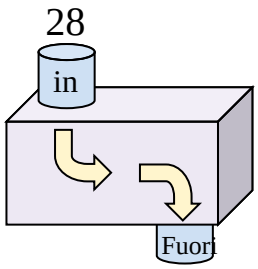

Sottrai 9

Risposte

Es. **Sottrai 33**

1. **Aggiungi 15**
2. **Sottrai 23**
3. **Sottrai 15**
4. **Aggiungi 36**
5. **Aggiungi 14**
6. **Aggiungi 9**
7. **Aggiungi 14**
8. **Sottrai 16**
9. **Aggiungi 8**
10. **Aggiungi 19**
11. **Sottrai 9**

1-10	91	82	73	64	55	45	36	27	18	9
11	0									