Determina quale regola viene usata nelle seguenti funzioni.

Es)

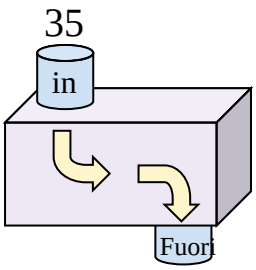

Sottrai 13

1)

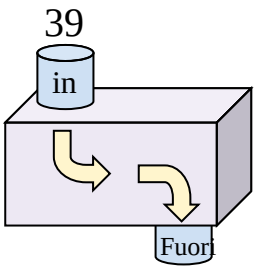

2)

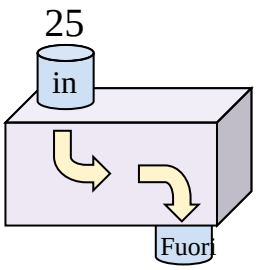

3)

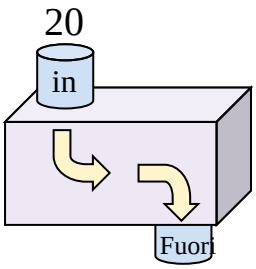

4)

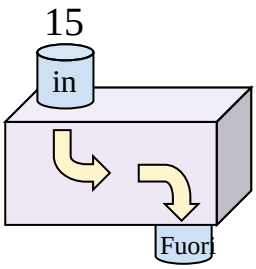

5)

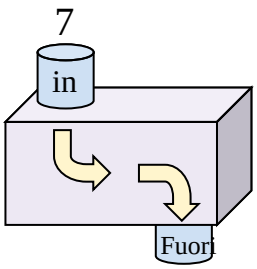

6)

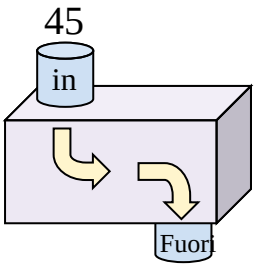

7)

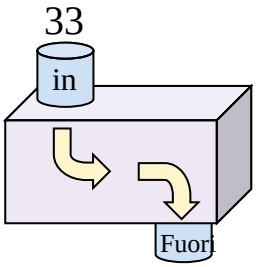

8)

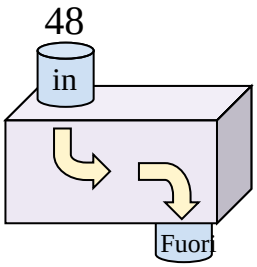

9)

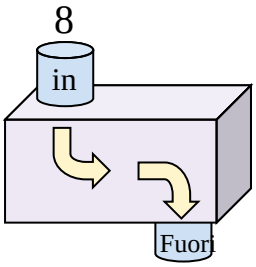

10)

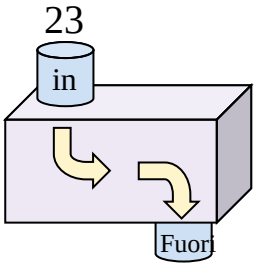

11)

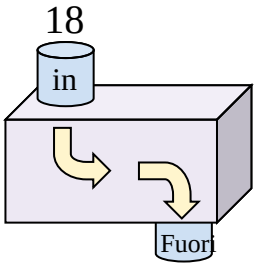

Risposte

Es. Sottrai 13

1. _____
2. _____
3. _____
4. _____
5. _____
6. _____
7. _____
8. _____
9. _____
10. _____
11. _____

1-10	91	82	73	64	55	45	36	27	18	9
11	0									

Funzioni (Addizioni e sottrazioni) Nome: **Soluzioni**

Determina quale regola viene usata nelle seguenti funzioni.

Es)

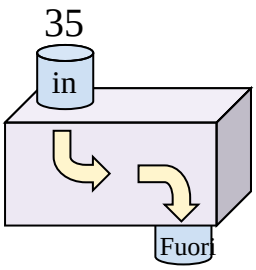

Sottrai 13

1)

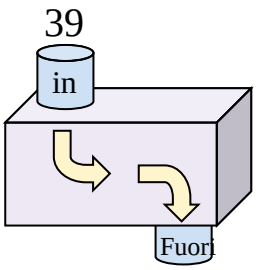

Sottrai 31

2)

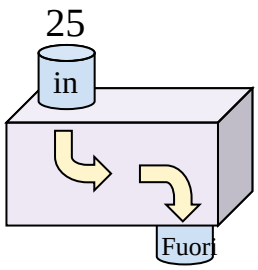

Aggiungi 10

3)

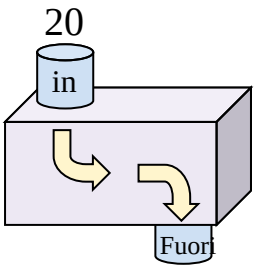

Aggiungi 8

4)

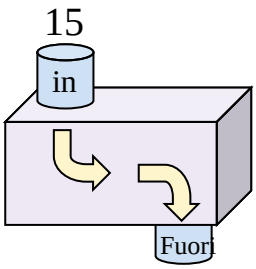

Aggiungi 34

5)

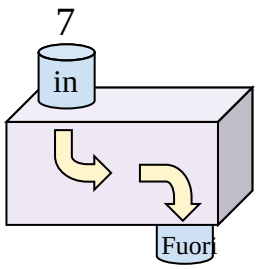

Aggiungi 21

6)

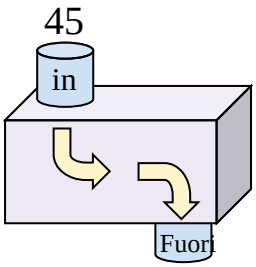

Sottrai 21

7)

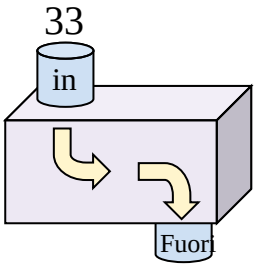

Sottrai 13

8)

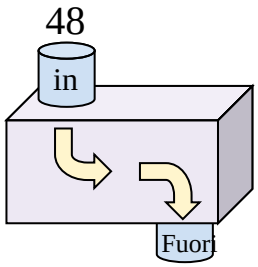

Sottrai 28

9)

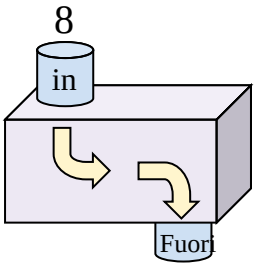

Aggiungi 38

10)

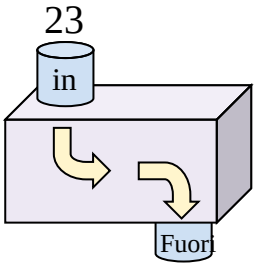

Aggiungi 12

11)

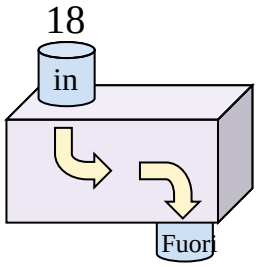

Aggiungi 6

Risposte

Es. **Sottrai 13**

1. **Sottrai 31**
2. **Aggiungi 10**
3. **Aggiungi 8**
4. **Aggiungi 34**
5. **Aggiungi 21**
6. **Sottrai 21**
7. **Sottrai 13**
8. **Sottrai 28**
9. **Aggiungi 38**
10. **Aggiungi 12**
11. **Aggiungi 6**

1-10	91	82	73	64	55	45	36	27	18	9
11	0									