Funzioni (Addizioni e sottrazioni) Nome:

Determina quale regola viene usata nelle seguenti funzioni.

Es)

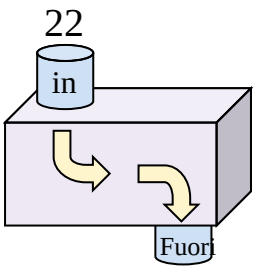

Aggiungi 20

1)

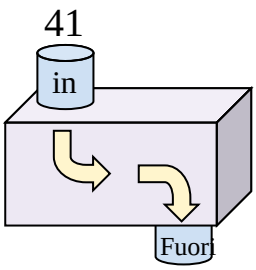

2)

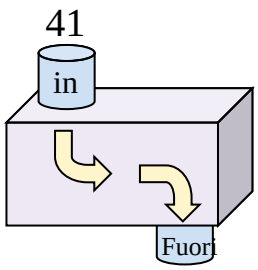

3)

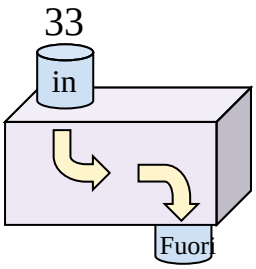

4)

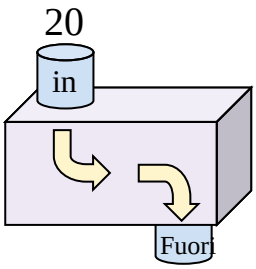

5)

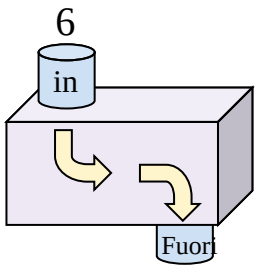

6)

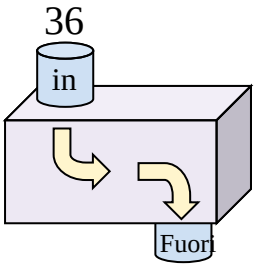

7)

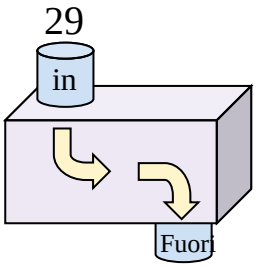

8)

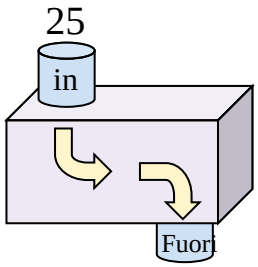

9)

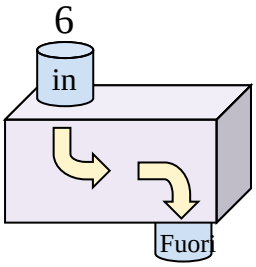

10)

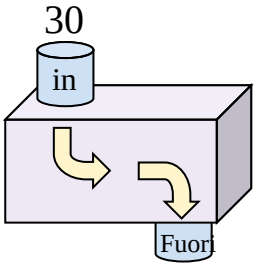

11)

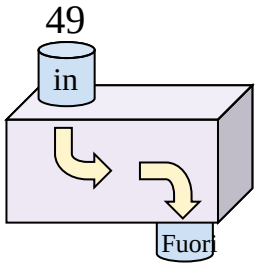

Risposte

Es. Aggiungi 20

1. _____
2. _____
3. _____
4. _____
5. _____
6. _____
7. _____
8. _____
9. _____
10. _____
11. _____

1-10	91	82	73	64	55	45	36	27	18	9
11	0									

Determina quale regola viene usata nelle seguenti funzioni.

Es)

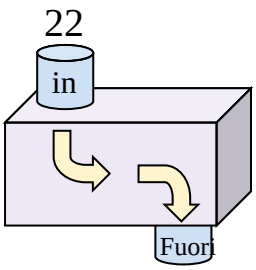

Aggiungi 20

1)

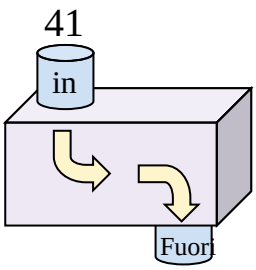

Sottrai 18

2)

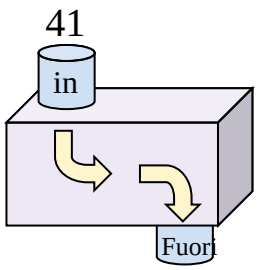

Sottrai 33

3)

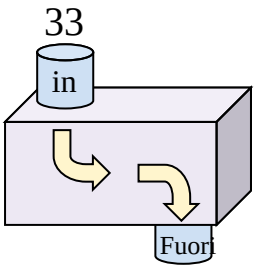

Sottrai 16

4)

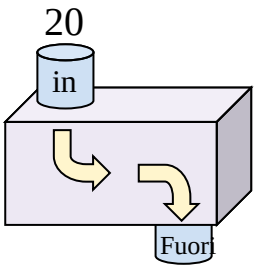

Sottrai 8

5)

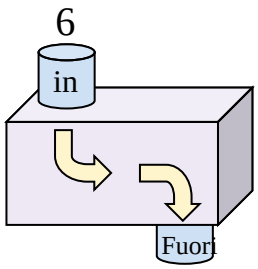

Aggiungi 37

6)

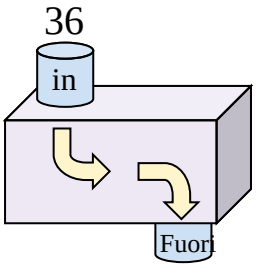

Sottrai 11

7)

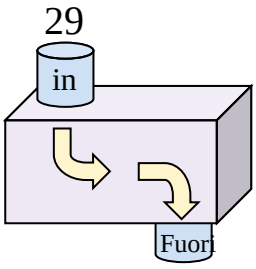

Aggiungi 15

8)

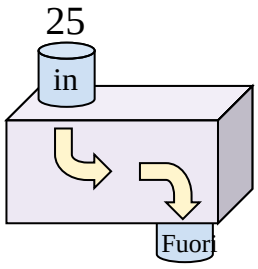

Aggiungi 25

9)

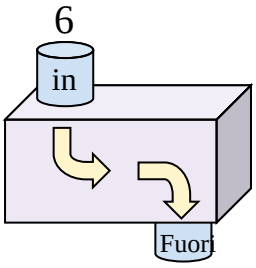

Aggiungi 10

10)

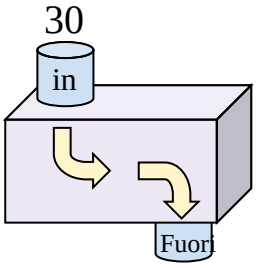

Sottrai 16

11)

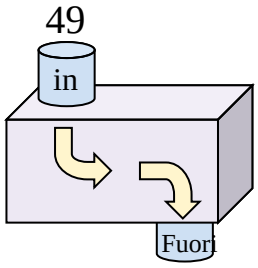

Sottrai 29

Risposte

Es. **Aggiungi 20**

1. **Sottrai 18**
2. **Sottrai 33**
3. **Sottrai 16**
4. **Sottrai 8**
5. **Aggiungi 37**
6. **Sottrai 11**
7. **Aggiungi 15**
8. **Aggiungi 25**
9. **Aggiungi 10**
10. **Sottrai 16**
11. **Sottrai 29**

1-10	91	82	73	64	55	45	36	27	18	9
11	0									