Funzioni (Addizioni e sottrazioni) Nome:

Determina quale regola viene usata nelle seguenti funzioni.

Es)

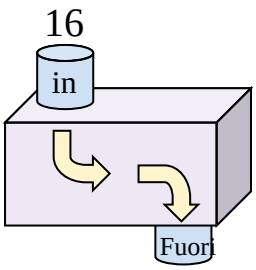

Aggiungi 12

1)

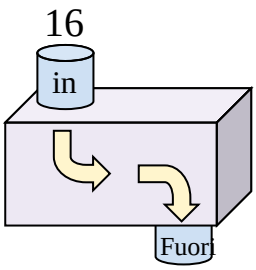

2)

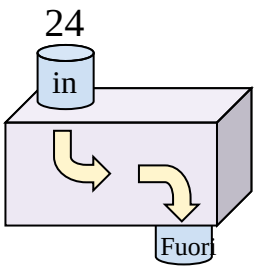

3)

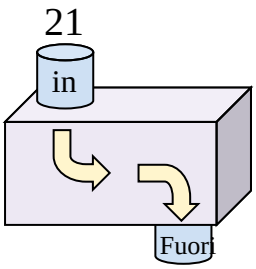

4)

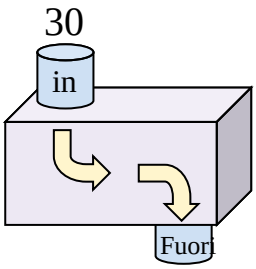

5)

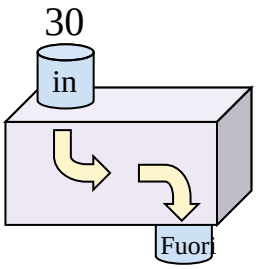

6)

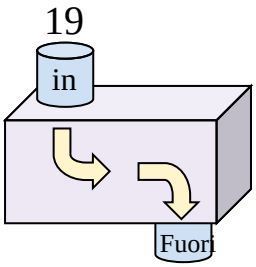

7)

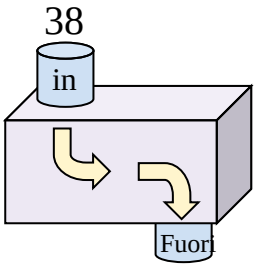

8)

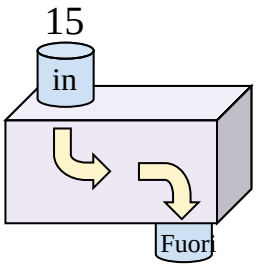

9)

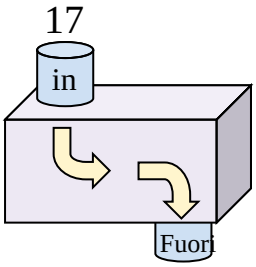

10)

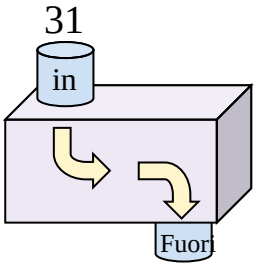

11)

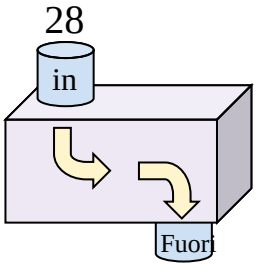

Risposte

Es. Aggiungi 12

1. _____
2. _____
3. _____
4. _____
5. _____
6. _____
7. _____
8. _____
9. _____
10. _____
11. _____

1-10	91	82	73	64	55	45	36	27	18	9
11	0									

Funzioni (Addizioni e sottrazioni) Nome: **Soluzioni**

Determina quale regola viene usata nelle seguenti funzioni.

Es)

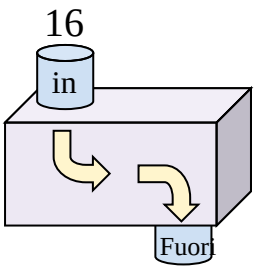

Aggiungi 12

1)

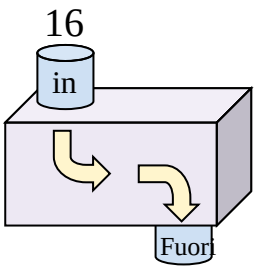

Aggiungi 6

2)

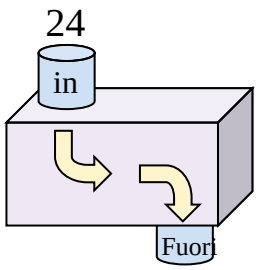

Sottrai 17

3)

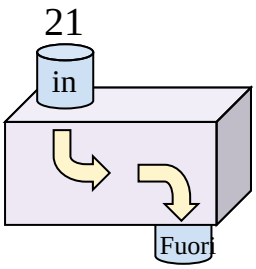

Aggiungi 14

4)

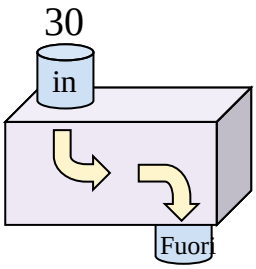

Sottrai 17

5)

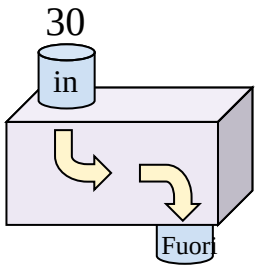

Sottrai 7

6)

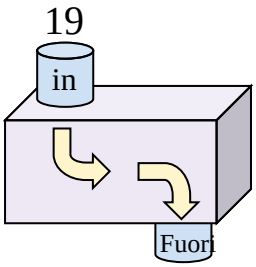

Aggiungi 13

7)

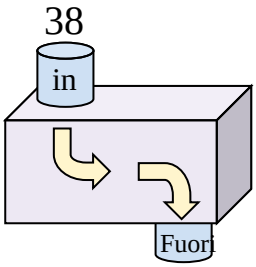

Sottrai 17

8)

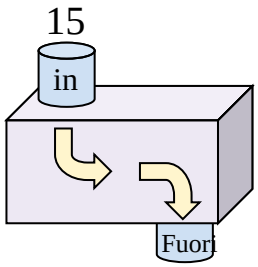

Aggiungi 8

9)

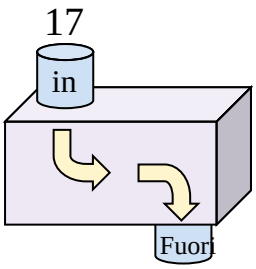

Aggiungi 15

10)

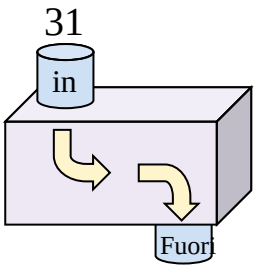

Sottrai 24

11)

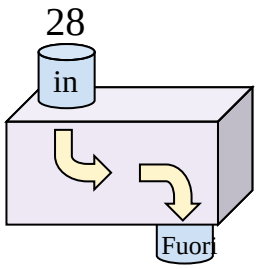

Sottrai 18

Risposte

Es. **Aggiungi 12**

1. **Aggiungi 6**
2. **Sottrai 17**
3. **Aggiungi 14**
4. **Sottrai 17**
5. **Sottrai 7**
6. **Aggiungi 13**
7. **Sottrai 17**
8. **Aggiungi 8**
9. **Aggiungi 15**
10. **Sottrai 24**
11. **Sottrai 18**

1-10	91	82	73	64	55	45	36	27	18	9
11	0									