Funzioni (Addizioni e sottrazioni) Nome:

Determina quale regola viene usata nelle seguenti funzioni.

1) 7 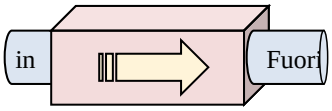

15

A. Sottrai 10
B. Aggiungi 8
C. Aggiungi 10
D. Aggiungi 5

2) 37 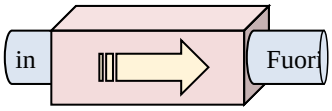

29

A. Aggiungi 7
B. Sottrai 8
C. Sottrai 10
D. Sottrai 13

3) 35 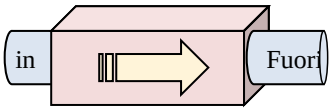

27

A. Aggiungi 8
B. Sottrai 8
C. Aggiungi 13
D. Sottrai 9

4) 37 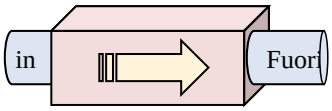

30

A. Aggiungi 11
B. Sottrai 3
C. Aggiungi 8
D. Sottrai 7

5) 20 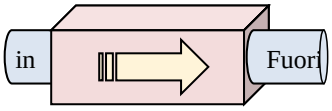

43

A. Sottrai 21
B. Aggiungi 23
C. Aggiungi 25
D. Aggiungi 21

6) 28 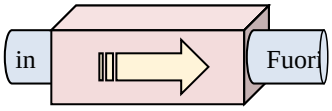

15

A. Sottrai 11
B. Aggiungi 13
C. Aggiungi 17
D. Sottrai 13

7) 50 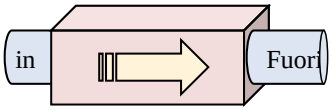

28

A. Sottrai 19
B. Aggiungi 25
C. Sottrai 22
D. Sottrai 26

8) 28 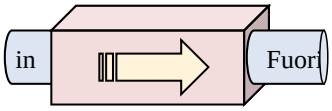

23

A. Sottrai 5
B. Sottrai 3
C. Aggiungi 4
D. Aggiungi 7

9) 27 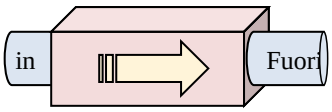

34

A. Aggiungi 7
B. Sottrai 3
C. Aggiungi 4
D. Aggiungi 9

10) 14 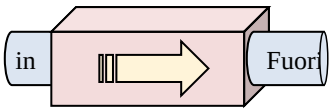

30

A. Aggiungi 16
B. Aggiungi 13
C. Sottrai 15
D. Sottrai 13

Risposte

1. _____
2. _____
3. _____
4. _____
5. _____
6. _____
7. _____
8. _____
9. _____
10. _____

1-10	90	80	70	60	50	40	30	20	10	0

Funzioni (Addizioni e sottrazioni) Nome: **Soluzioni**

Determina quale regola viene usata nelle seguenti funzioni.

1) 7 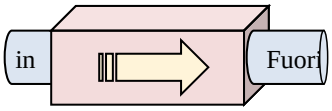

15

A. Sottrai 10
B. Aggiungi 8
C. Aggiungi 10
D. Aggiungi 5

2) 37 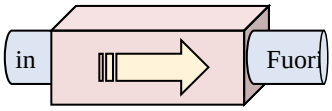

29

A. Aggiungi 7
B. Sottrai 8
C. Sottrai 10
D. Sottrai 13

3) 35 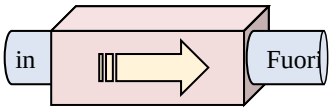

27

A. Aggiungi 8
B. Sottrai 8
C. Aggiungi 13
D. Sottrai 9

4) 37 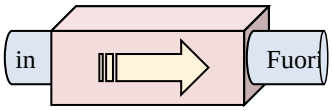

30

A. Aggiungi 11
B. Sottrai 3
C. Aggiungi 8
D. Sottrai 7

5) 20 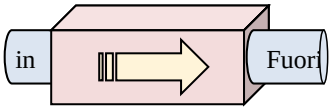

43

A. Sottrai 21
B. Aggiungi 23
C. Aggiungi 25
D. Aggiungi 21

6) 28 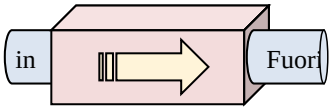

15

A. Sottrai 11
B. Aggiungi 13
C. Aggiungi 17
D. Sottrai 13

7) 50 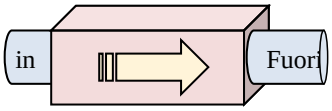

28

A. Sottrai 19
B. Aggiungi 25
C. Sottrai 22
D. Sottrai 26

8) 28 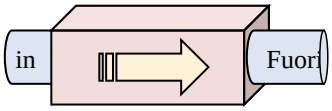

23

A. Sottrai 5
B. Sottrai 3
C. Aggiungi 4
D. Aggiungi 7

9) 27 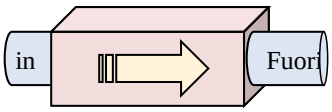

34

A. Aggiungi 7
B. Sottrai 3
C. Aggiungi 4
D. Aggiungi 9

10) 14 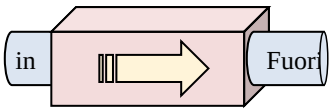

30

A. Aggiungi 16
B. Aggiungi 13
C. Sottrai 15
D. Sottrai 13

Risposte

1. B
2. B
3. B
4. D
5. B
6. D
7. C
8. A
9. A
10. A

1-10	90	80	70	60	50	40	30	20	10	0