Confronta due misure

Nome:

Misura la lunghezza di ogni barra sia in centimetri che in pollici.

Es)

1)

2)

3)

4)

5)

6)

7)

8)

9)

Risposte

Es.	$5\ ^1/_2$	13 - 14
1.		
2.		
3.		
4.		
5.		
6.		
7.		
8.		
9.		

1-9	89	78	67	56	44	33	22	11	0

Confronta due misure

Nome: **Soluzioni**

Misura la lunghezza di ogni barra sia in centimetri che in pollici.

Es)



1)

2)



3)

4)

5)

6)



7)

8)

9)

Risposte

Es.	$5\frac{1}{2}$	13 - 14
1.	$3\frac{1}{2}$	8 - 9
2.	4	10 - 11
3.	5	12 - 13
4.	1	2 - 3
5.	3	7 - 8
6.	$0\frac{1}{2}$	1 - 2
7.	$1\frac{1}{2}$	3 - 4
8.	2	5 - 6
9.	$4\frac{1}{2}$	11 - 12

1-9	89	78	67	56	44	33	22	11	0