Confronta la lunghezza degli oggetti

Nome:

Metti in ordine gli oggetti dal più piccolo al più grande.

1)

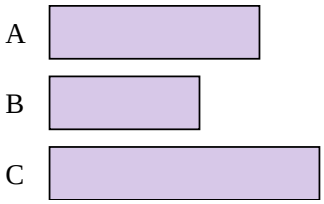

2)

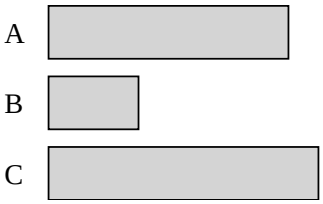

3)

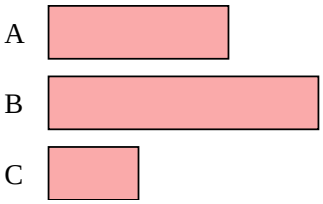

4)

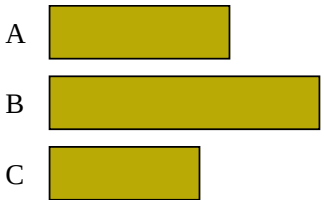

5)

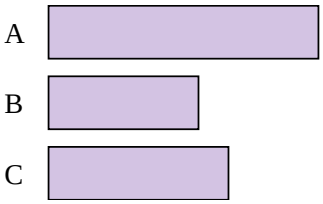

6)

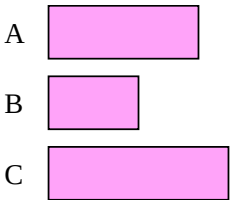

7)

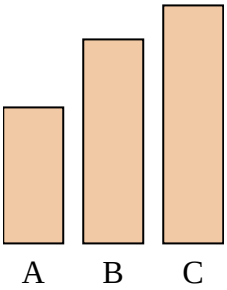

8)

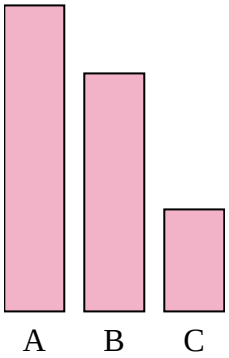

9)

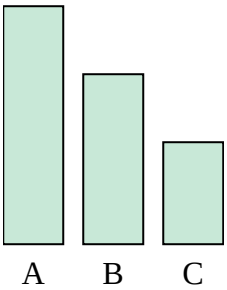

10)

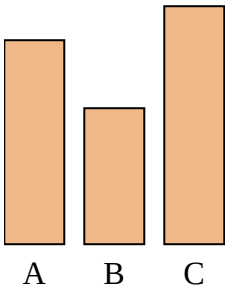

11)

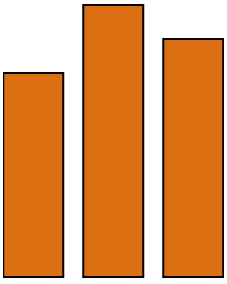

12)

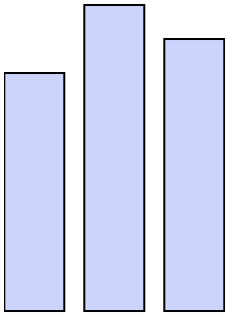

Risposte

1. _____
2. _____
3. _____
4. _____
5. _____
6. _____
7. _____
8. _____
9. _____
10. _____
11. _____
12. _____

1-10	90	80	70	60	50	40	30	20	10	0

Confronta la lunghezza degli oggetti

Nome: **Soluzioni**

Metti in ordine gli oggetti dal più piccolo al più grande.

1)

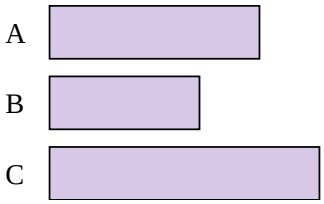

2)

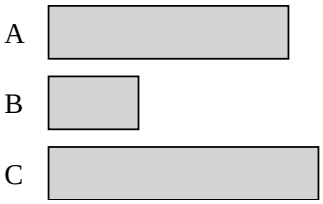

3)

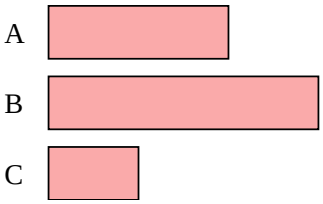

4)

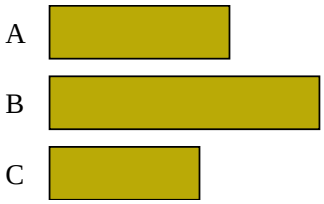

5)

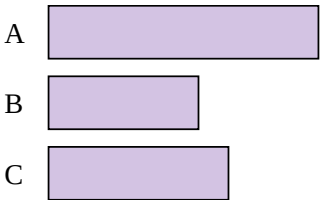

6)

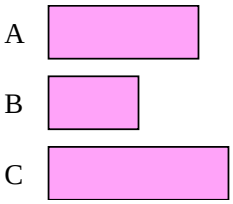

7)

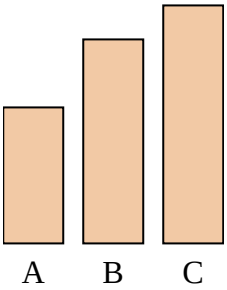

8)

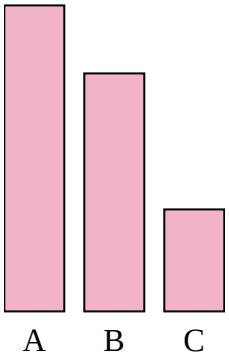

9)

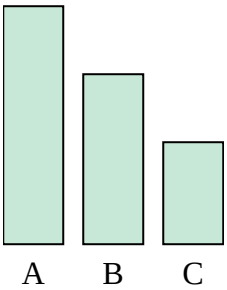

10)

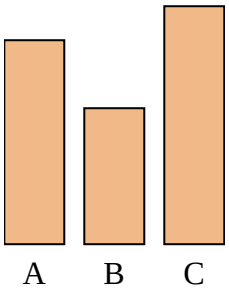

11)

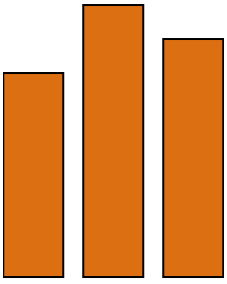

12)

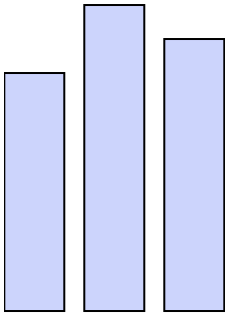

Risposte

1. **B, A, C**
2. **B, A, C**
3. **C, A, B**
4. **C, A, B**
5. **B, C, A**
6. **B, A, C**
7. **A, B, C**
8. **C, B, A**
9. **C, B, A**
10. **B, A, C**
11. **A, C, B**
12. **A, C, B**

1-10	90	80	70	60	50	40	30	20	10	0