Determinazione del valore decimale con i blocchi

Nome:

Usa il blocco a sinistra per trovare il valore dell'insieme di blocchi a destra.

1) 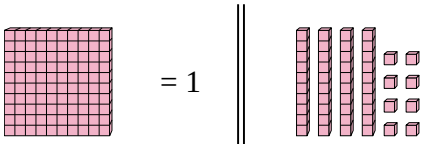 = 1

2) 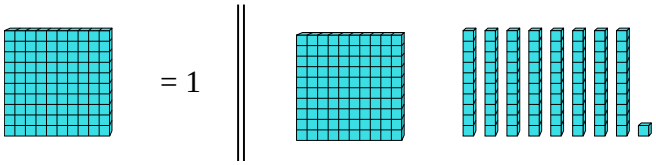 = 1

3) 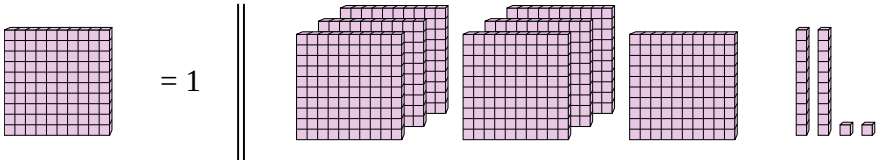 = 1

4) 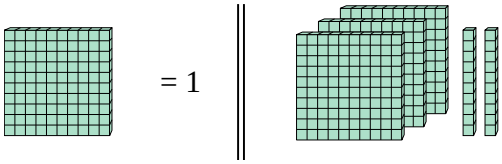 = 1

5) 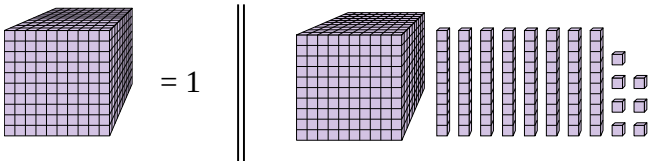 = 1

6) 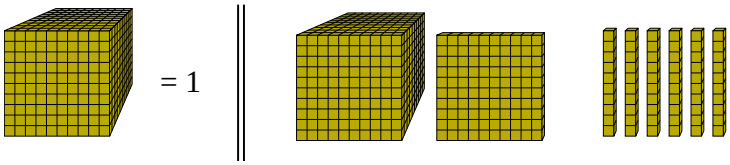 = 1

7) 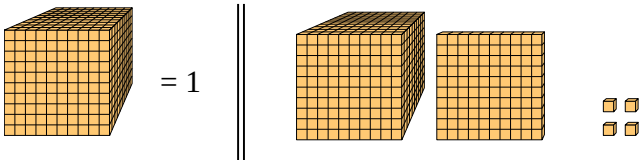 = 1

8) 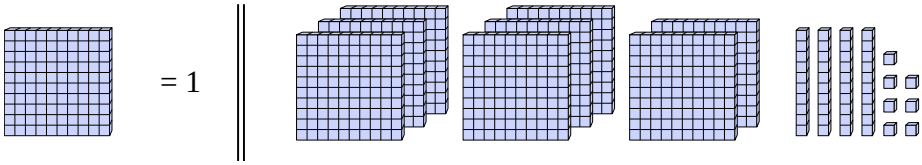 = 1

9) 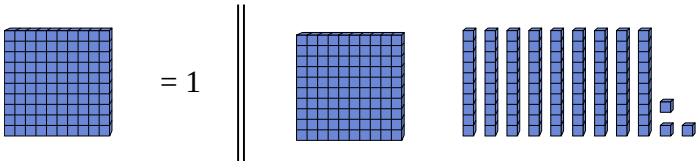 = 1

10) 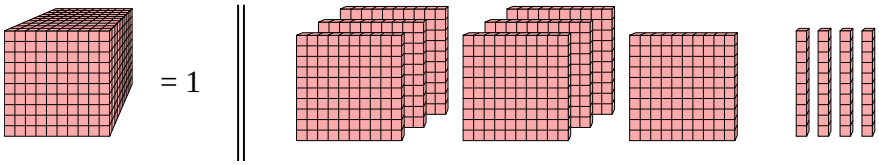 = 1

Risposte

1. _____
2. _____
3. _____
4. _____
5. _____
6. _____
7. _____
8. _____
9. _____
10. _____

1-10	90	80	70	60	50	40	30	20	10	0

Determinazione del valore decimale con i blocchi Nome: **Soluzioni**

Usa il blocco a sinistra per trovare il valore dell'insieme di blocchi a destra.

1) 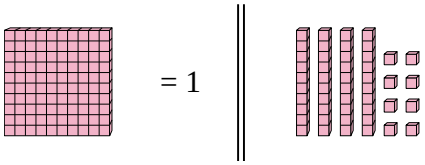 = 1

2) 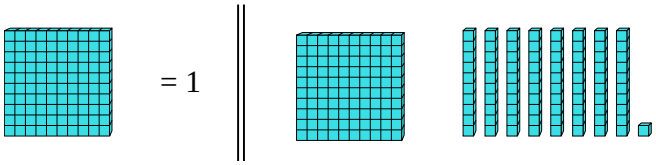 = 1

3) 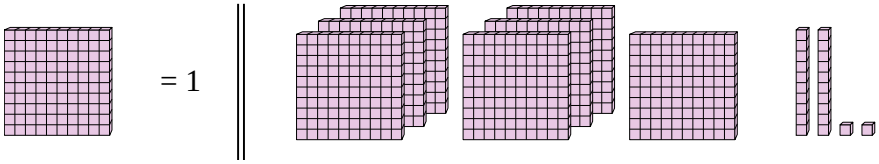 = 1

4) 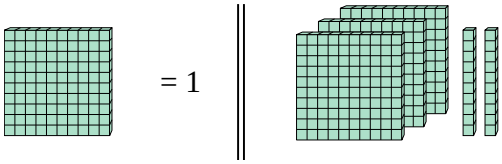 = 1

5) 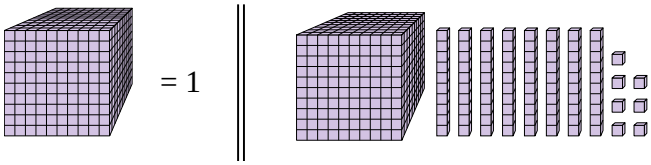 = 1

6) 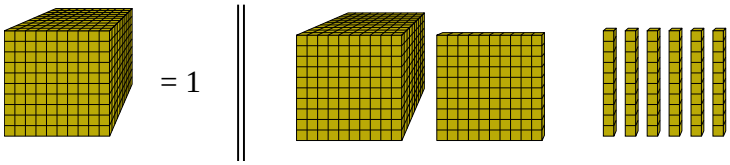 = 1

7) 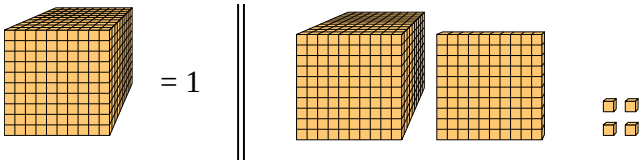 = 1

8) 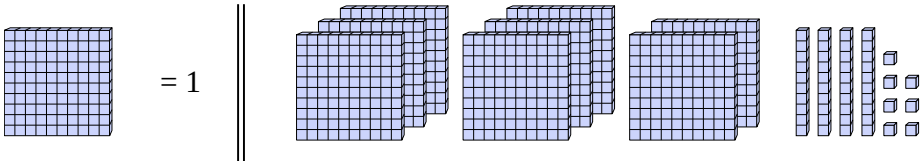 = 1

9) 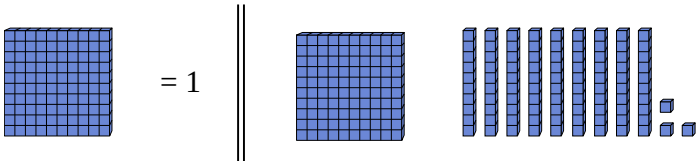 = 1

10) 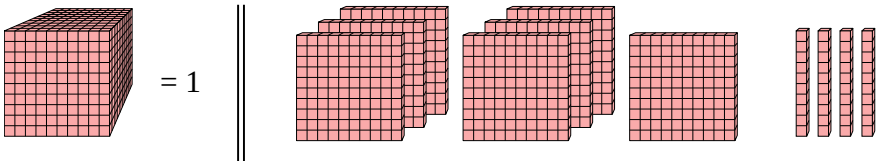 = 1

Risposte

1. **0,48**
2. **1,81**
3. **7,22**
4. **3,2**
5. **1,087**
6. **1,16**
7. **1,104**
8. **8,47**
9. **1,93**
10. **0,74**

1-10	90	80	70	60	50	40	30	20	10	0

Determinazione del valore decimale con i blocchi Nome:

Usa il blocco a sinistra per trovare il valore dell'insieme di blocchi a destra.

1) 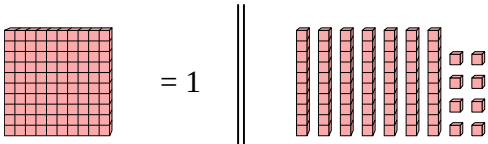 = 1

2) 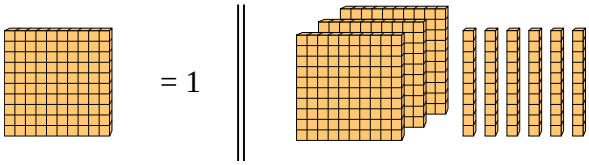 = 1

3) 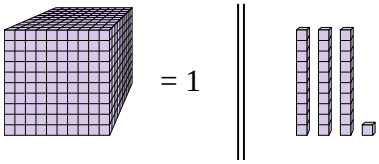 = 1

4) 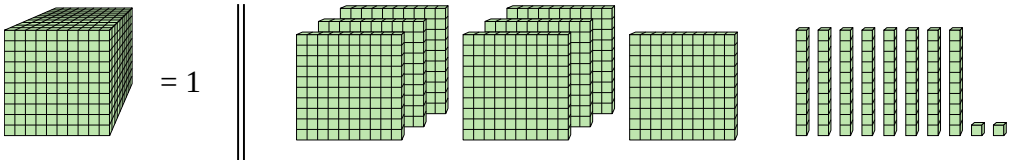 = 1

5) 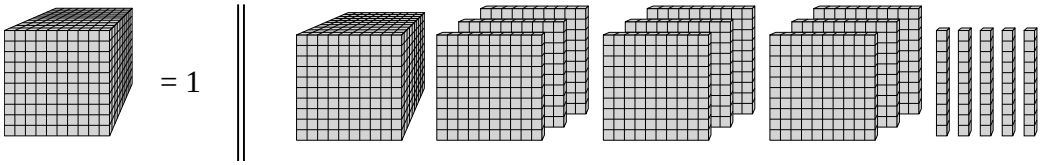 = 1

6) 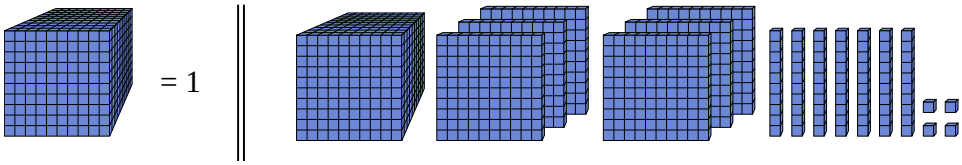 = 1

7) 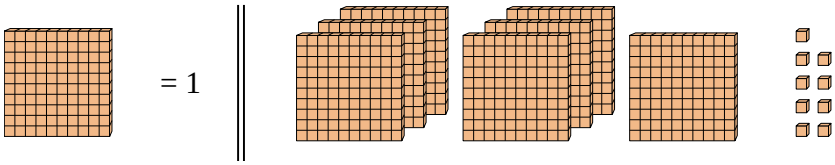 = 1

8) 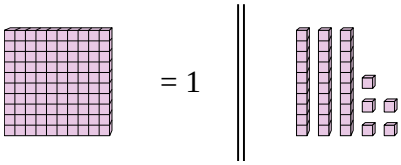 = 1

9) 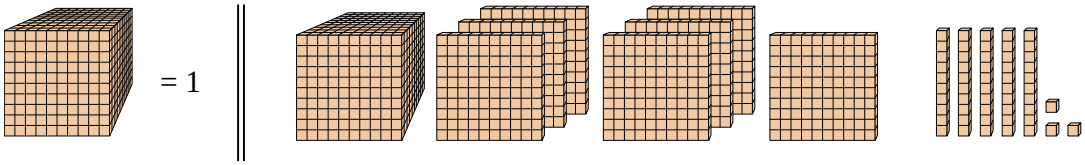 = 1

10) 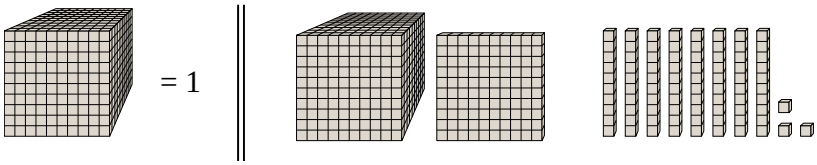 = 1

Risposte

1. _____
2. _____
3. _____
4. _____
5. _____
6. _____
7. _____
8. _____
9. _____
10. _____

1-10	90	80	70	60	50	40	30	20	10	0

Determinazione del valore decimale con i blocchi Nome: **Soluzioni**

Usa il blocco a sinistra per trovare il valore dell'insieme di blocchi a destra.

1) 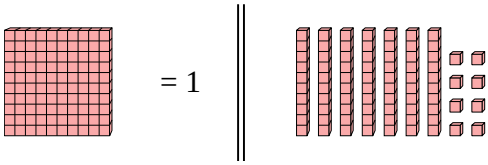

2) 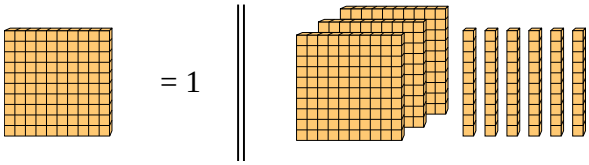

3) 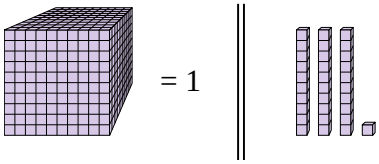

4) 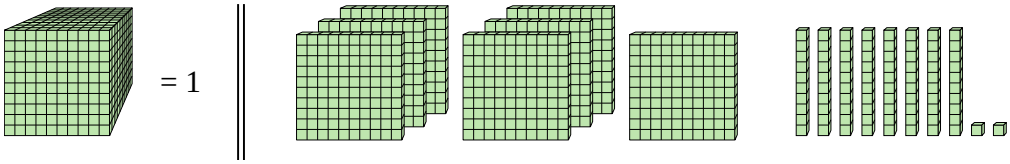

5) 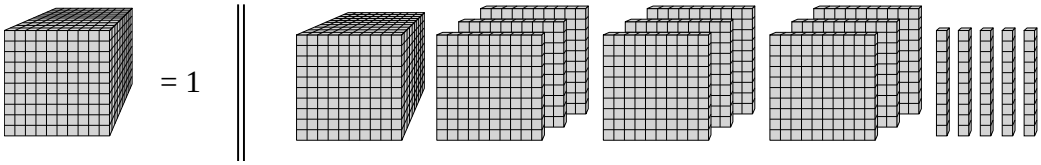

6) 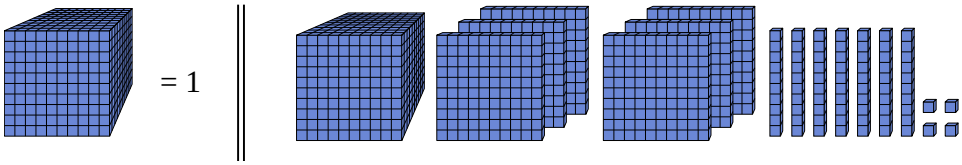

7) 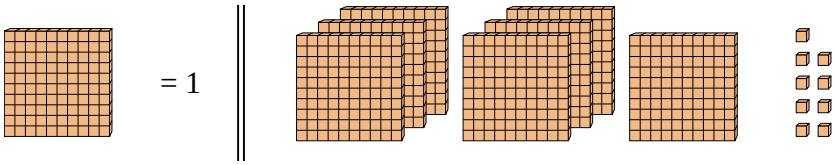

8) 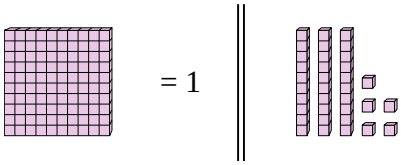

9) 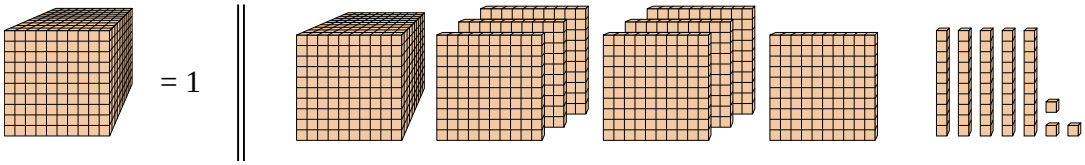

10) 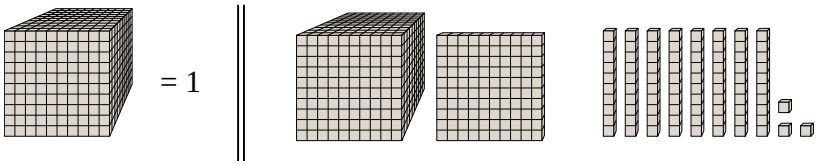

Risposte

1. **0,78**
2. **3,6**
3. **0,031**
4. **0,782**
5. **1,95**
6. **1,674**
7. **7,09**
8. **0,35**
9. **1,753**
10. **1,183**

1-10	90	80	70	60	50	40	30	20	10	0

Determinazione del valore decimale con i blocchi Nome:

Usa il blocco a sinistra per trovare il valore dell'insieme di blocchi a destra.

1) 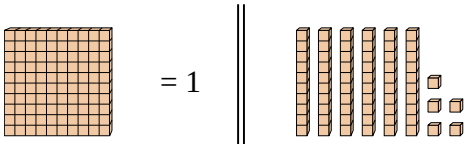

2) 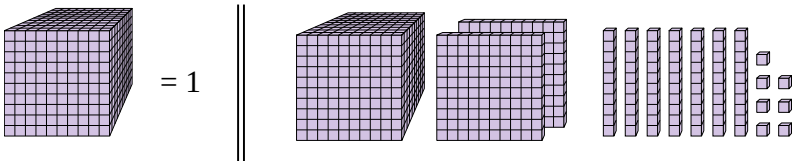

3) 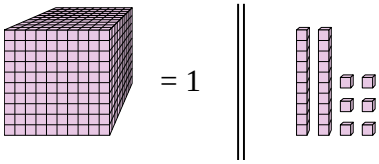

4) 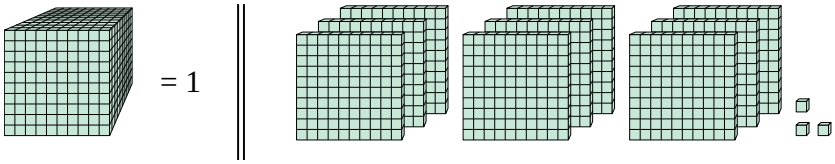

5) 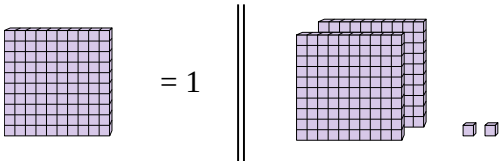

6) 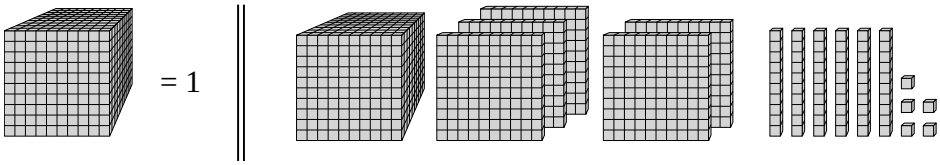

7) 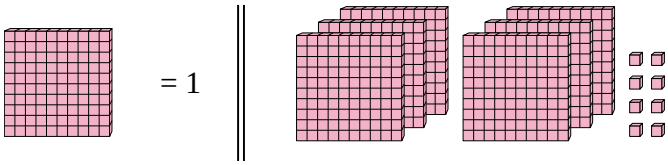

8) 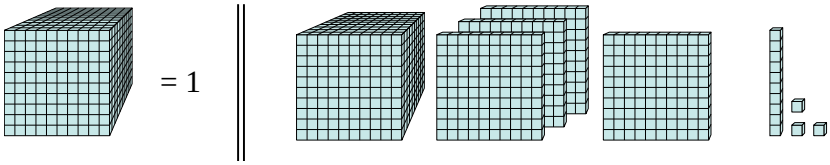

9) 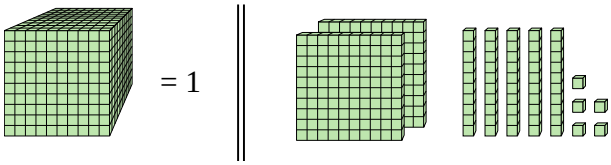

10) 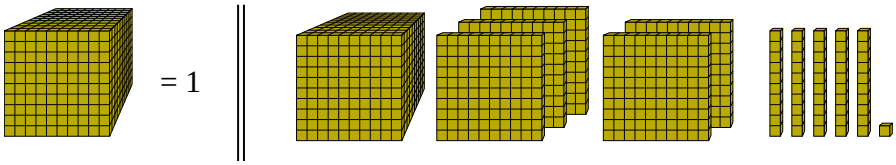

Risposte

1. _____
2. _____
3. _____
4. _____
5. _____
6. _____
7. _____
8. _____
9. _____
10. _____

1-10	90	80	70	60	50	40	30	20	10	0

Determinazione del valore decimale con i blocchi Nome: **Soluzioni**

Usa il blocco a sinistra per trovare il valore dell'insieme di blocchi a destra.

1) 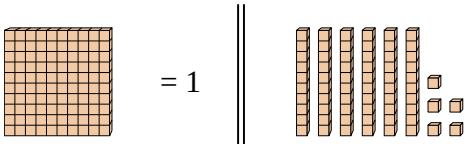

2) 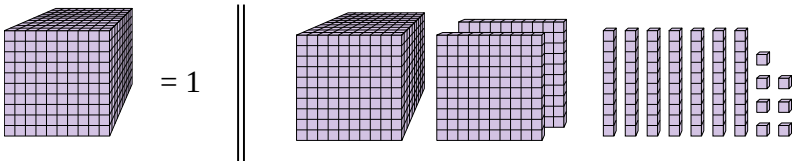

3) 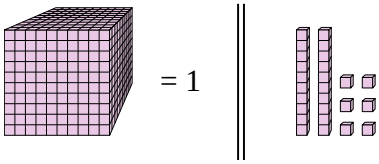

4) 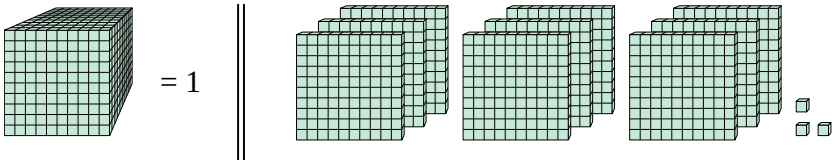

5) 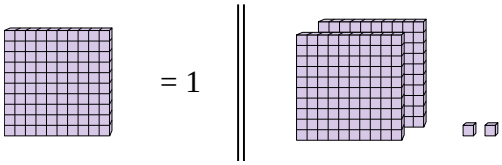

6) 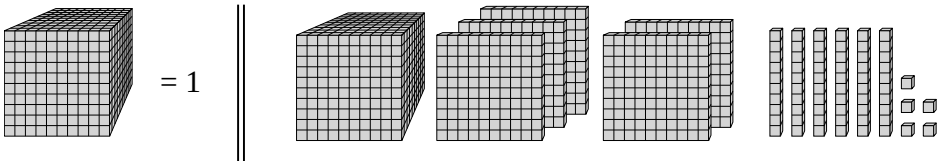

7) 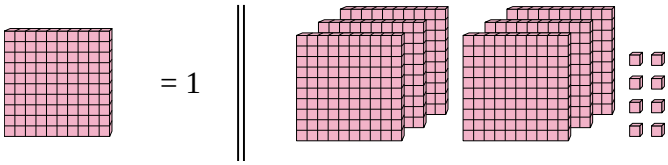

8) 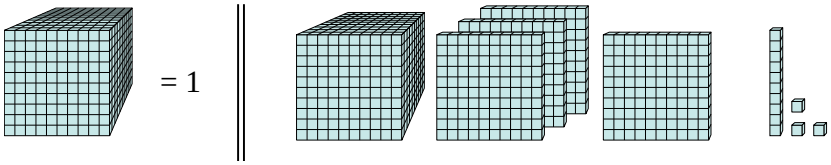

9) 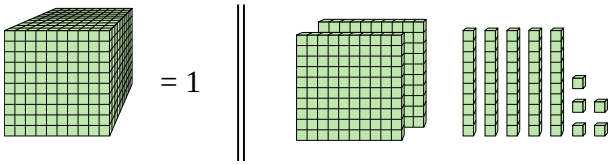

10) 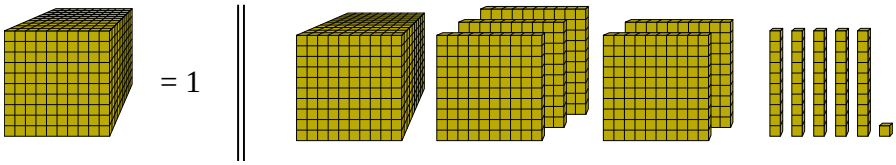

Risposte

1. **0,65**
2. **1,277**
3. **0,026**
4. **0,903**
5. **2,02**
6. **1,565**
7. **6,08**
8. **1,413**
9. **0,255**
10. **1,551**

1-10	90	80	70	60	50	40	30	20	10	0

Determinazione del valore decimale con i blocchi Nome:

Usa il blocco a sinistra per trovare il valore dell'insieme di blocchi a destra.

1)  = 1 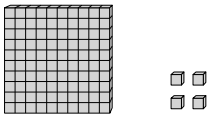

2)  = 1 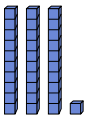

3) 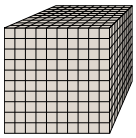 = 1 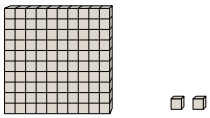

4) 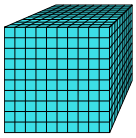 = 1 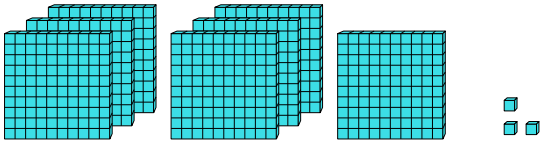

5) 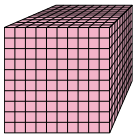 = 1 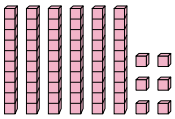

6) 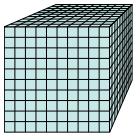 = 1 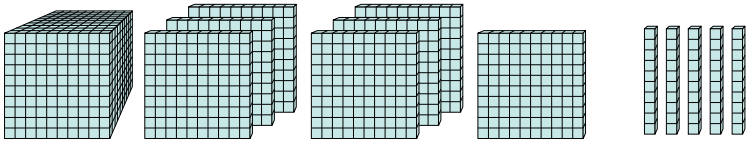

7) 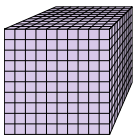 = 1 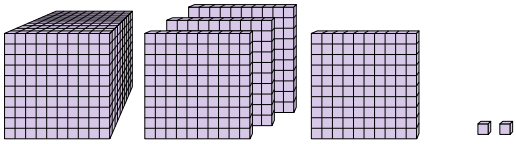

8)  = 1 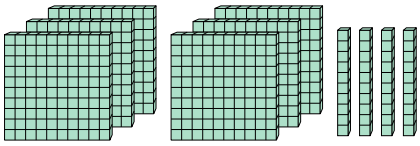

9) 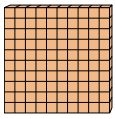 = 1 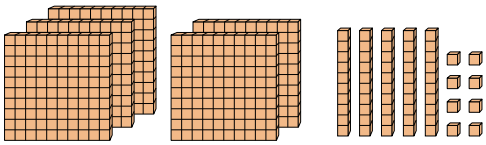

10) 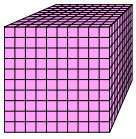 = 1 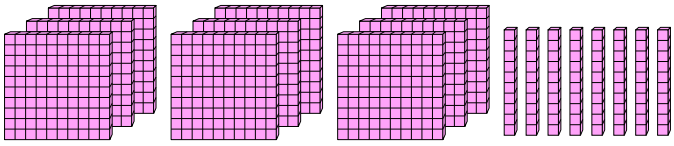

Risposte

1. _____
2. _____
3. _____
4. _____
5. _____
6. _____
7. _____
8. _____
9. _____
10. _____

1-10	90	80	70	60	50	40	30	20	10	0

Determinazione del valore decimale con i blocchi Nome: **Soluzioni**

Usa il blocco a sinistra per trovare il valore dell'insieme di blocchi a destra.

1)  = 1 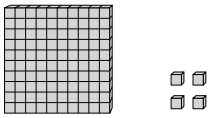

2)  = 1 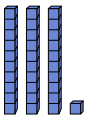

3) 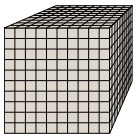 = 1 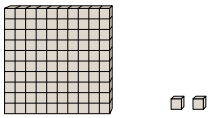

4) 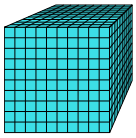 = 1 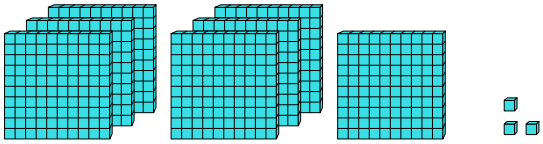

5) 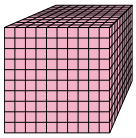 = 1 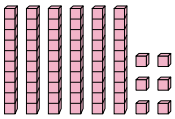

6) 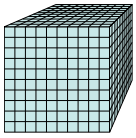 = 1 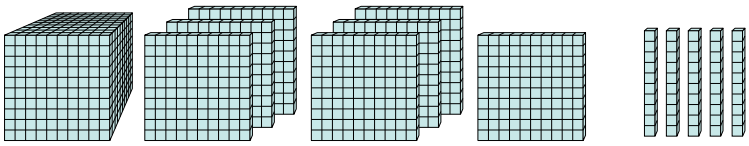

7) 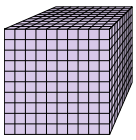 = 1 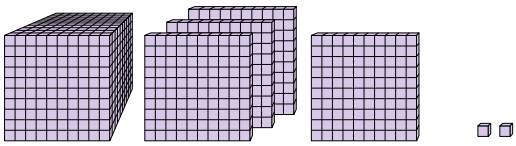

8)  = 1 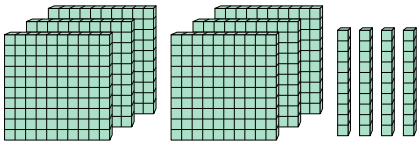

9) 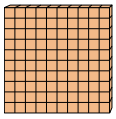 = 1 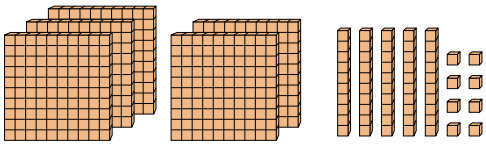

10) 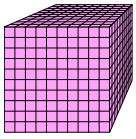 = 1 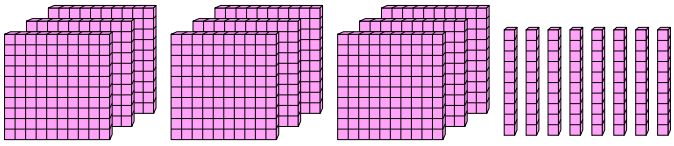

Risposte

1. **1,04**
2. **0,031**
3. **0,102**
4. **0,703**
5. **0,066**
6. **1,75**
7. **1,402**
8. **6,4**
9. **5,58**
10. **0,98**

1-10	90	80	70	60	50	40	30	20	10	0

Determinazione del valore decimale con i blocchi Nome:

Usa il blocco a sinistra per trovare il valore dell'insieme di blocchi a destra.

1) 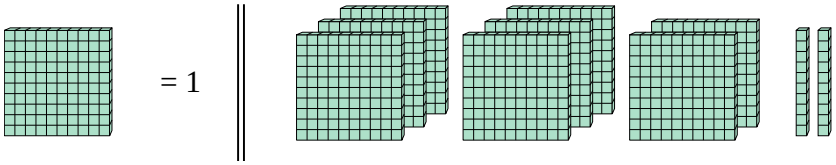

2) 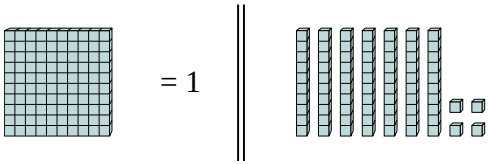

3) 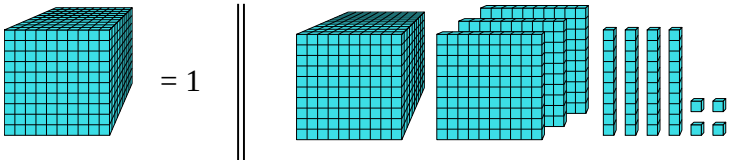

4) 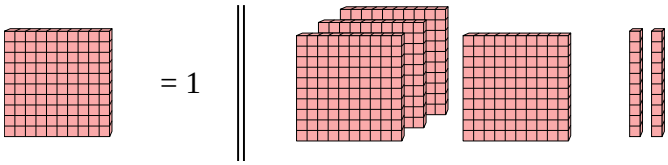

5) 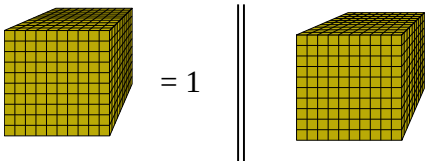

6) 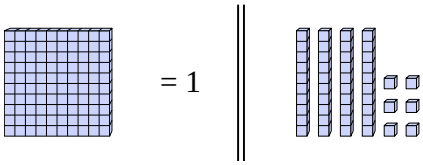

7) 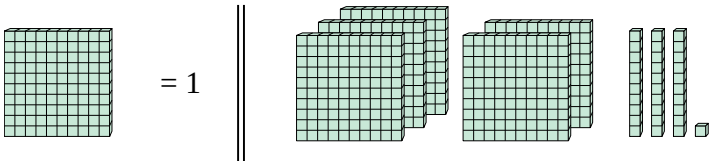

8) 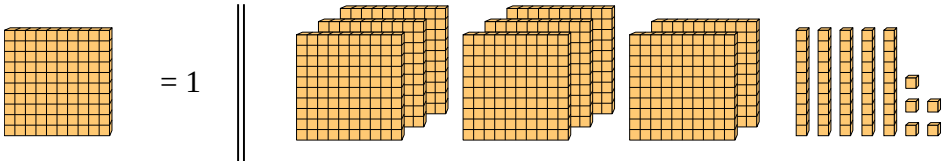

9) 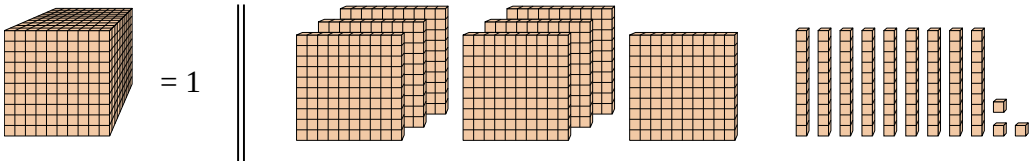

10) 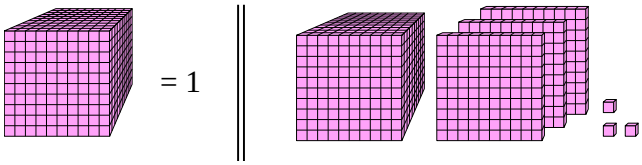

Risposte

1. _____
2. _____
3. _____
4. _____
5. _____
6. _____
7. _____
8. _____
9. _____
10. _____

1-10	90	80	70	60	50	40	30	20	10	0

Determinazione del valore decimale con i blocchi Nome: **Soluzioni**

Usa il blocco a sinistra per trovare il valore dell'insieme di blocchi a destra.

1) 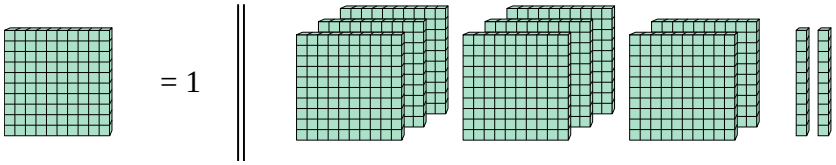

2) 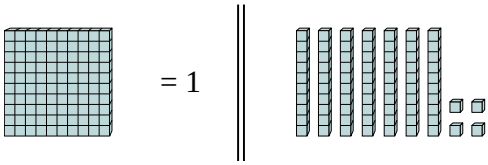

3) 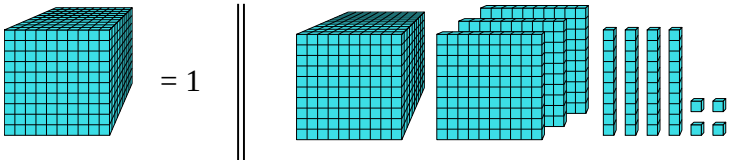

4) 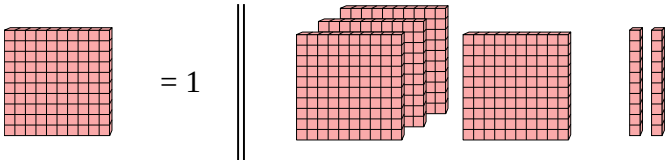

5) 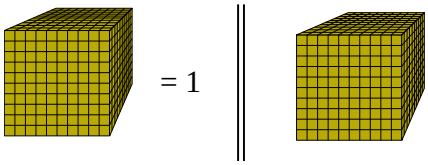

6) 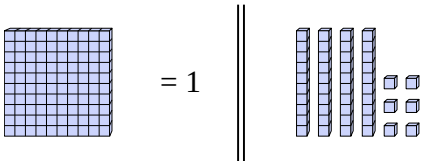

7) 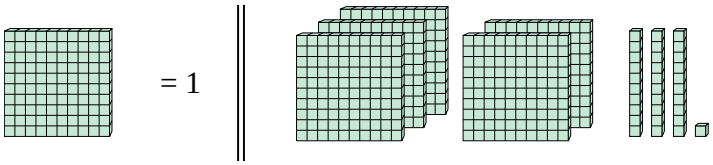

8) 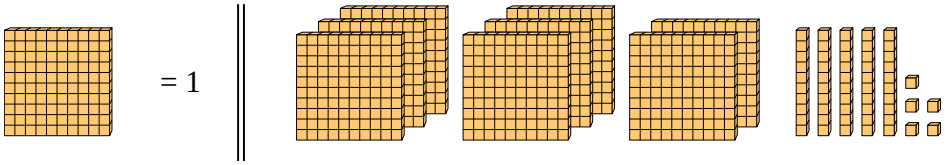

9) 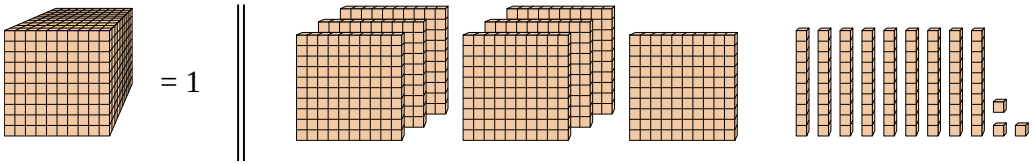

10) 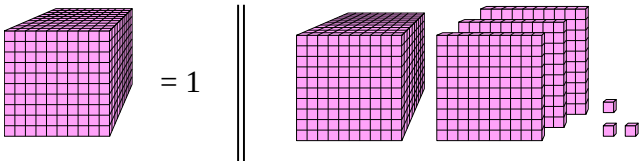

Risposte

1. **8,2**
2. **0,74**
3. **1,344**
4. **4,2**
5. **1**
6. **0,46**
7. **5,31**
8. **8,55**
9. **0,793**
10. **1,303**

1-10	90	80	70	60	50	40	30	20	10	0

Determinazione del valore decimale con i blocchi Nome:

Usa il blocco a sinistra per trovare il valore dell'insieme di blocchi a destra.

1) 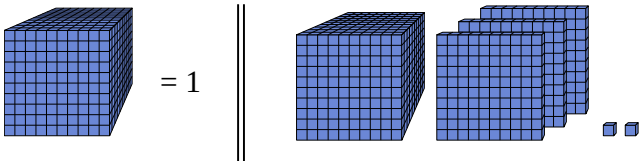

2) 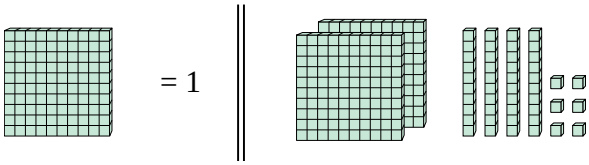

3) 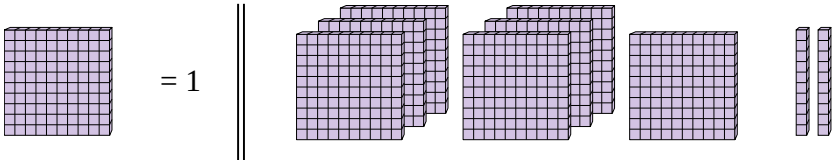

4) 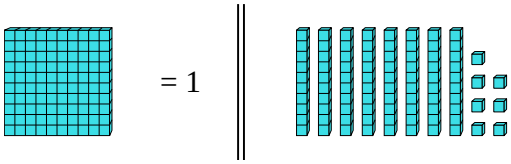

5) 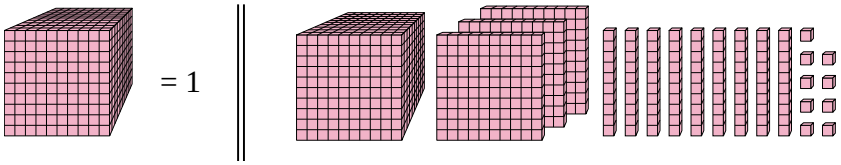

6) 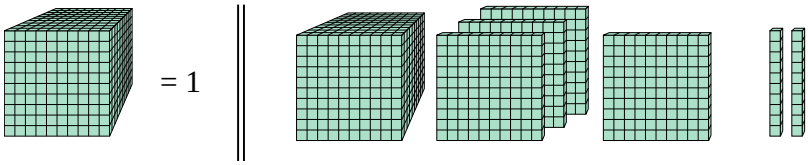

7) 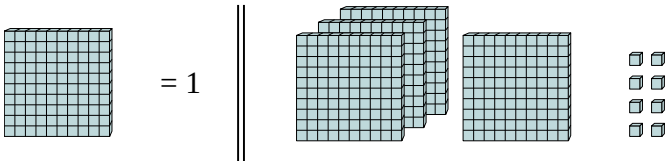

8) 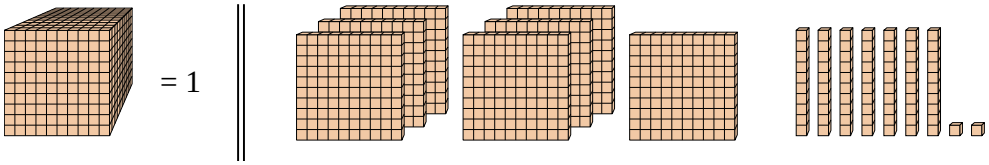

9) 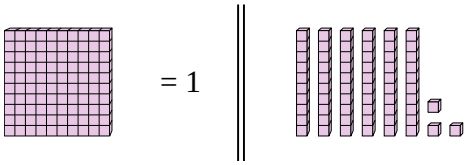

10) 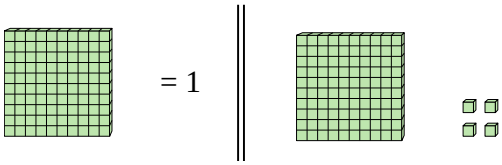

Risposte

1. _____
2. _____
3. _____
4. _____
5. _____
6. _____
7. _____
8. _____
9. _____
10. _____

1-10	90	80	70	60	50	40	30	20	10	0

Determinazione del valore decimale con i blocchi Nome: **Soluzioni**

Usa il blocco a sinistra per trovare il valore dell'insieme di blocchi a destra.

1) 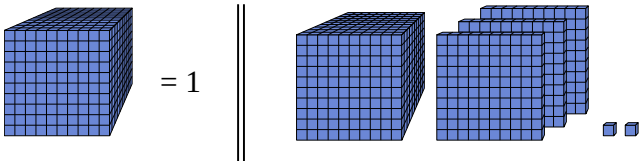

2) 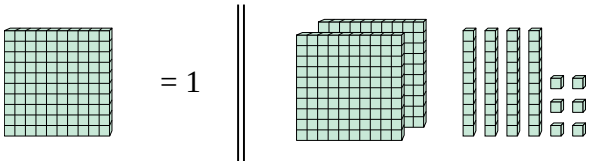

3) 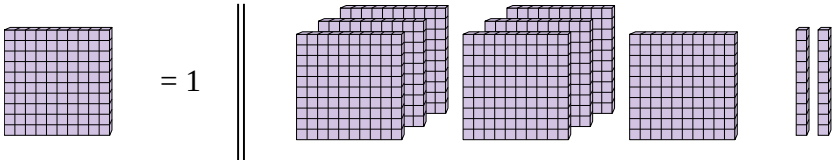

4) 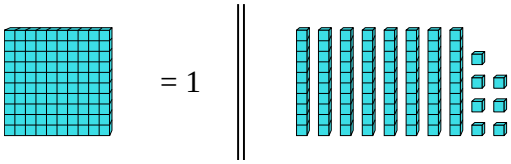

5) 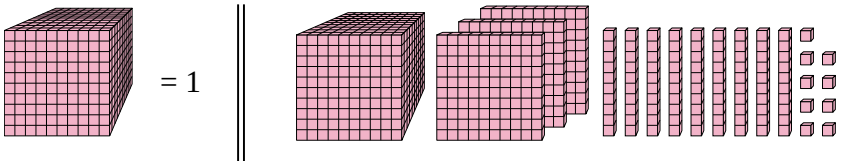

6) 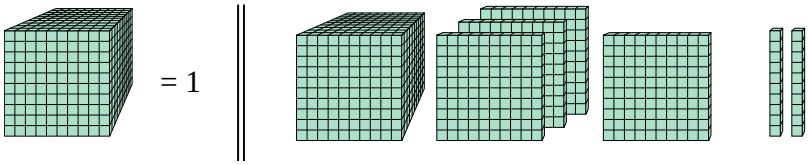

7) 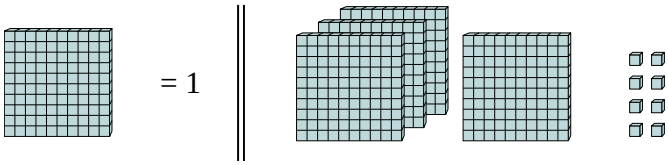

8) 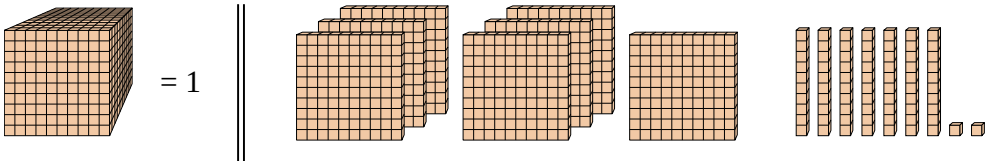

9) 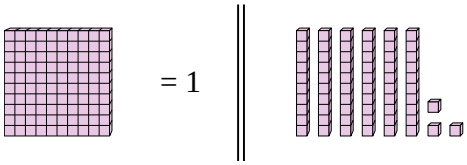

10) 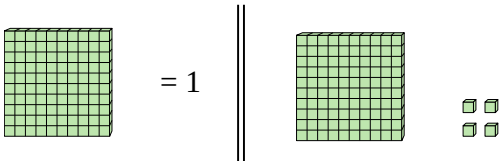

Risposte

1. **1,302**
2. **2,46**
3. **7,2**
4. **0,87**
5. **1,399**
6. **1,42**
7. **4,08**
8. **0,772**
9. **0,63**
10. **1,04**

1-10	90	80	70	60	50	40	30	20	10	0

Determinazione del valore decimale con i blocchi

Nome:

Usa il blocco a sinistra per trovare il valore dell'insieme di blocchi a destra.

1) 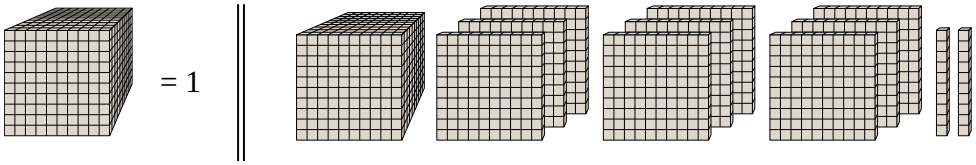

2) 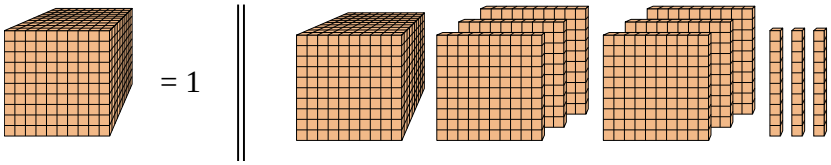

3) 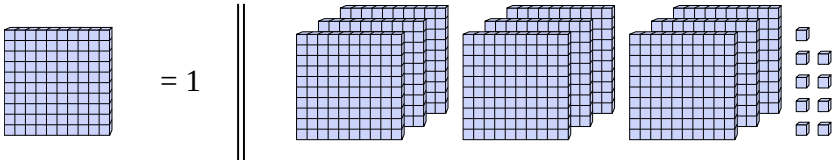

4) 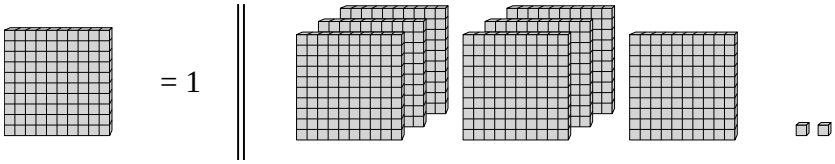

5) 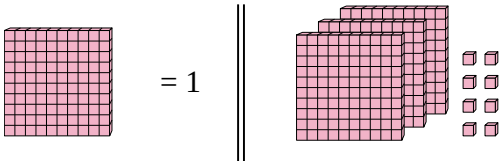

6) 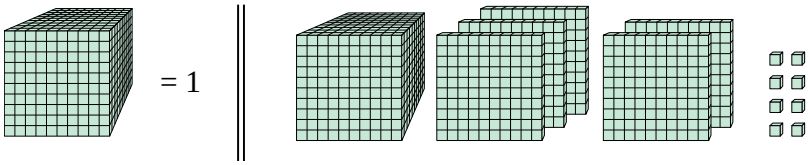

7) 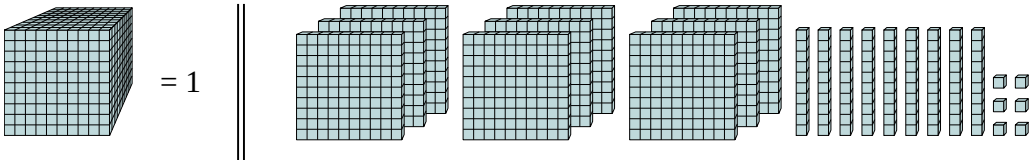

8) 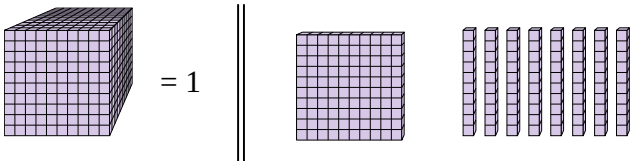

9) 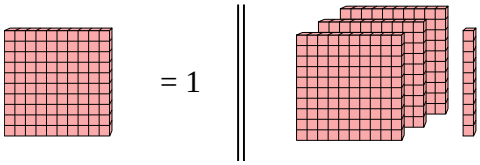

10) 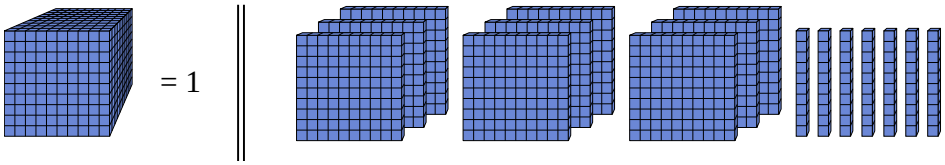

Risposte

1. _____
2. _____
3. _____
4. _____
5. _____
6. _____
7. _____
8. _____
9. _____
10. _____

1-10	90	80	70	60	50	40	30	20	10	0

Determinazione del valore decimale con i blocchi Nome: **Soluzioni**

Usa il blocco a sinistra per trovare il valore dell'insieme di blocchi a destra.

1) 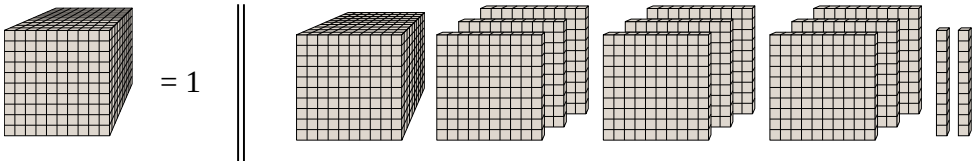

2) 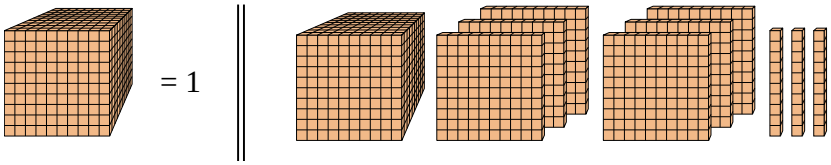

3) 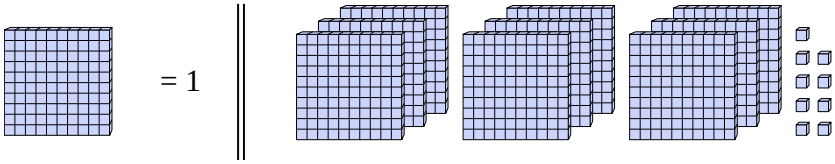

4) 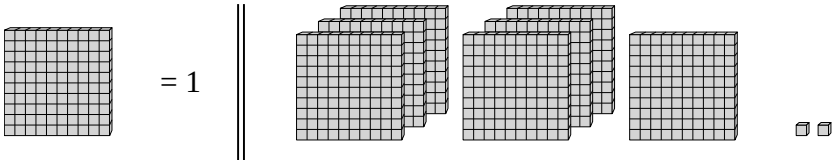

5) 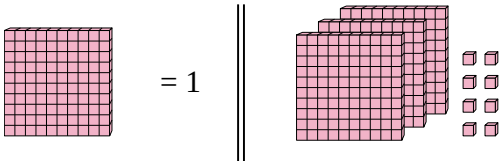

6) 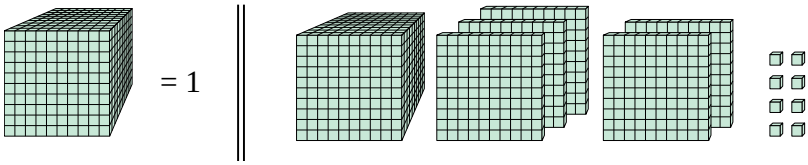

7) 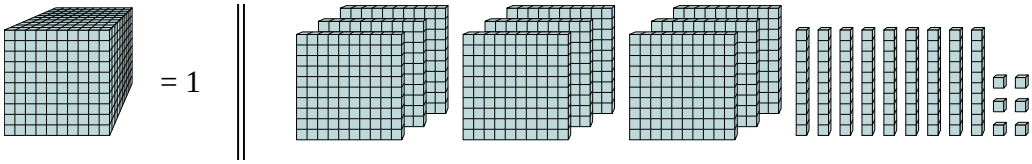

8) 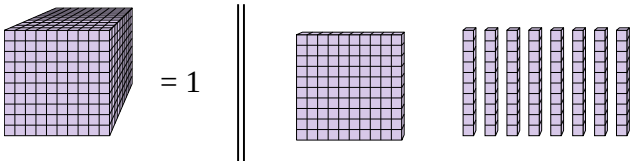

9) 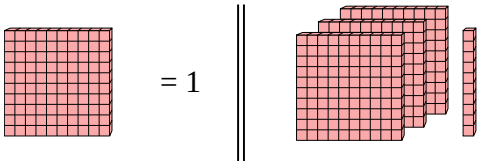

10) 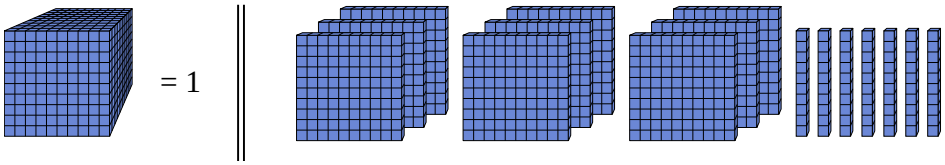

Risposte

1. **1,92**
2. **1,63**
3. **9,09**
4. **7,02**
5. **3,08**
6. **1,508**
7. **0,996**
8. **0,18**
9. **3,1**
10. **0,97**

1-10	90	80	70	60	50	40	30	20	10	0

Determinazione del valore decimale con i blocchi Nome:

Usa il blocco a sinistra per trovare il valore dell'insieme di blocchi a destra.

1) 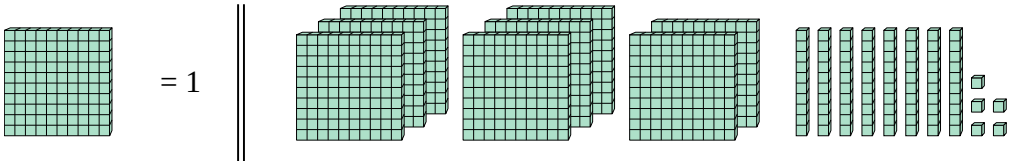

2) 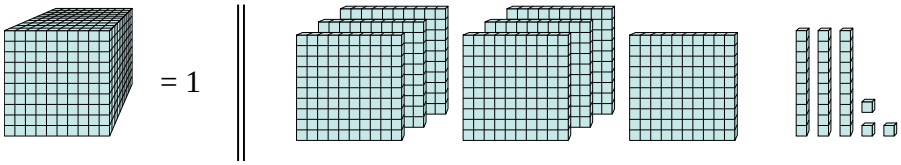

3) 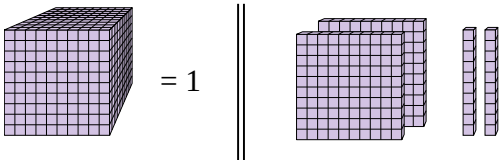

4) 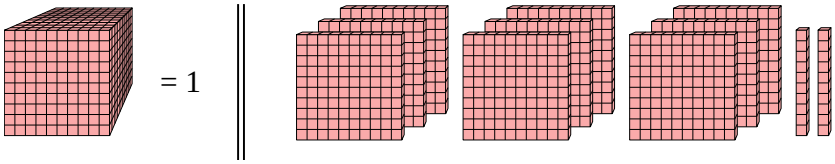

5) 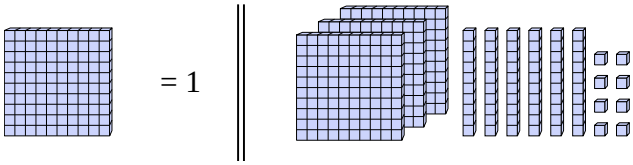

6) 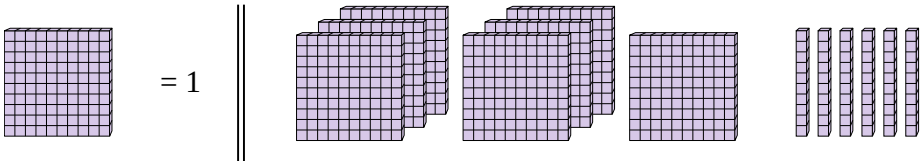

7) 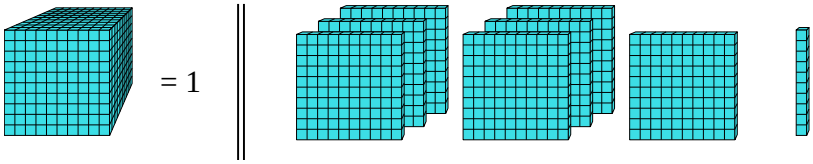

8) 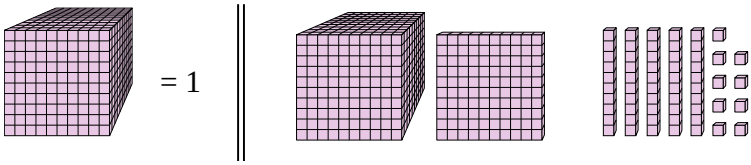

9) 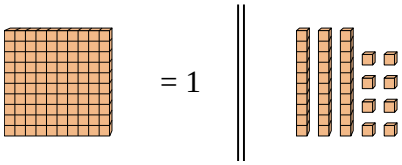

10) 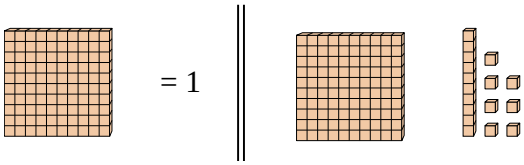

Risposte

1. _____
2. _____
3. _____
4. _____
5. _____
6. _____
7. _____
8. _____
9. _____
10. _____

1-10	90	80	70	60	50	40	30	20	10	0

Determinazione del valore decimale con i blocchi Nome: **Soluzioni**

Usa il blocco a sinistra per trovare il valore dell'insieme di blocchi a destra.

1) 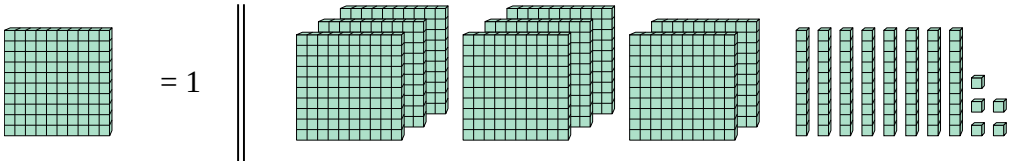

2) 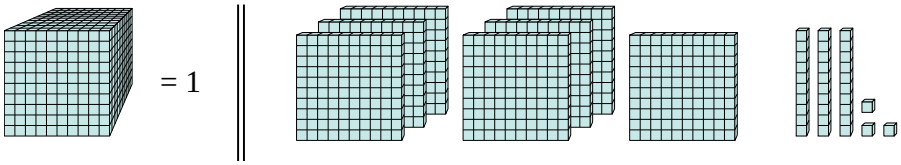

3) 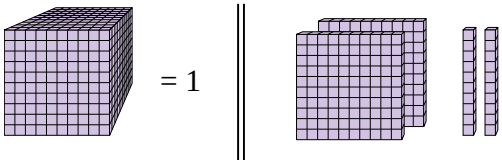

4) 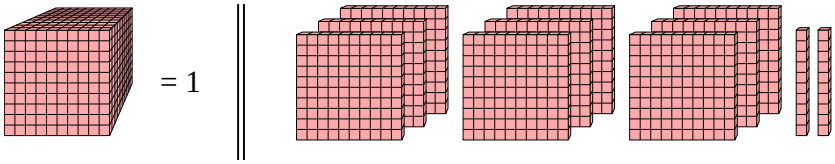

5) 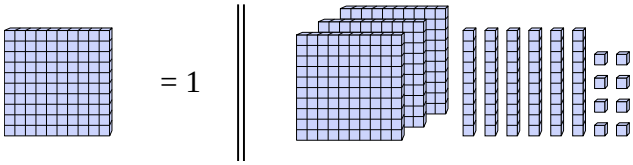

6) 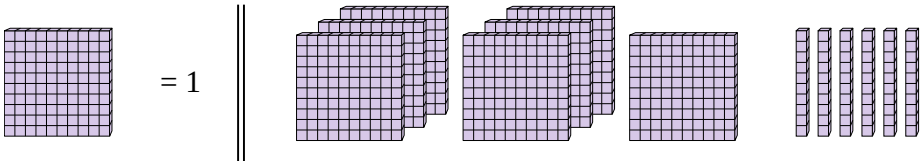

7) 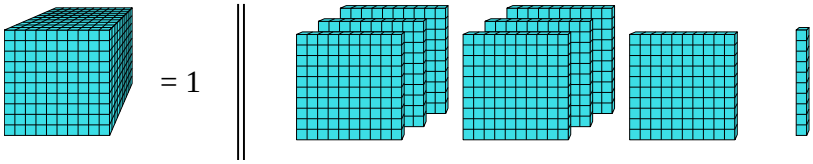

8) 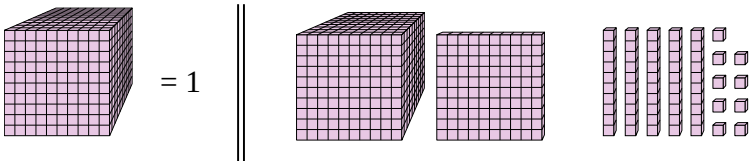

9) 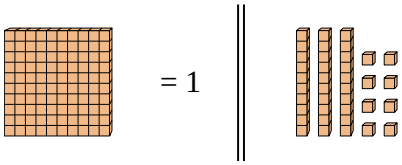

10) 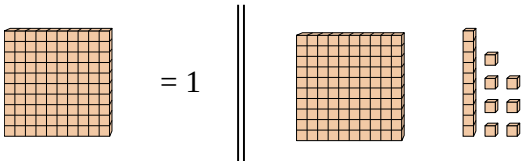

Risposte

1. **8,85**
2. **0,733**
3. **0,22**
4. **0,92**
5. **3,68**
6. **7,6**
7. **0,71**
8. **1,159**
9. **0,38**
10. **1,17**

1-10	90	80	70	60	50	40	30	20	10	0

Determinazione del valore decimale con i blocchi Nome:

Usa il blocco a sinistra per trovare il valore dell'insieme di blocchi a destra.

1) 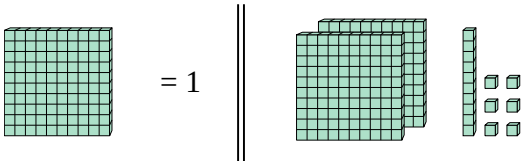 = 1

2) 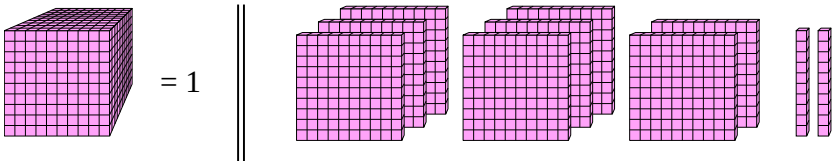 = 1

3) 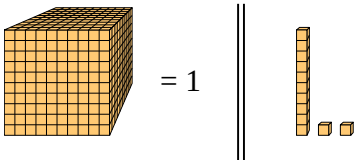 = 1

4) 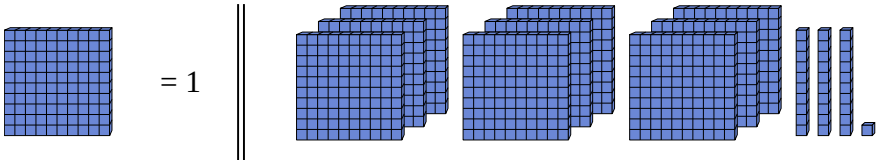 = 1

5) 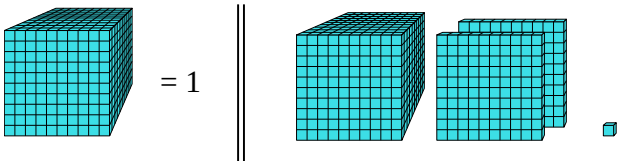 = 1

6) 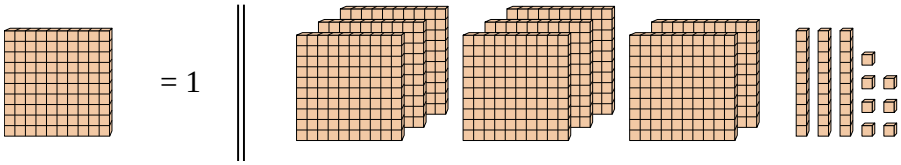 = 1

7) 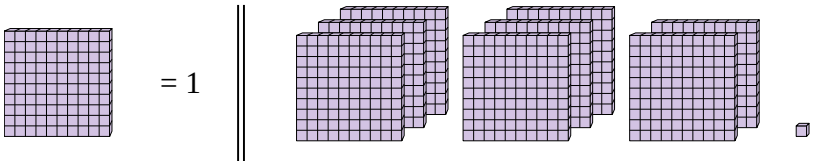 = 1

8) 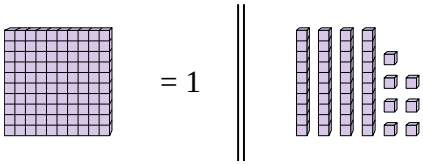 = 1

9) 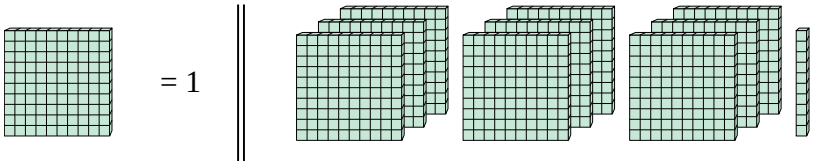 = 1

10) 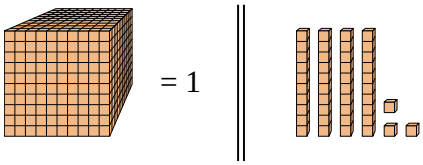 = 1

Risposte

1. _____
2. _____
3. _____
4. _____
5. _____
6. _____
7. _____
8. _____
9. _____
10. _____

1-10	90	80	70	60	50	40	30	20	10	0

Determinazione del valore decimale con i blocchi Nome: **Soluzioni**

Usa il blocco a sinistra per trovare il valore dell'insieme di blocchi a destra.

1) 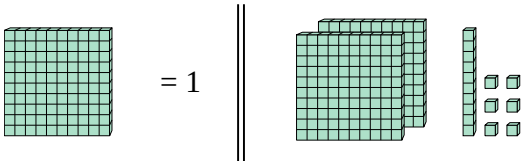

2) 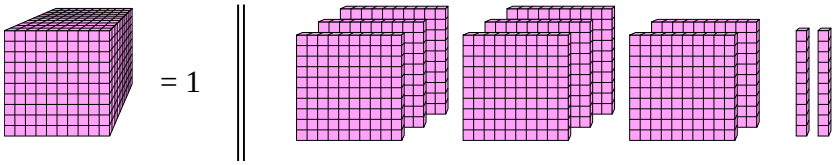

3) 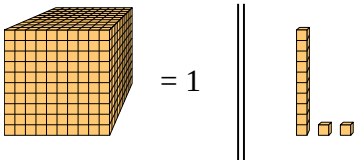

4) 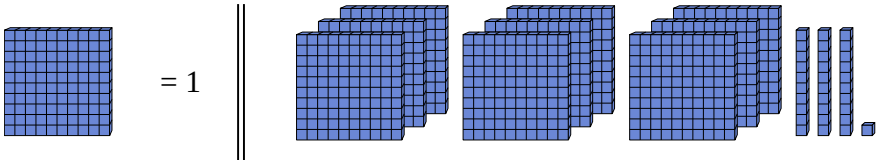

5) 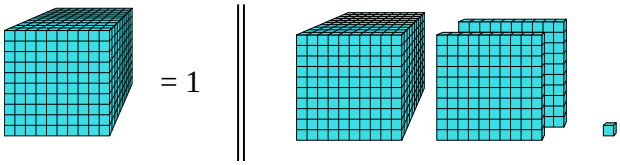

6) 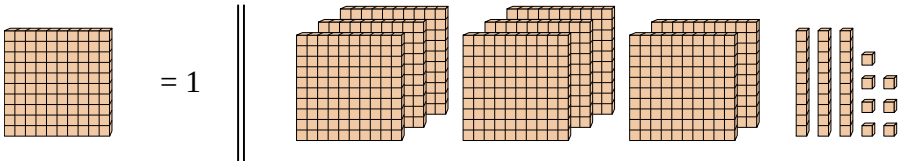

7) 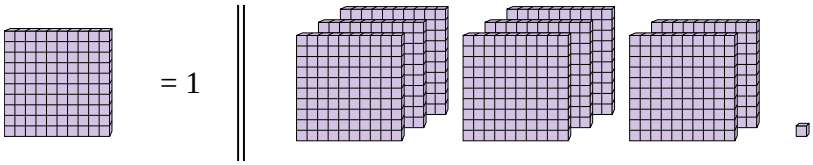

8) 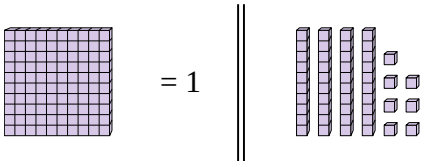

9) 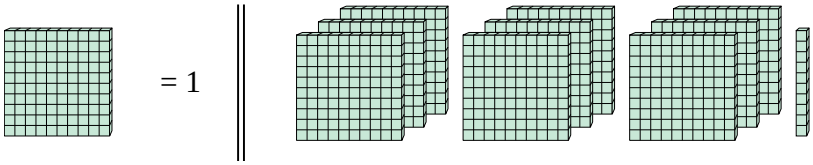

10) 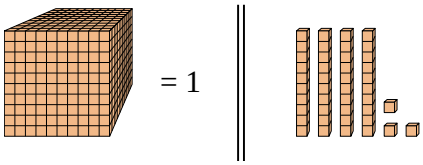

Risposte

1. **2,16**
2. **0,82**
3. **0,012**
4. **9,31**
5. **1,201**
6. **8,37**
7. **8,01**
8. **0,47**
9. **9,1**
10. **0,043**

1-10	90	80	70	60	50	40	30	20	10	0

Determinazione del valore decimale con i blocchi

Nome:

Usa il blocco a sinistra per trovare il valore dell'insieme di blocchi a destra.

1) 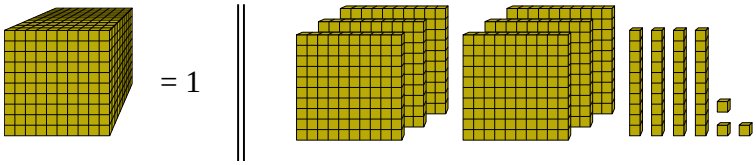

2) 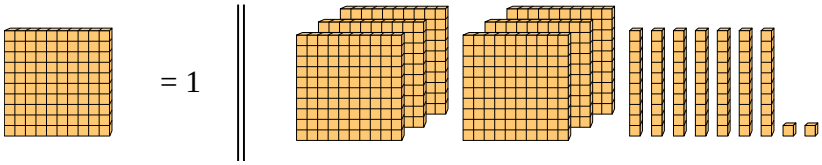

3) 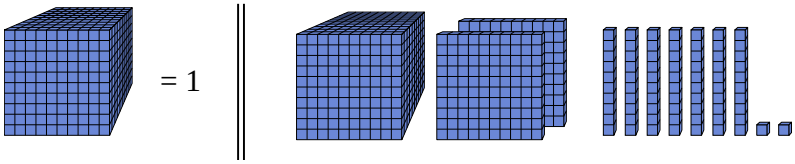

4) 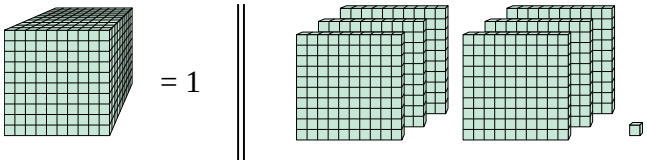

5) 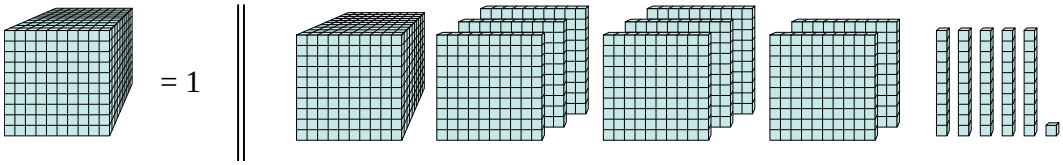

6) 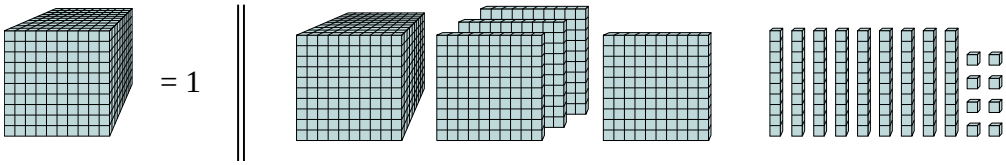

7) 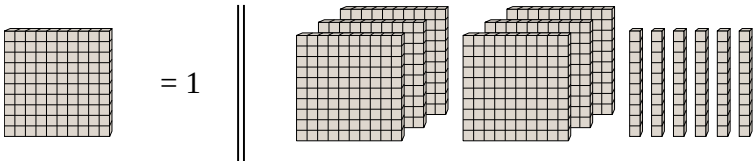

8) 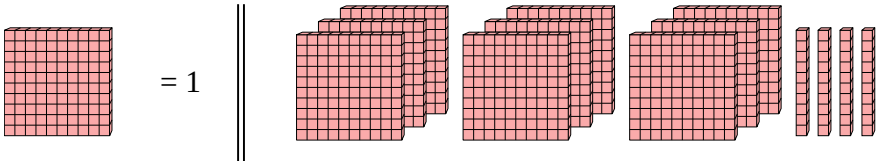

9) 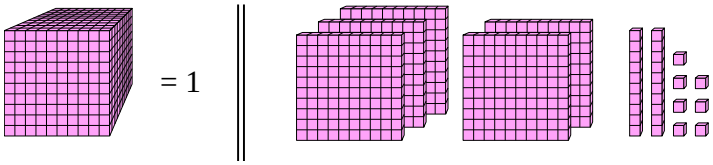

10) 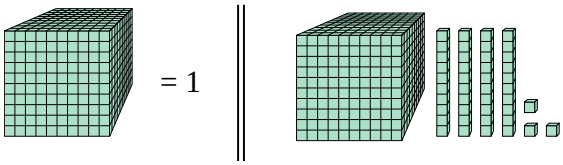

Risposte

1. _____
2. _____
3. _____
4. _____
5. _____
6. _____
7. _____
8. _____
9. _____
10. _____

1-10	90	80	70	60	50	40	30	20	10	0

Determinazione del valore decimale con i blocchi Nome: **Soluzioni**

Usa il blocco a sinistra per trovare il valore dell'insieme di blocchi a destra.

1) 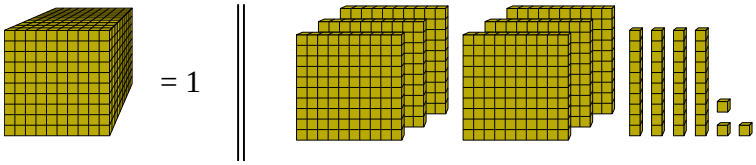

2) 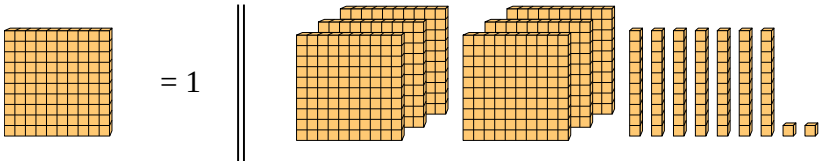

3) 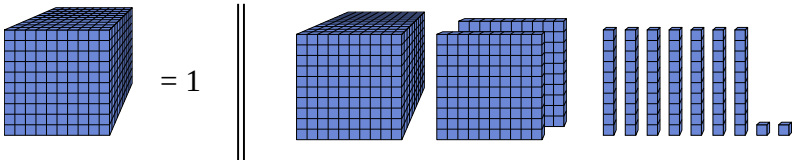

4) 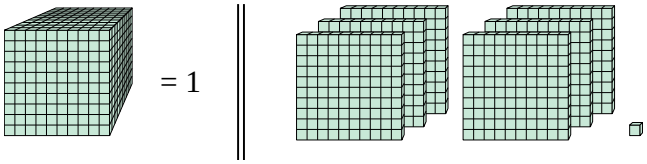

5) 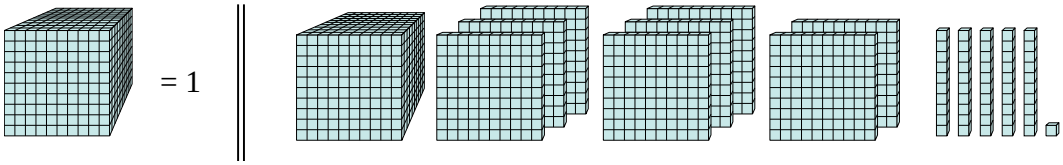

6) 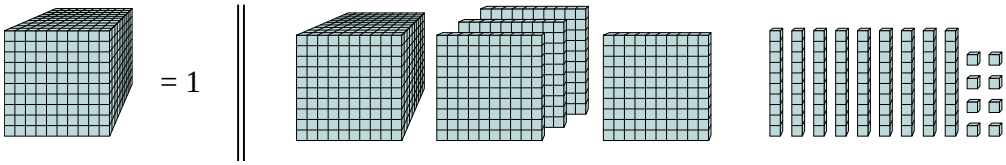

7) 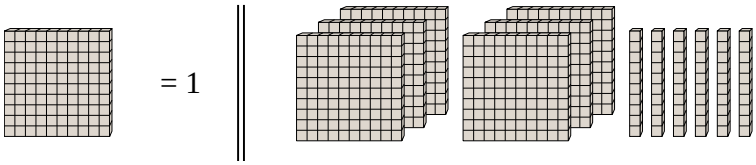

8) 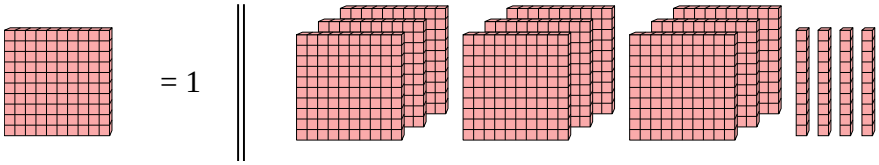

9) 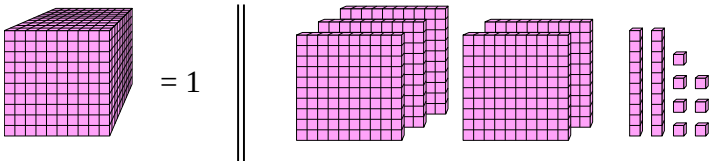

10) 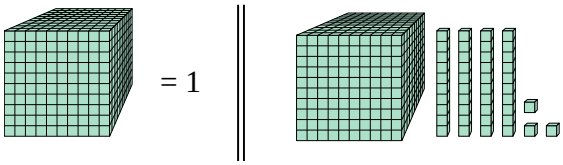

Risposte

1. **0,643**
2. **6,72**
3. **1,272**
4. **0,601**
5. **1,851**
6. **1,498**
7. **6,6**
8. **9,4**
9. **0,527**
10. **1,043**

1-10	90	80	70	60	50	40	30	20	10	0