Determinazione del valore decimale con i blocchi Nome:

Usa il blocco a sinistra per trovare il valore dell'insieme di blocchi a destra.

1) 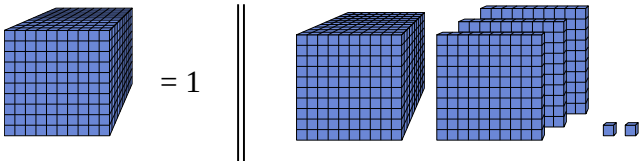

2) 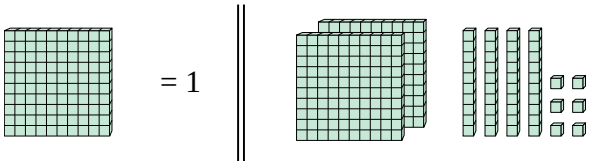

3) 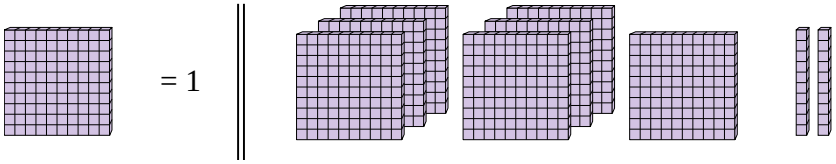

4) 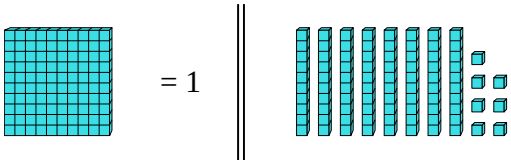

5) 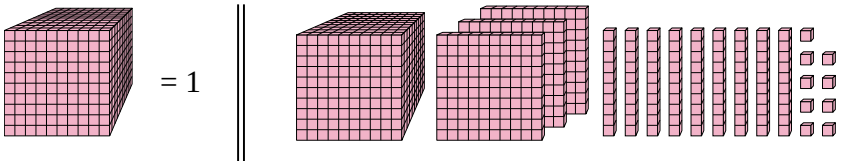

6) 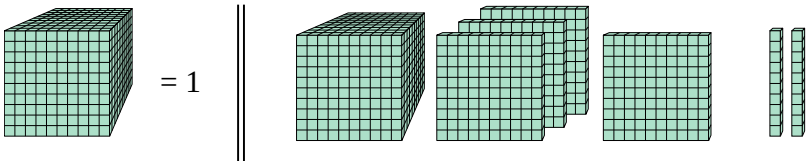

7) 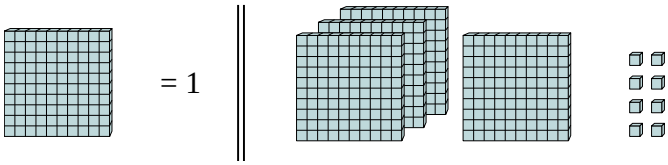

8) 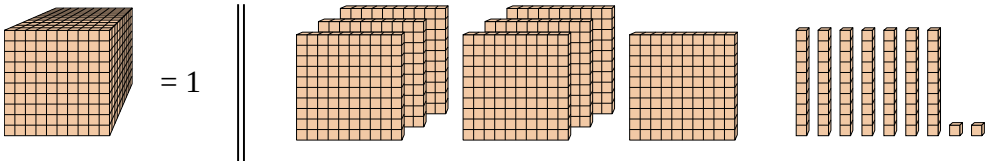

9) 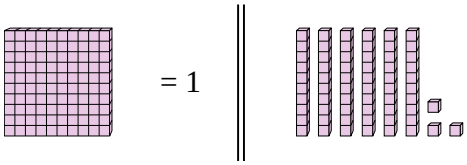

10) 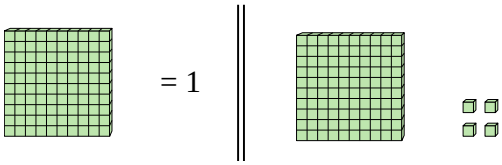

Risposte

1. _____
2. _____
3. _____
4. _____
5. _____
6. _____
7. _____
8. _____
9. _____
10. _____

1-10	90	80	70	60	50	40	30	20	10	0

Determinazione del valore decimale con i blocchi Nome: **Soluzioni**

Usa il blocco a sinistra per trovare il valore dell'insieme di blocchi a destra.

1) 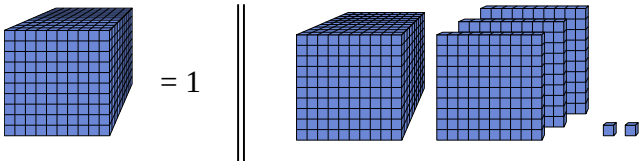

2) 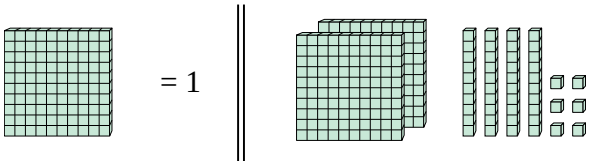

3) 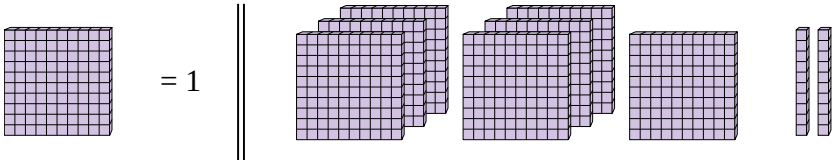

4) 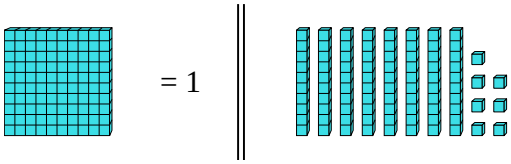

5) 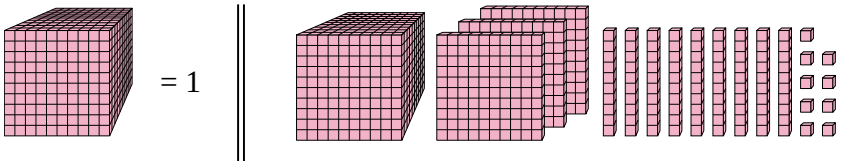

6) 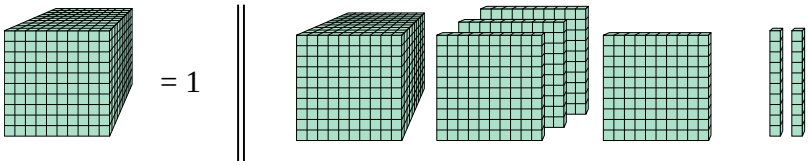

7) 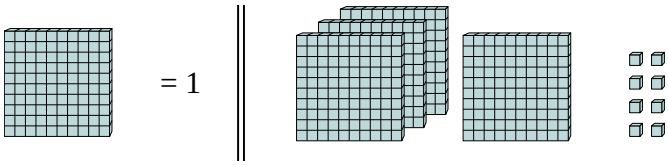

8) 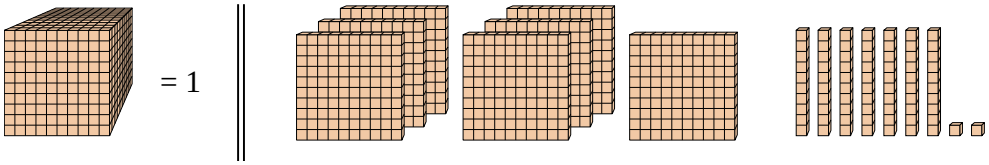

9) 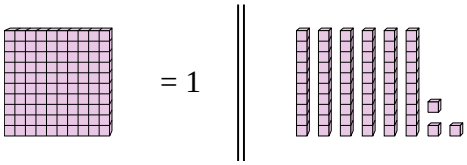

10) 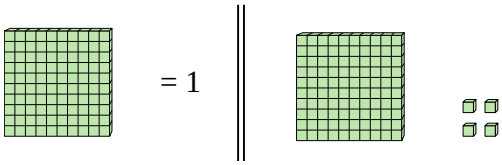

Risposte

1. **1,302**
2. **2,46**
3. **7,2**
4. **0,87**
5. **1,399**
6. **1,42**
7. **4,08**
8. **0,772**
9. **0,63**
10. **1,04**

1-10	90	80	70	60	50	40	30	20	10	0