Determina quale lettera risponde correttamente alla domanda.

1) Quale griglia 10 × 10 è colorata in modo da rappresentare un numero decimale, che sommato a 0,48 fa 1,00?

A 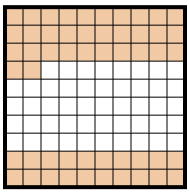 B 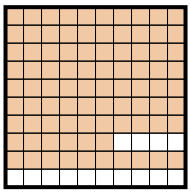 C 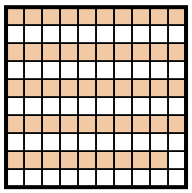 D 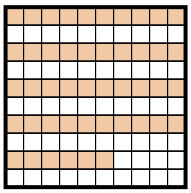

2) Quale griglia 10 × 1 è colorata in modo da rappresentare un numero decimale, che sommato a 0,5 fa 1,00?

A 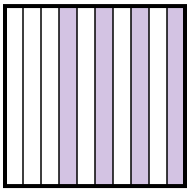 B 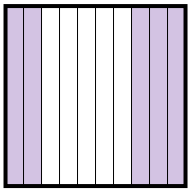 C 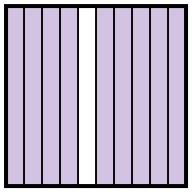 D 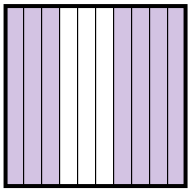

3) Quale griglia 10 × 10 è colorata in modo da rappresentare un numero decimale, che sommato a 0,5 fa 1,00?

A 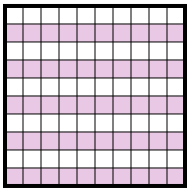 B 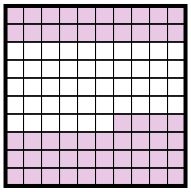 C  D 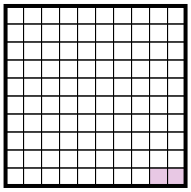

4) Quale griglia 10 × 1 è colorata in modo da rappresentare un numero decimale, che sommato a 0,8 fa 1,00?

A 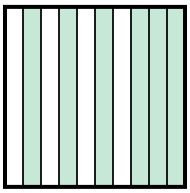 B 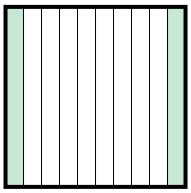 C 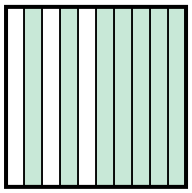 D 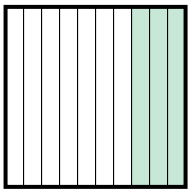

5) Quale griglia 10 × 1 è colorata in modo da rappresentare un numero decimale, che sommato a 0,6 fa 1,00?

A  B 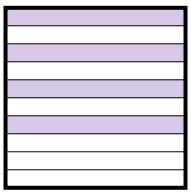 C 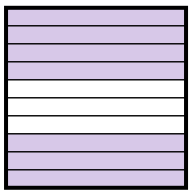 D 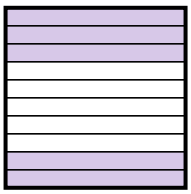

6) Quale griglia 10 × 10 è colorata in modo da rappresentare un numero decimale, che sommato a 0,1 fa 1,00?

A  B  C  D 

Risposte

1. _____
2. _____
3. _____
4. _____
5. _____
6. _____

1-6	83	67	50	33	17	0

Determina quale lettera risponde correttamente alla domanda.

1) Quale griglia 10 × 10 è colorata in modo da rappresentare un numero decimale, che sommato a 0,48 fa 1,00?

A 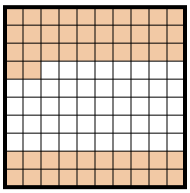
B 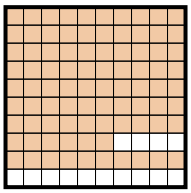
C 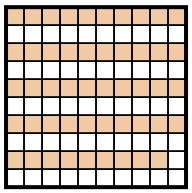
D 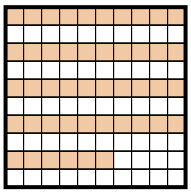

2) Quale griglia 10 × 1 è colorata in modo da rappresentare un numero decimale, che sommato a 0,5 fa 1,00?

A 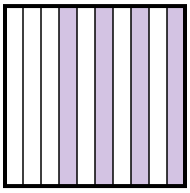
B 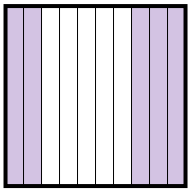
C 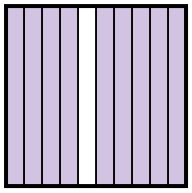
D 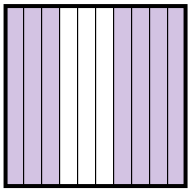

3) Quale griglia 10 × 10 è colorata in modo da rappresentare un numero decimale, che sommato a 0,5 fa 1,00?

A 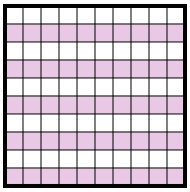
B 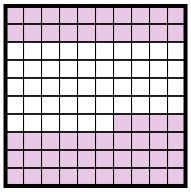
C 
D 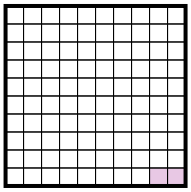

4) Quale griglia 10 × 1 è colorata in modo da rappresentare un numero decimale, che sommato a 0,8 fa 1,00?

A 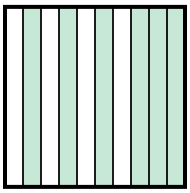
B 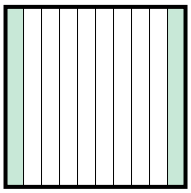
C 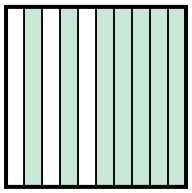
D 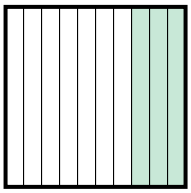

5) Quale griglia 10 × 1 è colorata in modo da rappresentare un numero decimale, che sommato a 0,6 fa 1,00?

A 
B 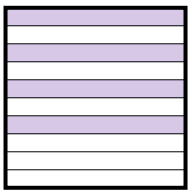
C 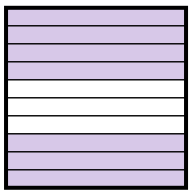
D 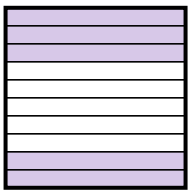

6) Quale griglia 10 × 10 è colorata in modo da rappresentare un numero decimale, che sommato a 0,1 fa 1,00?

A 
B 
C 
D 

Risposte

1. A
2. B
3. A
4. B
5. B
6. A

1-6	83	67	50	33	17	0