Determinare il perimetro

Nome:

Calcola il perimetro di ogni sezione colorata. Ogni quadratino è 1 unità quadrata (u).

1)

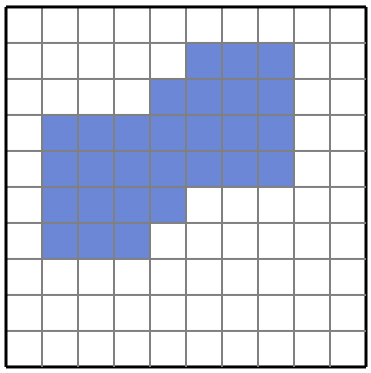

2)

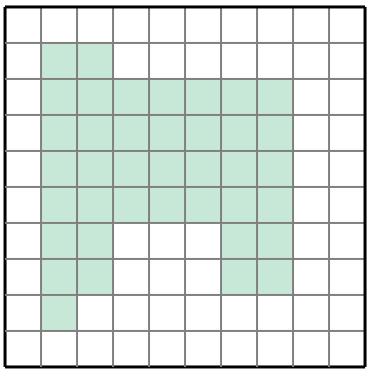

3)

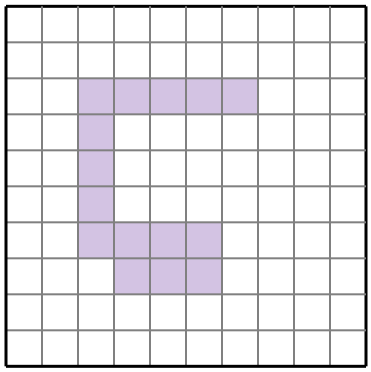

4)

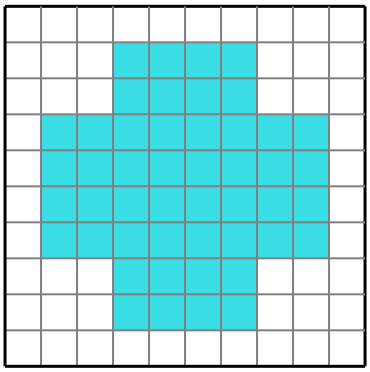

5)

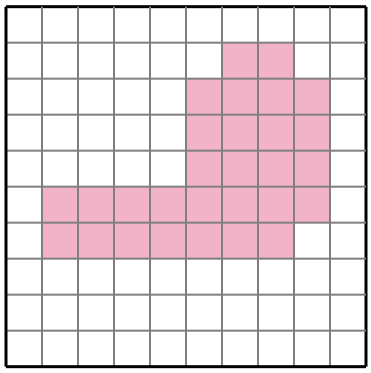

6)

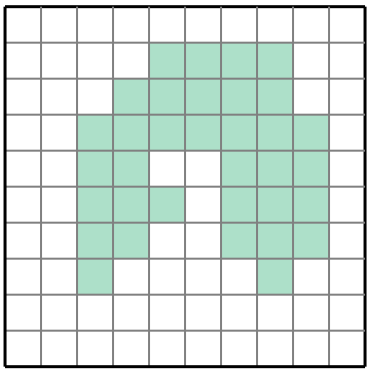

7)

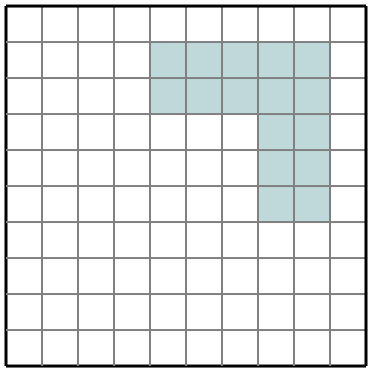

8)

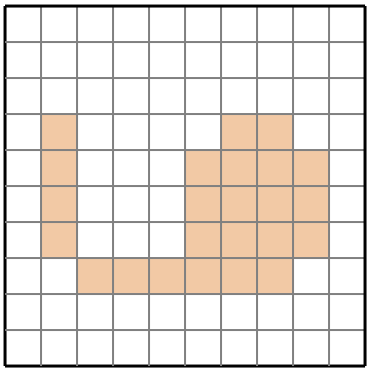

Risposte

1. _____
2. _____
3. _____
4. _____
5. _____
6. _____
7. _____
8. _____

1-8	88	75	63	50	38	25	13	0

Determinare il perimetro

Nome: **Soluzioni**

Calcola il perimetro di ogni sezione colorata. Ogni quadratino è 1 unità quadrata (u).

1)

					2	1	2		
				2			1		
	2	1	1				1		
	1				1	1	2		
	1			2					
	2	1	2						

2)

	2	2							
	1		1	1	1	1	2		
	1						1		
	1						1		
	1		1	1	1		1		
	1	1				1	1		
	1	2				2	2		
	3								

3)

		2	2	2	2	3			
		2							
		2							
		2							
		2	1	1	2				
			2	1	2				

4)

			2	1	1	2			
			1			1			
	2	1					1	2	
	1							1	
	1							1	
	2	1					1	2	
			1			1			
			2	1	1	2			

5)

						2	2		
					2			2	
					1			1	
					1			1	
	2	1	1	1				2	
	2	1	1	1	1	1	2		

6)

				2	1	1	2		
			2				1		
		2		1	1			2	
		1	1			1		1	
		1		3		1		1	
		1	2			2		2	
		3					3		

7)

				2	1	1	1	2	
				2	1	1		1	
							1	1	
							1	1	
							2	2	

8)

	3					2	2		
	2				2			2	
	2				1			1	
	3				1			2	
		3	2	2	1	1	2		

Risposte

1. 26
2. 34
3. 28
4. 32
5. 28
6. 38
7. 20
8. 34

1-8	88	75	63	50	38	25	13	0