Creazione di rettangoli di area e perimetro Nome:

Utilizzare i diagrammi seguenti per creare un rettangolo con l'area/perimetro mostrato. Ogni SVGREPLACE = 1 unità(u). Rispondi con la lunghezza e l'altezza. Le risposte varieranno.

1) Perimetro di 40 unità.



2) Perimetro di 12 unità.



3) Area di 21 unità quadrate.



4) Perimetro di 36 unità.



5) Perimetro di 32 unità.



6) Perimetro di 8 unità.



7) Area di 72 unità quadrate.



8) Area di 9 unità quadrate.



9) Area di 3 unità quadrate.



10) Area di 10 unità quadrate.



11) Perimetro di 4 unità.



12) Area di 56 unità quadrate.



Risposte

1. ___ ___ =40u
2. ___ ___ =12u
3. ___ ___ $=21u^2$
4. ___ ___ =36u
5. ___ ___ =32u
6. ___ ___ =8u
7. ___ ___ $=72u^2$
8. ___ ___ $=9u^2$
9. ___ ___ $=3u^2$
10. ___ ___ $=10u^2$
11. ___ ___ =4u
12. ___ ___ $=56u^2$

1-10	92	83	75	67	58	50	42	33	25	17
11-12	8	0								

Creazione di rettangoli di area e perimetro Nome: **Soluzioni**

Utilizzare i diagrammi seguenti per creare un rettangolo con l'area/perimetro mostrato. Ogni SVGREPLACE = 1 unità(u). Rispondi con la lunghezza e l'altezza. Le risposte varieranno.

1) Perimetro di 40 unità.



2) Perimetro di 12 unità.



3) Area di 21 unità quadrate.



4) Perimetro di 36 unità.



5) Perimetro di 32 unità.



6) Perimetro di 8 unità.



7) Area di 72 unità quadrate.



8) Area di 9 unità quadrate.



9) Area di 3 unità quadrate.



10) Area di 10 unità quadrate.



11) Perimetro di 4 unità.



12) Area di 56 unità quadrate.



Risposte

1. ___ ___ =40u
2. ___ ___ =12u
3. ___ ___ =21u^2
4. ___ ___ =36u
5. ___ ___ =32u
6. ___ ___ =8u
7. ___ ___ =72u^2
8. ___ ___ =9u^2
9. ___ ___ =3u^2
10. ___ ___ =10u^2
11. ___ ___ =4u
12. ___ ___ =56u^2

1-10	92	83	75	67	58	50	42	33	25	17
11-12	8	0								