Completamento e corrispondenza delle equazioni di volume Nome:

Collega ogni problema con l'equazione che potrebbe rappresentarlo. Rispondi con il termine e la lettera mancanti.

Es) 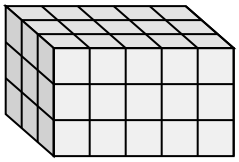

1) 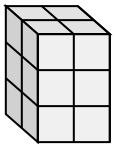

2) 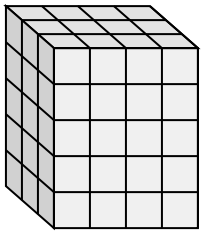

3) 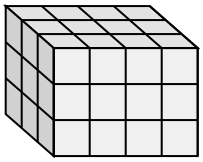

4) 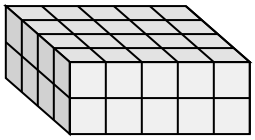

5) 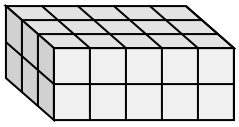

6) 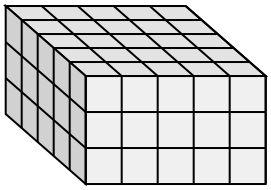

7) 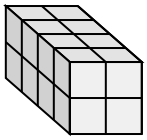

8) 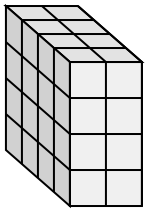

9) 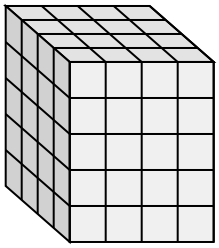

10) 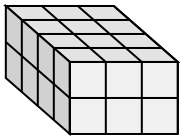

11) 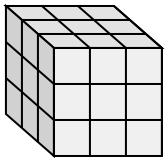

A. 4 × ___ × 4 = 32

B. 4 × 3 × 2 = ___

C. 3 × 4 × 3 = ___

D. ___ × 5 × 2 = 40

E. ___ × 5 × 3 = 45

F. 2 × 2 × ___ = 12

G. 4 × ___ × 5 = 80

H. 3 × ___ × 3 = 27

I. 4 × 2 × ___ = 16

J. 5 × 5 × ___ = 75

K. 3 × 5 × 2 = ___

L. 3 × ___ × 5 = 60

Risposte

Es. E

1. _____
2. _____
3. _____
4. _____
5. _____
6. _____
7. _____
8. _____
9. _____
10. _____
11. _____

1-10	91	82	73	64	55	45	36	27	18	9
11	0									

Completamento e corrispondenza delle equazioni di volume Nome: **Soluzioni**

Collega ogni problema con l'equazione che potrebbe rappresentarlo. Rispondi con il termine e la lettera mancanti.

Es) 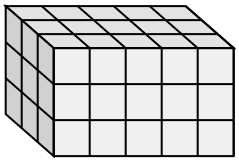

1) 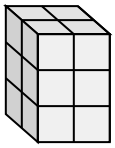

2) 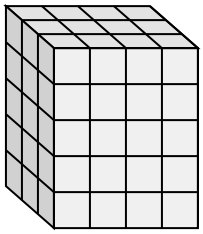

3) 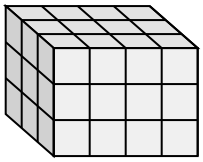

4) 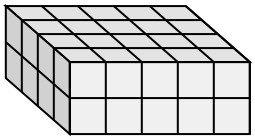

5) 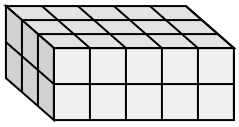

6) 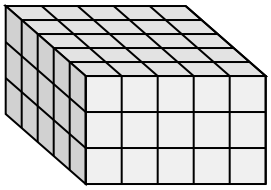

7) 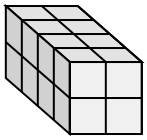

8) 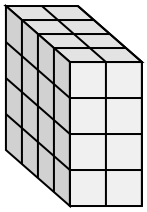

9) 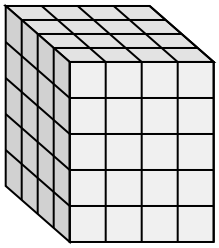

10) 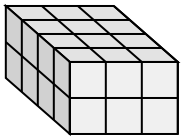

11) 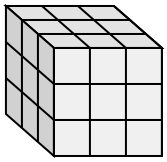

A. 4 × ___ × 4 = 32

B. 4 × 3 × 2 = ___

C. 3 × 4 × 3 = ___

D. ___ × 5 × 2 = 40

E. ___ × 5 × 3 = 45

F. 2 × 2 × ___ = 12

G. 4 × ___ × 5 = 80

H. 3 × ___ × 3 = 27

I. 4 × 2 × ___ = 16

J. 5 × 5 × ___ = 75

K. 3 × 5 × 2 = ___

L. 3 × ___ × 5 = 60

Risposte

Es. E

1. F

2. L

3. C

4. D

5. K

6. J

7. I

8. A

9. G

10. B

11. H

1-10	91	82	73	64	55	45	36	27	18	9
11	0									