Trovare la lunghezza del lato mancante del triangolo rettangolo (area) Nome:

Trova il valore di X.

1) Perimetro = 20,2 u

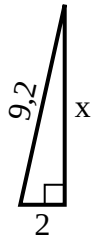

2) Perimetro = 27,4 u

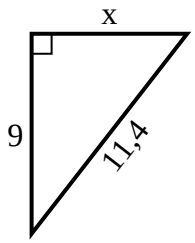

3) Perimetro = 18,8 u

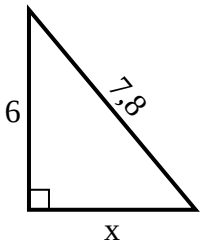

4) Perimetro = 20,6 u

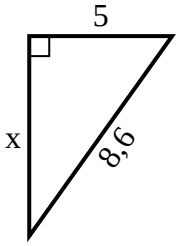

5) Perimetro = 6,8 u

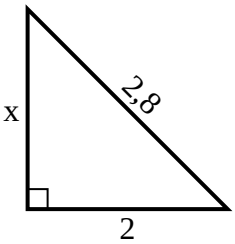

6) Perimetro = 17,6 u

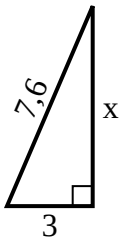

7) Perimetro = 20,6 u

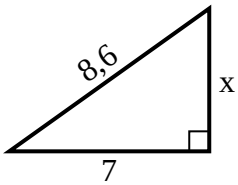

8) Perimetro = 24,3 u

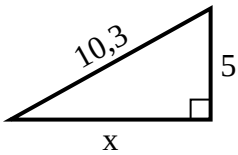

9) Perimetro = 15,4 u

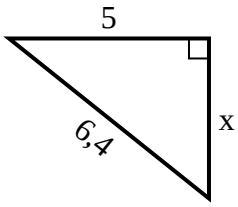

10) Perimetro = 19,5 u

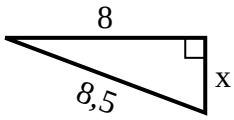

11) Perimetro = 16,3 u

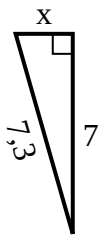

12) Perimetro = 17,6 u

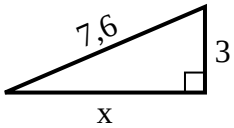

Risposte

1. _____
2. _____
3. _____
4. _____
5. _____
6. _____
7. _____
8. _____
9. _____
10. _____
11. _____
12. _____

1-10	92	83	75	67	58	50	42	33	25	17
11-12	8	0								

Trovare la lunghezza del lato mancante del triangolo rettangolo (area) Nome: **Soluzioni**

Trova il valore di X.

1) Perimetro = 20,2 u

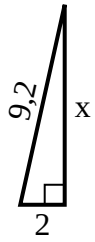

2) Perimetro = 27,4 u

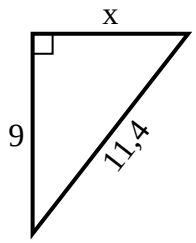

3) Perimetro = 18,8 u

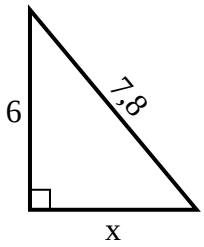

4) Perimetro = 20,6 u

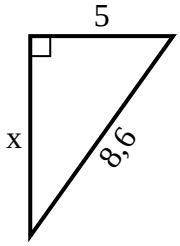

5) Perimetro = 6,8 u

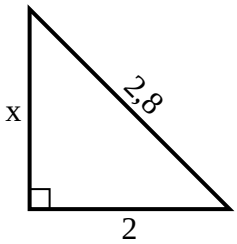

6) Perimetro = 17,6 u

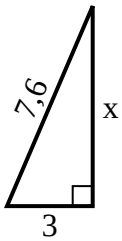

7) Perimetro = 20,6 u

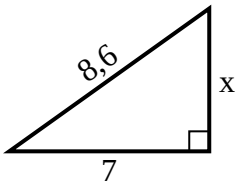

8) Perimetro = 24,3 u

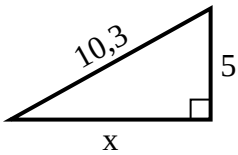

9) Perimetro = 15,4 u

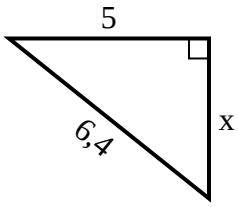

10) Perimetro = 19,5 u

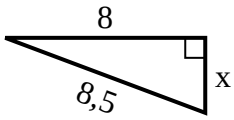

11) Perimetro = 16,3 u

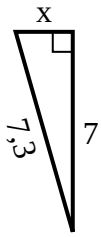

12) Perimetro = 17,6 u

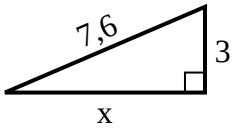

Risposte

1. 9
2. 7
3. 5
4. 7
5. 2
6. 7
7. 5
8. 9
9. 4
10. 3
11. 2
12. 7

1-10	92	83	75	67	58	50	42	33	25	17
11-12	8	0								